Modelar Cuartos (A)

Escriba la fracción correcta para cada modelo.



$\frac{3}{4}$



$\frac{\quad}{4}$



$\frac{\quad}{4}$



$\frac{\quad}{4}$



____



____



____



____

____



____



____

____

____

____

____

____



____



____



____



____



____



____

____



____

____

____

____

____

Modelar Cuartos (A) Respuestas

Escriba la fracción correcta para cada modelo.



$\frac{3}{4}$



$\frac{2}{4}$



$\frac{2}{4}$



$\frac{4}{4}$



$\frac{3}{4}$



$\frac{2}{4}$



$\frac{2}{4}$



$\frac{1}{4}$

$\frac{3}{4}$



$\frac{2}{4}$



$\frac{2}{4}$

$\frac{3}{4}$

$\frac{4}{4}$

$\frac{3}{4}$

$\frac{3}{4}$

$\frac{2}{4}$



$\frac{1}{4}$



$\frac{4}{4}$



$\frac{2}{4}$

$\frac{4}{4}$



$\frac{3}{4}$



$\frac{3}{4}$

$\frac{1}{4}$



$\frac{3}{4}$

$\frac{4}{4}$

$\frac{3}{4}$

$\frac{2}{4}$

$\frac{1}{4}$