Representar Números (J)

¿Qué número se muestra en cada grupo de bloques base diez?

1

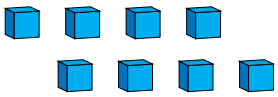

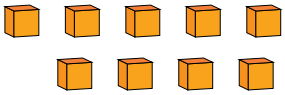

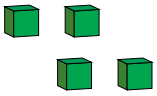

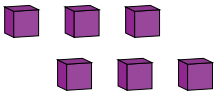

Representar Números (J) Respuestas

¿Qué número se muestra en cada grupo de bloques base diez?

1

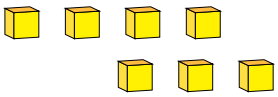

7

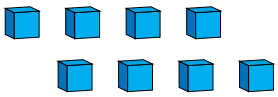

8

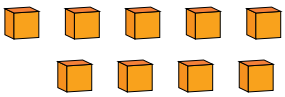

9

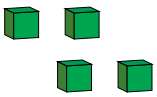

4

1

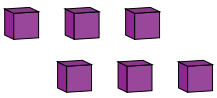

6