Representar Números (A)

¿Qué número se muestra en cada grupo de bloques base diez?

1

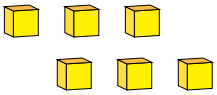

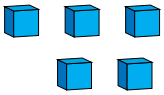

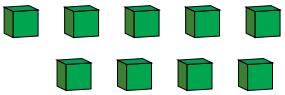

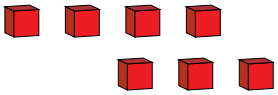

Representar Números (A) Respuestas

¿Qué número se muestra en cada grupo de bloques base diez?

1

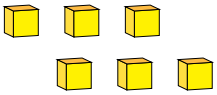

6

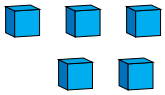

5

1

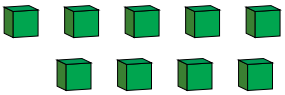

9

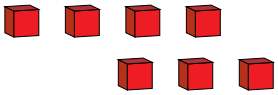

7

2

Representar Números (B)

¿Qué número se muestra en cada grupo de bloques base diez?

1

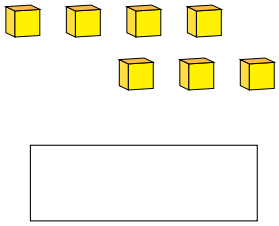

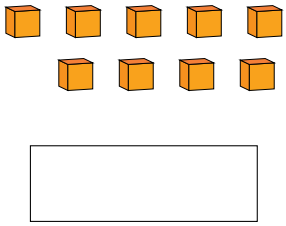

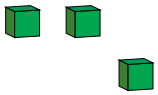

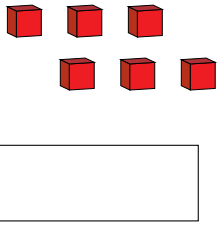

Representar Números (B) Respuestas

¿Qué número se muestra en cada grupo de bloques base diez?

1

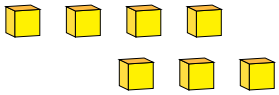

7

2

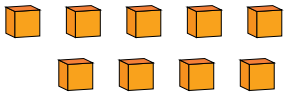

9

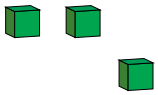

3

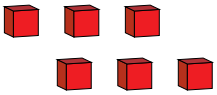

6

1

Representar Números (C)

¿Qué número se muestra en cada grupo de bloques base diez?

1

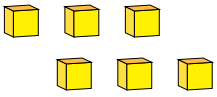

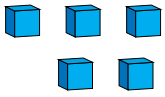

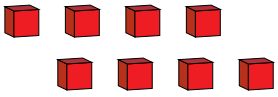

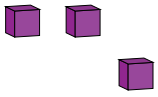

Representar Números (C) Respuestas

¿Qué número se muestra en cada grupo de bloques base diez?

1

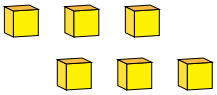

6

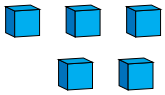

5

2

1

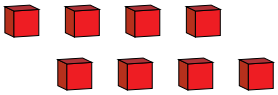

8

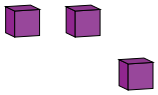

3

Representar Números (D)

¿Qué número se muestra en cada grupo de bloques base diez?

1

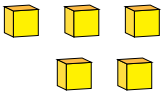

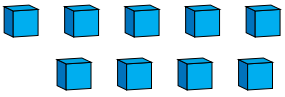

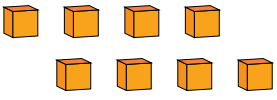

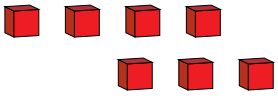

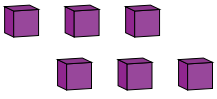

Representar Números (D) Respuestas

¿Qué número se muestra en cada grupo de bloques base diez?

1

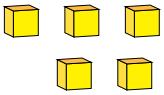

5

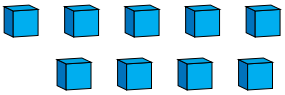

9

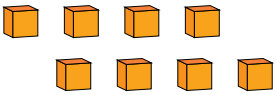

8

1

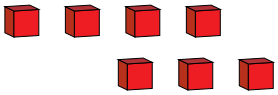

7

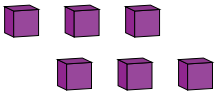

6

Representar Números (E)

¿Qué número se muestra en cada grupo de bloques base diez?

1

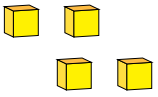

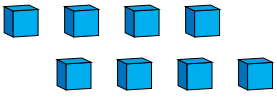

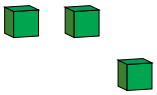

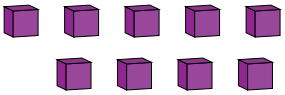

Representar Números (E) Respuestas

¿Qué número se muestra en cada grupo de bloques base diez?

1

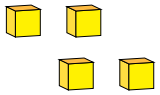

4

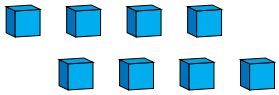

8

1

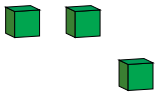

3

2

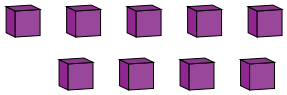

9

Representar Números (F)

¿Qué número se muestra en cada grupo de bloques base diez?

1

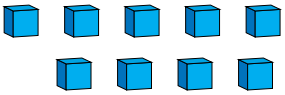

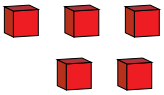

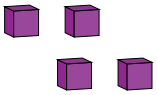

Representar Números (F) Respuestas

¿Qué número se muestra en cada grupo de bloques base diez?

1

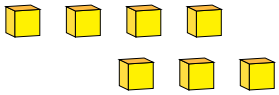

7

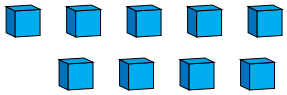

9

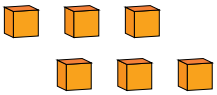

6

2

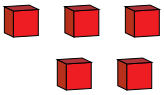

5

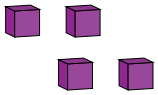

4

Representar Números (G)

¿Qué número se muestra en cada grupo de bloques base diez?

1

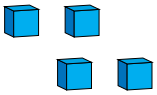

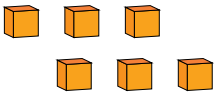

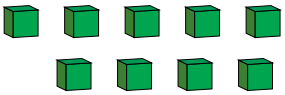

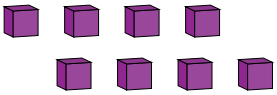

Representar Números (G) Respuestas

¿Qué número se muestra en cada grupo de bloques base diez?

1

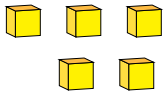

5

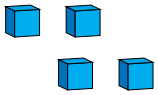

4

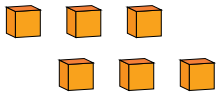

6

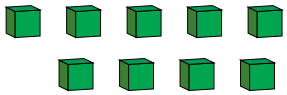

9

2

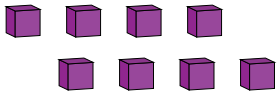

8

Representar Números (H)

¿Qué número se muestra en cada grupo de bloques base diez?

1

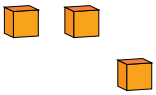

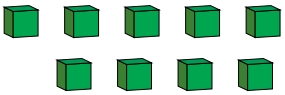

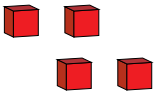

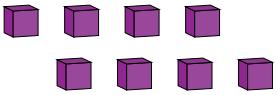

Representar Números (H) Respuestas

¿Qué número se muestra en cada grupo de bloques base diez?

1

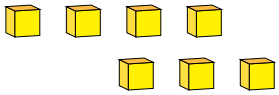

7

1

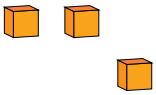

3

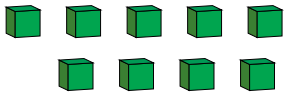

9

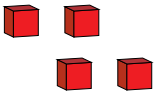

4

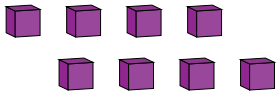

8

Representar Números (I)

¿Qué número se muestra en cada grupo de bloques base diez?

1

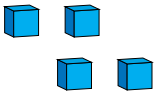

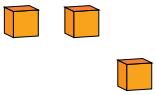

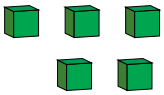

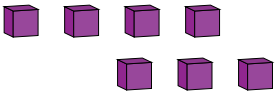

Representar Números (I) Respuestas

¿Qué número se muestra en cada grupo de bloques base diez?

1

1

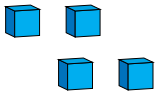

4

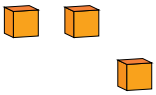

3

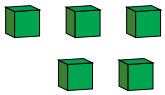

5

2

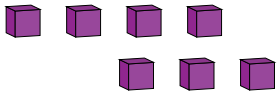

7

Representar Números (J)

¿Qué número se muestra en cada grupo de bloques base diez?

1

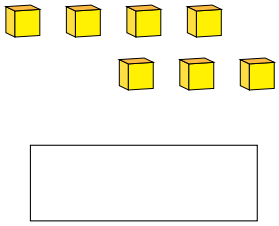

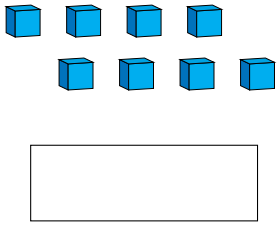

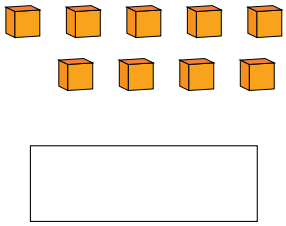

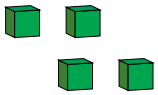

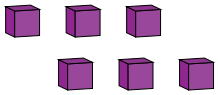

Representar Números (J) Respuestas

¿Qué número se muestra en cada grupo de bloques base diez?

1

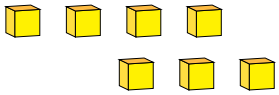

7

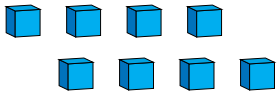

8

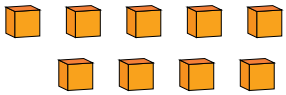

9

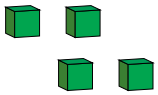

4

1

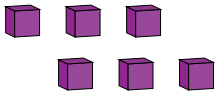

6