Números Perdidos de Verano Suma y Resta (E)

Nombre: _____ Fecha: _____ Puntuación: _____

Completen los dígitos que faltan, que se derritieron bajo el ardiente sol del verano.

1. $\begin{array}{r} 5\,3\,\square\,4 \\ +\ \square\,3\,6\,\square \\ \hline 6\,\square\,5\,1 \end{array}$

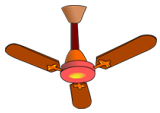

2. $\begin{array}{r} 8\,\square\,4\,\square \\ -\ 6\,8\,1\,3 \\ \hline \square\,0\,\square\,4 \end{array}$

3. $\begin{array}{r} \square\,8\,\square\,5 \\ +\ 2\,\square\,6\,0 \\ \hline 8\,5\,9\,\square \end{array}$

4. $\begin{array}{r} 3\,\square\,\square\,3 \\ +\ \square\,8\,5\,\square \\ \hline \square\,2\,0\,1\,3 \end{array}$

5. $\begin{array}{r} \square\,4\,\square\,8\,1 \\ -\ 8\,2\,\square\,\square \\ \hline \square\,8\,6\,5 \end{array}$

6. $\begin{array}{r} \square\,5\,9\,\square \\ +\ 9\,8\,4\,1 \\ \hline \square\,3\,\square\,\square\,1 \end{array}$

7. $\begin{array}{r} 3\,\square\,3\,4 \\ -\ \square\,0\,3\,\square \\ \hline 2\,7\,\square\,6 \end{array}$

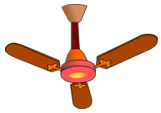

8. $\begin{array}{r} 5\,4\,4\,\square \\ +\ 6\,\square\,1\,6 \\ \hline \square\,\square\,4\,\square\,4 \end{array}$

9. $\begin{array}{r} \square\,0\,8\,\square \\ +\ 8\,4\,\square\,8 \\ \hline 9\,\square\,7\,3 \end{array}$

10. $\begin{array}{r} \square\,1\,\square\,6\,3 \\ -\ \square\,8\,3\,\square \\ \hline 7\,0\,\square\,3 \end{array}$

11. $\begin{array}{r} \square\,\square\,\square\,0\,2 \\ -\ 9\,3\,\square\,\square \\ \hline 5\,1\,2\,9 \end{array}$

12. $\begin{array}{r} 9\,\square\,5\,\square \\ -\ 3\,2\,\square\,7 \\ \hline \square\,4\,5\,2 \end{array}$

13. $\begin{array}{r} 9\,\square\,\square\,7 \\ +\ \square\,9\,4\,9 \\ \hline \square\,4\,3\,7\,\square \end{array}$



14. $\begin{array}{r} \square\,6\,6\,\square \\ +\ 6\,\square\,\square\,9 \\ \hline 8\,0\,0\,9 \end{array}$

15. $\begin{array}{r} 3\,0\,\square\,2 \\ +\ 3\,3\,7\,\square \\ \hline \square\,\square\,6\,7 \end{array}$

16. $\begin{array}{r} 4\,\square\,6\,2 \\ +\ \square\,7\,\square\,9 \\ \hline 9\,4\,4\,\square \end{array}$

17. $\begin{array}{r} \square\,\square\,8\,\square\,2 \\ -\ 3\,6\,3\,\square \\ \hline 8\,\square\,4\,8 \end{array}$

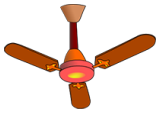

18. $\begin{array}{r} 8\,7\,\square\,\square \\ -\ \square\,\square\,0\,3 \\ \hline 1\,7\,7\,0 \end{array}$

19. $\begin{array}{r} \square\,2\,\square\,9\,\square \\ -\ 9\,4\,7\,8 \\ \hline \square\,1\,\square\,8 \end{array}$

20. $\begin{array}{r} \square\,2\,9\,4\,3 \\ -\ \square\,9\,\square\,\square \\ \hline 9\,\square\,3\,3 \end{array}$