Partes de Un Grupo (J)



En este grupo hay 18 formas y 12 están rellenas.

$$\frac{\text{12 formas rellenadas}}{\text{18 formas en el grupo}} = \frac{12}{18} = \frac{2}{3}$$

Escriba una fracción para cada uno de los modelos siguientes.



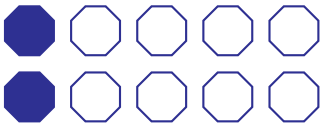









Partes de Un Grupo (J) Respuestas



En este grupo hay 18 formas y 12 están rellenas.

$$\frac{\text{12 formas rellenadas}}{\text{18 formas en el grupo}} = \frac{12}{18} = \frac{2}{3}$$

Escriba una fracción para cada uno de los modelos siguientes.

$$\frac{1}{2}$$



$$\frac{12}{20} = \frac{3}{5}$$

$$\frac{2}{3}$$

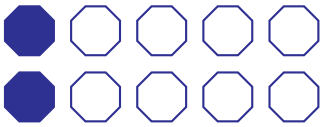

$$\frac{2}{10} = \frac{1}{5}$$



$$\frac{4}{16} = \frac{1}{4}$$



$$\frac{8}{20} = \frac{2}{5}$$



$$\frac{2}{6} = \frac{1}{3}$$



$$\frac{12}{15} = \frac{4}{5}$$