Partes de Un Grupo (A)



En este grupo hay 15 formas y 3 están rellenas.

$$\frac{\text{3 formas rellenadas}}{\text{15 formas en el grupo}} = \frac{3}{15} = \frac{1}{5}$$

Escriba una fracción para cada uno de los modelos siguientes.











Partes de Un Grupo (A) Respuestas



En este grupo hay 15 formas y 3 están rellenas.

$$\frac{\text{3 formas rellenadas}}{\text{15 formas en el grupo}} = \frac{3}{15} = \frac{1}{5}$$

Escriba una fracción para cada uno de los modelos siguientes.



$$\frac{8}{16} = \frac{1}{2}$$



$$\frac{8}{24} = \frac{1}{3}$$



$$\frac{16}{20} = \frac{4}{5}$$



$$\frac{12}{16} = \frac{3}{4}$$

$$\frac{2}{5}$$

$$\frac{3}{15} = \frac{1}{5}$$



$$\frac{6}{9} = \frac{2}{3}$$

$$\frac{6}{10} = \frac{3}{5}$$

Partes de Un Grupo (B)

En este grupo hay 10 formas y 5 están rellenas.

$$\frac{\text{5 formas rellenadas}}{\text{10 formas en el grupo}} = \frac{5}{10} = \frac{1}{2}$$

Escriba una fracción para cada uno de los modelos siguientes.







Partes de Un Grupo (B) Respuestas

En este grupo hay 10 formas y 5 están rellenas.

$$\frac{5 \text{ formas rellenadas}}{10 \text{ formas en el grupo}} = \frac{5}{10} = \frac{1}{2}$$

Escriba una fracción para cada uno de los modelos siguientes.

$$\frac{4}{8} = \frac{1}{2}$$



$$\frac{6}{9} = \frac{2}{3}$$

$$\frac{4}{10} = \frac{2}{5}$$

$$\frac{18}{24} = \frac{3}{4}$$

$$\frac{2}{6} = \frac{1}{3}$$

$$\frac{3}{5}$$



$$\frac{4}{20} = \frac{1}{5}$$

$$\frac{8}{10} = \frac{4}{5}$$

Partes de Un Grupo (C)



En este grupo hay 15 formas y 6 están rellenas.

$$\frac{\text{6 formas rellenadas}}{\text{15 formas en el grupo}} = \frac{6}{15} = \frac{2}{5}$$

Escriba una fracción para cada uno de los modelos siguientes.



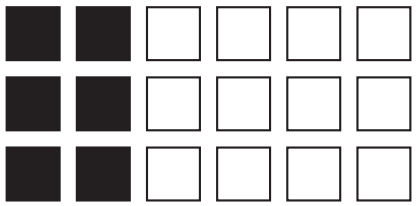

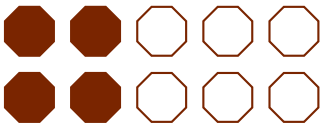

Partes de Un Grupo (C) Respuestas



En este grupo hay 15 formas y 6 están rellenas.

$$\frac{\text{6 formas rellenadas}}{\text{15 formas en el grupo}} = \frac{6}{15} = \frac{2}{5}$$

Escriba una fracción para cada uno de los modelos siguientes.



$$\frac{9}{18} = \frac{1}{2}$$

$$\frac{3}{5}$$

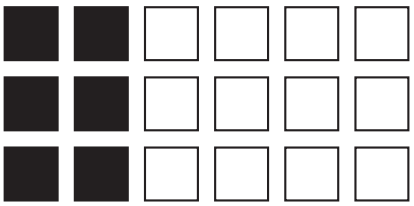

$$\frac{6}{18} = \frac{1}{3}$$

$$\frac{3}{4}$$

$$\frac{2}{3}$$

$$\frac{1}{5}$$

$$\frac{8}{10} = \frac{4}{5}$$

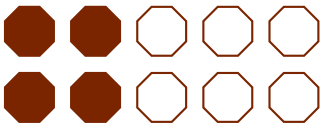

$$\frac{4}{10} = \frac{2}{5}$$

Partes de Un Grupo (D)

En este grupo hay 10 formas y 2 están rellenas.

$$\frac{\text{2 formas rellenadas}}{\text{10 formas en el grupo}} = \frac{2}{10} = \frac{1}{5}$$

Escriba una fracción para cada uno de los modelos siguientes.







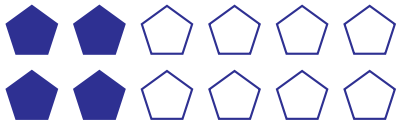



Partes de Un Grupo (D) Respuestas

En este grupo hay 10 formas y 2 están rellenas.

$$\frac{\text{2 formas rellenadas}}{\text{10 formas en el grupo}} = \frac{2}{10} = \frac{1}{5}$$

Escriba una fracción para cada uno de los modelos siguientes.

$\frac{4}{5}$

$\frac{6}{10} = \frac{3}{5}$

$\frac{1}{2}$



$\frac{6}{9} = \frac{2}{3}$



$\frac{18}{24} = \frac{3}{4}$



$\frac{3}{15} = \frac{1}{5}$

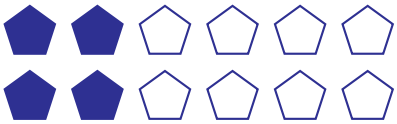

$\frac{4}{12} = \frac{1}{3}$



$\frac{6}{15} = \frac{2}{5}$

Partes de Un Grupo (E)



En este grupo hay 20 formas y 5 están rellenas.

$$\frac{5 \text{ formas rellenadas}}{20 \text{ formas en el grupo}} = \frac{5}{20} = \frac{1}{4}$$

Escriba una fracción para cada uno de los modelos siguientes.



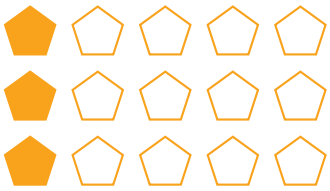









Partes de Un Grupo (E) Respuestas



En este grupo hay 20 formas y 5 están rellenas.

$$\frac{5 \text{ formas rellenadas}}{20 \text{ formas en el grupo}} = \frac{5}{20} = \frac{1}{4}$$

Escriba una fracción para cada uno de los modelos siguientes.



$$\frac{12}{18} = \frac{2}{3}$$

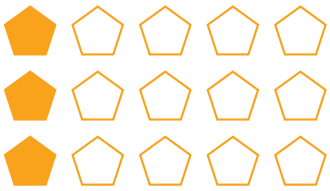

$$\frac{3}{15} = \frac{1}{5}$$



$$\frac{8}{24} = \frac{1}{3}$$



$$\frac{9}{15} = \frac{3}{5}$$



$$\frac{8}{16} = \frac{1}{2}$$

$$\frac{12}{15} = \frac{4}{5}$$



$$\frac{8}{20} = \frac{2}{5}$$

$$\frac{6}{8} = \frac{3}{4}$$

Partes de Un Grupo (F)



En este grupo hay 15 formas y 5 están rellenas.

$$\frac{5 \text{ formas rellenadas}}{15 \text{ formas en el grupo}} = \frac{5}{15} = \frac{1}{3}$$

Escriba una fracción para cada uno de los modelos siguientes.







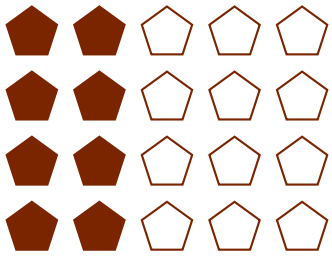



Partes de Un Grupo (F) Respuestas



En este grupo hay 15 formas y 5 están rellenas.

$$\frac{5 \text{ formas rellenadas}}{15 \text{ formas en el grupo}} = \frac{5}{15} = \frac{1}{3}$$

Escriba una fracción para cada uno de los modelos siguientes.



$$\frac{4}{20} = \frac{1}{5}$$



$$\frac{3}{6} = \frac{1}{2}$$

$$\frac{12}{15} = \frac{4}{5}$$



$$\frac{8}{24} = \frac{1}{3}$$

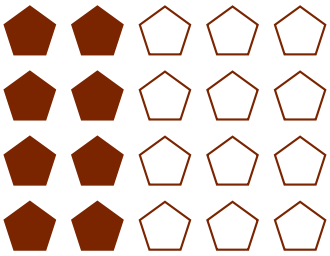

$$\frac{8}{20} = \frac{2}{5}$$



$$\frac{3}{12} = \frac{1}{4}$$

$$\frac{4}{6} = \frac{2}{3}$$

$$\frac{3}{5}$$

Partes de Un Grupo (G)

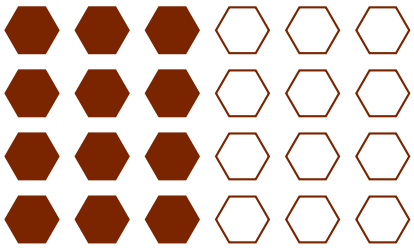

En este grupo hay 24 formas y 12 están rellenas.

$$\frac{\text{12 formas rellenadas}}{\text{24 formas en el grupo}} = \frac{12}{24} = \frac{1}{2}$$

Escriba una fracción para cada uno de los modelos siguientes.













Partes de Un Grupo (G) Respuestas

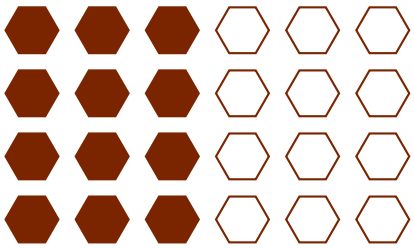

En este grupo hay 24 formas y 12 están rellenas.

$$\frac{\text{12 formas rellenadas}}{\text{24 formas en el grupo}} = \frac{12}{24} = \frac{1}{2}$$

Escriba una fracción para cada uno de los modelos siguientes.



$$\frac{3}{9} = \frac{1}{3}$$



$$\frac{6}{15} = \frac{2}{5}$$

$$\frac{2}{10} = \frac{1}{5}$$



$$\frac{12}{20} = \frac{3}{5}$$



$$\frac{16}{24} = \frac{2}{3}$$

$$\frac{4}{5}$$



$$\frac{10}{20} = \frac{1}{2}$$



$$\frac{6}{24} = \frac{1}{4}$$

Partes de Un Grupo (H)



En este grupo hay 15 formas y 6 están rellenas.

$$\frac{\text{6 formas rellenadas}}{\text{15 formas en el grupo}} = \frac{6}{15} = \frac{2}{5}$$

Escriba una fracción para cada uno de los modelos siguientes.







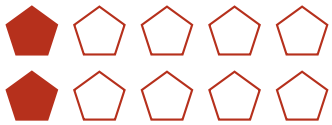



Partes de Un Grupo (H) Respuestas



En este grupo hay 15 formas y 6 están rellenas.

$$\frac{\text{6 formas rellenadas}}{\text{15 formas en el grupo}} = \frac{6}{15} = \frac{2}{5}$$

Escriba una fracción para cada uno de los modelos siguientes.

$$\frac{1}{2}$$



$$\frac{16}{20} = \frac{4}{5}$$



$$\frac{4}{16} = \frac{1}{4}$$



$$\frac{6}{9} = \frac{2}{3}$$

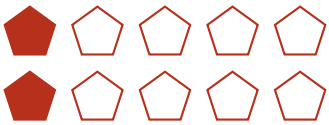

$$\frac{2}{10} = \frac{1}{5}$$

$$\frac{6}{10} = \frac{3}{5}$$

$$\frac{5}{15} = \frac{1}{3}$$



$$\frac{6}{15} = \frac{2}{5}$$

Partes de Un Grupo (I)

En este grupo hay 6 formas y 4 están rellenas.

$$\frac{\text{4 formas rellenadas}}{\text{6 formas en el grupo}} = \frac{4}{6} = \frac{2}{3}$$

Escriba una fracción para cada uno de los modelos siguientes.







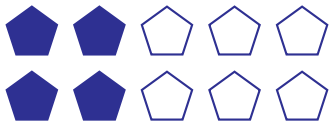





Partes de Un Grupo (I) Respuestas

En este grupo hay 6 formas y 4 están rellenas.

$$\frac{\text{4 formas rellenadas}}{\text{6 formas en el grupo}} = \frac{4}{6} = \frac{2}{3}$$

Escriba una fracción para cada uno de los modelos siguientes.

$$\frac{6}{10} = \frac{3}{5}$$



$$\frac{6}{24} = \frac{1}{4}$$



$$\frac{5}{10} = \frac{1}{2}$$



$$\frac{5}{15} = \frac{1}{3}$$

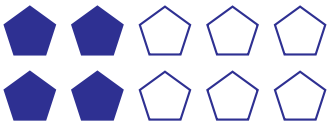

$$\frac{4}{10} = \frac{2}{5}$$



$$\frac{12}{15} = \frac{4}{5}$$



$$\frac{4}{6} = \frac{2}{3}$$

$$\frac{1}{5}$$

Partes de Un Grupo (J)



En este grupo hay 18 formas y 12 están rellenas.

$$\frac{\text{12 formas rellenadas}}{\text{18 formas en el grupo}} = \frac{12}{18} = \frac{2}{3}$$

Escriba una fracción para cada uno de los modelos siguientes.



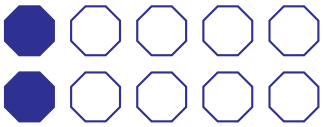









Partes de Un Grupo (J) Respuestas



En este grupo hay 18 formas y 12 están rellenas.

$$\frac{\text{12 formas rellenadas}}{\text{18 formas en el grupo}} = \frac{12}{18} = \frac{2}{3}$$

Escriba una fracción para cada uno de los modelos siguientes.

$$\frac{1}{2}$$



$$\frac{12}{20} = \frac{3}{5}$$

$$\frac{2}{3}$$

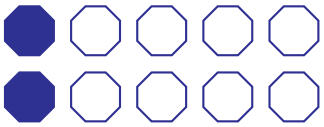

$$\frac{2}{10} = \frac{1}{5}$$



$$\frac{4}{16} = \frac{1}{4}$$



$$\frac{8}{20} = \frac{2}{5}$$



$$\frac{2}{6} = \frac{1}{3}$$



$$\frac{12}{15} = \frac{4}{5}$$