Partes de Un Grupo (H)



En este grupo hay 24 formas y 4 están rellenas.

$$\frac{\text{4 formas rellenadas}}{\text{24 formas en el grupo}} = \frac{4}{24} = \frac{1}{6}$$

Escriba una fracción para cada uno de los modelos siguientes.



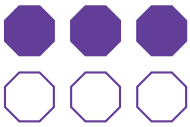





Partes de Un Grupo (H) Respuestas



En este grupo hay 24 formas y 4 están rellenas.

$$\frac{\text{4 formas rellenadas}}{\text{24 formas en el grupo}} = \frac{4}{24} = \frac{1}{6}$$

Escriba una fracción para cada uno de los modelos siguientes.

$$\frac{2}{3}$$

$$\frac{1}{5}$$



$$\frac{2}{8} = \frac{1}{4}$$

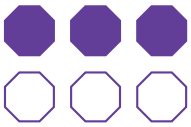

$$\frac{3}{6} = \frac{1}{2}$$



$$\frac{6}{10} = \frac{3}{5}$$

$$\frac{10}{12} = \frac{5}{6}$$

$$\frac{2}{6} = \frac{1}{3}$$



$$\frac{3}{18} = \frac{1}{6}$$