Modelar Cuartos (A)

Escriba la fraccón correcta para cada modelo.



$\frac{3}{4}$



$\frac{\quad}{4}$



$\frac{\quad}{4}$



$\frac{\quad}{4}$



$\frac{\quad}{\quad}$



$\frac{\quad}{\quad}$



$\frac{\quad}{\quad}$



$\frac{\quad}{\quad}$



$\frac{\quad}{\quad}$



$\frac{\quad}{\quad}$



$\frac{\quad}{\quad}$



$\frac{\quad}{\quad}$



$\frac{\quad}{\quad}$



$\frac{\quad}{\quad}$



$\frac{\quad}{\quad}$



$\frac{\quad}{\quad}$



$\frac{\quad}{\quad}$



$\frac{\quad}{\quad}$



$\frac{\quad}{\quad}$



$\frac{\quad}{\quad}$



$\frac{\quad}{\quad}$



$\frac{\quad}{\quad}$



$\frac{\quad}{\quad}$



$\frac{\quad}{\quad}$



$\frac{\quad}{\quad}$



$\frac{\quad}{\quad}$



$\frac{\quad}{\quad}$



$\frac{\quad}{\quad}$

Modelar Cuartos (A) Respuestas

Escriba la fraccón correcta para cada modelo.



$\frac{3}{4}$



$\frac{4}{4}$



$\frac{1}{4}$



$\frac{2}{4}$



$\frac{2}{4}$



$\frac{3}{4}$



$\frac{1}{4}$



$\frac{4}{4}$



$\frac{1}{4}$



$\frac{1}{4}$



$\frac{4}{4}$



$\frac{3}{4}$



$\frac{2}{4}$



$\frac{1}{4}$



$\frac{3}{4}$



$\frac{3}{4}$



$\frac{3}{4}$



$\frac{1}{4}$



$\frac{1}{4}$



$\frac{2}{4}$



$\frac{3}{4}$



$\frac{1}{4}$



$\frac{2}{4}$



$\frac{4}{4}$



$\frac{1}{4}$



$\frac{3}{4}$



$\frac{4}{4}$



$\frac{3}{4}$

Modelar Cuartos (B)

Escriba la fraccón correcta para cada modelo.



$\frac{2}{4}$



$\frac{\quad}{4}$



$\frac{\quad}{4}$



$\frac{\quad}{4}$



____



____



____



____



____



____



____



____



____



____



____



____



____



____



____



____



____



____



____



____



____



____



____



____

Modelar Cuartos (B) Respuestas

Escriba la fraccón correcta para cada modelo.



$\frac{2}{4}$



$\frac{1}{4}$



$\frac{1}{4}$



$\frac{3}{4}$



$\frac{4}{4}$



$\frac{4}{4}$



$\frac{2}{4}$



$\frac{3}{4}$



$\frac{2}{4}$



$\frac{3}{4}$



$\frac{2}{4}$



$\frac{4}{4}$



$\frac{2}{4}$



$\frac{1}{4}$



$\frac{1}{4}$



$\frac{2}{4}$



$\frac{1}{4}$



$\frac{2}{4}$



$\frac{1}{4}$



$\frac{4}{4}$



$\frac{2}{4}$



$\frac{3}{4}$



$\frac{3}{4}$



$\frac{3}{4}$



$\frac{3}{4}$



$\frac{4}{4}$



$\frac{2}{4}$



$\frac{3}{4}$

Modelar Cuartos (C)

Escriba la fraccón correcta para cada modelo.



$\frac{1}{4}$



$\frac{\quad}{4}$



$\frac{\quad}{4}$



$\frac{\quad}{4}$



____



____



____



____



____



____



____



____



____



____



____



____



____



____



____



____



____



____



____



____



____



____



____



____

Modelar Cuartos (C) Respuestas

Escriba la fraccón correcta para cada modelo.



$\frac{1}{4}$



$\frac{2}{4}$



$\frac{4}{4}$



$\frac{3}{4}$



$\frac{4}{4}$



$\frac{2}{4}$



$\frac{3}{4}$



$\frac{4}{4}$



$\frac{3}{4}$



$\frac{3}{4}$



$\frac{3}{4}$



$\frac{4}{4}$



$\frac{1}{4}$



$\frac{1}{4}$



$\frac{3}{4}$



$\frac{3}{4}$



$\frac{2}{4}$



$\frac{4}{4}$



$\frac{1}{4}$



$\frac{1}{4}$



$\frac{1}{4}$



$\frac{2}{4}$



$\frac{1}{4}$



$\frac{4}{4}$



$\frac{3}{4}$



$\frac{3}{4}$



$\frac{1}{4}$



$\frac{1}{4}$

Modelar Cuartos (D)

Escriba la fraccón correcta para cada modelo.



$\frac{2}{4}$



$\frac{\quad}{4}$



$\frac{\quad}{4}$



$\frac{\quad}{4}$



$\frac{\quad}{\quad}$



$\frac{\quad}{\quad}$



$\frac{\quad}{\quad}$



$\frac{\quad}{\quad}$



$\frac{\quad}{\quad}$



$\frac{\quad}{\quad}$



$\frac{\quad}{\quad}$



$\frac{\quad}{\quad}$



$\frac{\quad}{\quad}$



$\frac{\quad}{\quad}$



$\frac{\quad}{\quad}$



$\frac{\quad}{\quad}$



$\frac{\quad}{\quad}$



$\frac{\quad}{\quad}$



$\frac{\quad}{\quad}$



$\frac{\quad}{\quad}$



$\frac{\quad}{\quad}$



$\frac{\quad}{\quad}$



$\frac{\quad}{\quad}$



$\frac{\quad}{\quad}$



$\frac{\quad}{\quad}$



$\frac{\quad}{\quad}$



$\frac{\quad}{\quad}$



$\frac{\quad}{\quad}$

Modelar Cuartos (D) Respuestas

Escriba la fraccón correcta para cada modelo.



$\frac{2}{4}$



$\frac{3}{4}$



$\frac{3}{4}$



$\frac{2}{4}$



$\frac{1}{4}$



$\frac{1}{4}$



$\frac{3}{4}$



$\frac{3}{4}$



$\frac{1}{4}$



$\frac{1}{4}$



$\frac{2}{4}$



$\frac{4}{4}$



$\frac{1}{4}$



$\frac{1}{4}$



$\frac{2}{4}$



$\frac{4}{4}$



$\frac{3}{4}$



$\frac{3}{4}$



$\frac{4}{4}$



$\frac{2}{4}$



$\frac{3}{4}$



$\frac{4}{4}$



$\frac{1}{4}$



$\frac{2}{4}$



$\frac{2}{4}$



$\frac{1}{4}$



$\frac{4}{4}$



$\frac{2}{4}$

Modelar Cuartos (E)

Escriba la fraccón correcta para cada modelo.



$\frac{3}{4}$



$\frac{\quad}{4}$



$\frac{\quad}{4}$



$\frac{\quad}{4}$



____



____



____



____



____



____



____



____



____



____



____



____



____



____



____



____



____



____



____



____



____



____



____



____

Modelar Cuartos (E) Respuestas

Escriba la fraccón correcta para cada modelo.



$\frac{3}{4}$



$\frac{1}{4}$



$\frac{3}{4}$



$\frac{2}{4}$



$\frac{1}{4}$



$\frac{4}{4}$



$\frac{1}{4}$



$\frac{2}{4}$



$\frac{2}{4}$



$\frac{1}{4}$



$\frac{4}{4}$



$\frac{3}{4}$



$\frac{3}{4}$



$\frac{3}{4}$



$\frac{4}{4}$



$\frac{4}{4}$



$\frac{1}{4}$



$\frac{3}{4}$



$\frac{4}{4}$



$\frac{2}{4}$



$\frac{1}{4}$



$\frac{3}{4}$



$\frac{3}{4}$



$\frac{3}{4}$



$\frac{4}{4}$



$\frac{2}{4}$



$\frac{4}{4}$



$\frac{3}{4}$

Modelar Cuartos (F)

Escriba la fraccón correcta para cada modelo.



$\frac{3}{4}$



$\frac{\quad}{4}$



$\frac{\quad}{4}$



$\frac{\quad}{4}$



____



____



____



____



____



____



____



____



____



____



____



____



____



____



____



____



____



____



____



____



____



____



____



____

Modelar Cuartos (F) Respuestas

Escriba la fraccón correcta para cada modelo.



$\frac{3}{4}$



$\frac{2}{4}$



$\frac{1}{4}$



$\frac{1}{4}$



$\frac{4}{4}$



$\frac{1}{4}$



$\frac{3}{4}$



$\frac{2}{4}$



$\frac{2}{4}$



$\frac{3}{4}$



$\frac{1}{4}$



$\frac{3}{4}$



$\frac{3}{4}$



$\frac{4}{4}$



$\frac{2}{4}$



$\frac{1}{4}$



$\frac{2}{4}$



$\frac{1}{4}$



$\frac{2}{4}$



$\frac{4}{4}$



$\frac{3}{4}$



$\frac{2}{4}$



$\frac{3}{4}$



$\frac{4}{4}$



$\frac{3}{4}$



$\frac{4}{4}$



$\frac{3}{4}$



$\frac{3}{4}$

Modelar Cuartos (G)

Escriba la fraccón correcta para cada modelo.



$\frac{2}{4}$



$\frac{\quad}{4}$



$\frac{\quad}{4}$



$\frac{\quad}{4}$



____



____



____



____



____



____



____



____



____



____



____



____



____



____



____



____



____



____



____



____



____



____



____



____

Modelar Cuartos (G) Respuestas

Escriba la fraccón correcta para cada modelo.



$\frac{2}{4}$



$\frac{3}{4}$



$\frac{2}{4}$



$\frac{4}{4}$



$\frac{1}{4}$



$\frac{1}{4}$



$\frac{1}{4}$



$\frac{1}{4}$



$\frac{4}{4}$



$\frac{1}{4}$



$\frac{2}{4}$



$\frac{2}{4}$



$\frac{2}{4}$



$\frac{4}{4}$



$\frac{3}{4}$



$\frac{2}{4}$



$\frac{4}{4}$



$\frac{1}{4}$



$\frac{1}{4}$



$\frac{3}{4}$



$\frac{2}{4}$



$\frac{4}{4}$



$\frac{3}{4}$



$\frac{1}{4}$



$\frac{4}{4}$



$\frac{2}{4}$



$\frac{3}{4}$



$\frac{1}{4}$

Modelar Cuartos (H)

Escriba la fraccón correcta para cada modelo.



$\frac{2}{4}$



$\frac{\quad}{4}$



$\frac{\quad}{4}$



$\frac{\quad}{4}$



____



____



____



____



____



____



____



____



____



____



____



____



____



____



____



____



____



____



____



____



____



____



____



____

Modelar Cuartos (H) Respuestas

Escriba la fraccón correcta para cada modelo.



$\frac{2}{4}$



$\frac{1}{4}$



$\frac{1}{4}$



$\frac{1}{4}$



$\frac{4}{4}$



$\frac{2}{4}$



$\frac{2}{4}$



$\frac{1}{4}$



$\frac{3}{4}$



$\frac{3}{4}$



$\frac{4}{4}$



$\frac{2}{4}$



$\frac{1}{4}$



$\frac{3}{4}$



$\frac{2}{4}$



$\frac{3}{4}$



$\frac{2}{4}$



$\frac{2}{4}$



$\frac{3}{4}$



$\frac{1}{4}$



$\frac{1}{4}$



$\frac{4}{4}$



$\frac{3}{4}$



$\frac{1}{4}$



$\frac{4}{4}$



$\frac{1}{4}$



$\frac{3}{4}$



$\frac{1}{4}$

Modelar Cuartos (I)

Escriba la fraccón correcta para cada modelo.



$\frac{3}{4}$



$\frac{\quad}{4}$



$\frac{\quad}{4}$



$\frac{\quad}{4}$



____



____



____



____



____



____



____



____



____



____



____



____



____



____



____



____



____



____



____



____



____



____



____



____

Modelar Cuartos (I) Respuestas

Escriba la fraccón correcta para cada modelo.



$\frac{3}{4}$



$\frac{4}{4}$



$\frac{2}{4}$



$\frac{4}{4}$



$\frac{1}{4}$



$\frac{4}{4}$



$\frac{4}{4}$



$\frac{4}{4}$



$\frac{1}{4}$



$\frac{4}{4}$



$\frac{1}{4}$



$\frac{4}{4}$



$\frac{3}{4}$



$\frac{1}{4}$



$\frac{4}{4}$



$\frac{3}{4}$



$\frac{2}{4}$



$\frac{3}{4}$



$\frac{3}{4}$



$\frac{2}{4}$



$\frac{4}{4}$



$\frac{4}{4}$



$\frac{2}{4}$



$\frac{3}{4}$



$\frac{1}{4}$



$\frac{3}{4}$



$\frac{4}{4}$



$\frac{1}{4}$

Modelar Cuartos (J)

Escriba la fraccón correcta para cada modelo.



$\frac{2}{4}$



$\frac{\quad}{4}$



$\frac{\quad}{4}$



$\frac{\quad}{4}$



$\frac{\quad}{\quad}$



$\frac{\quad}{\quad}$



$\frac{\quad}{\quad}$



$\frac{\quad}{\quad}$



$\frac{\quad}{\quad}$



$\frac{\quad}{\quad}$



$\frac{\quad}{\quad}$



$\frac{\quad}{\quad}$



$\frac{\quad}{\quad}$



$\frac{\quad}{\quad}$



$\frac{\quad}{\quad}$



$\frac{\quad}{\quad}$



$\frac{\quad}{\quad}$



$\frac{\quad}{\quad}$



$\frac{\quad}{\quad}$



$\frac{\quad}{\quad}$



$\frac{\quad}{\quad}$



$\frac{\quad}{\quad}$



$\frac{\quad}{\quad}$



$\frac{\quad}{\quad}$



$\frac{\quad}{\quad}$



$\frac{\quad}{\quad}$



$\frac{\quad}{\quad}$



$\frac{\quad}{\quad}$

Modelar Cuartos (J) Respuestas

Escriba la fraccón correcta para cada modelo.



$\frac{2}{4}$



$\frac{2}{4}$



$\frac{4}{4}$



$\frac{4}{4}$



$\frac{2}{4}$



$\frac{4}{4}$



$\frac{2}{4}$



$\frac{2}{4}$



$\frac{2}{4}$



$\frac{3}{4}$



$\frac{1}{4}$



$\frac{3}{4}$



$\frac{2}{4}$



$\frac{1}{4}$



$\frac{4}{4}$



$\frac{3}{4}$



$\frac{1}{4}$



$\frac{3}{4}$



$\frac{4}{4}$



$\frac{4}{4}$



$\frac{1}{4}$



$\frac{4}{4}$



$\frac{2}{4}$



$\frac{3}{4}$



$\frac{2}{4}$



$\frac{2}{4}$



$\frac{3}{4}$



$\frac{2}{4}$