Modelando Quintos (A)

Instrucciones: Modele las fracciones coloreando. Intente colorear fracciones similares de formas diferentes.



$\frac{3}{5}$



$\frac{4}{5}$



$\frac{1}{5}$



$\frac{4}{5}$



$\frac{2}{5}$



$\frac{1}{5}$



$\frac{3}{5}$



$\frac{4}{5}$



$\frac{3}{5}$

Modelando Quintos (A) Respuestas

Instrucciones: Modele las fracciones coloreando. Intente colorear fracciones similares de formas diferentes.



$\frac{3}{5}$

$\frac{4}{5}$



$\frac{1}{5}$



$\frac{4}{5}$



$\frac{2}{5}$



$\frac{1}{5}$



$\frac{3}{5}$



$\frac{4}{5}$



$\frac{3}{5}$

Modelando Quintos (B)

Instrucciones: Modele las fracciones coloreando. Intente colorear fracciones similares de formas diferentes.



$\frac{2}{5}$



$\frac{4}{5}$



$\frac{1}{5}$



$\frac{1}{5}$



$\frac{2}{5}$



$\frac{2}{5}$



$\frac{1}{5}$



$\frac{5}{5}$



$\frac{3}{5}$

Modelando Quintos (B) Respuestas

Instrucciones: Modele las fracciones coloreando. Intente colorear fracciones similares de formas diferentes.



$\frac{2}{5}$

$\frac{4}{5}$



$\frac{1}{5}$



$\frac{1}{5}$



$\frac{2}{5}$

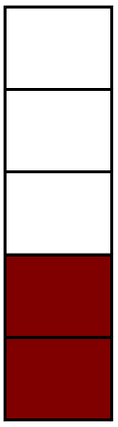

$\frac{2}{5}$

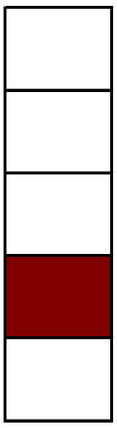

$\frac{1}{5}$

$\frac{5}{5}$



$\frac{3}{5}$

Modelando Quintos (C)

Instrucciones: Modele las fracciones coloreando. Intente colorear fracciones similares de formas diferentes.



$\frac{1}{5}$



$\frac{2}{5}$



$\frac{3}{5}$



$\frac{2}{5}$



$\frac{3}{5}$



$\frac{4}{5}$



$\frac{2}{5}$



$\frac{1}{5}$



$\frac{4}{5}$

Modelando Quintos (C) Respuestas

Instrucciones: Modele las fracciones coloreando. Intente colorear fracciones similares de formas diferentes.



$\frac{1}{5}$



$\frac{2}{5}$



$\frac{3}{5}$

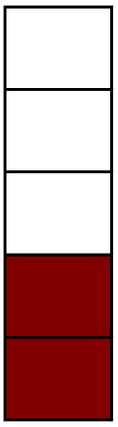

$\frac{2}{5}$



$\frac{3}{5}$



$\frac{4}{5}$



$\frac{2}{5}$



$\frac{1}{5}$



$\frac{4}{5}$

Modelando Quintos (D)

Instrucciones: Modele las fracciones coloreando. Intente colorear fracciones similares de formas diferentes.



$\frac{4}{5}$



$\frac{1}{5}$



$\frac{3}{5}$



$\frac{3}{5}$



$\frac{2}{5}$



$\frac{1}{5}$



$\frac{1}{5}$



$\frac{4}{5}$



$\frac{5}{5}$

Modelando Quintos (D) Respuestas

Instrucciones: Modele las fracciones coloreando. Intente colorear fracciones similares de formas diferentes.



$\frac{4}{5}$



$\frac{1}{5}$



$\frac{3}{5}$



$\frac{3}{5}$



$\frac{2}{5}$



$\frac{1}{5}$

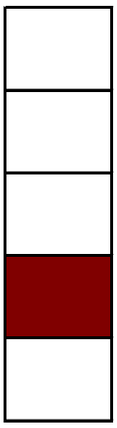

$\frac{1}{5}$

$\frac{4}{5}$



$\frac{5}{5}$

Modelando Quintos (E)

Instrucciones: Modele las fracciones coloreando. Intente colorear fracciones similares de formas diferentes.



$\frac{1}{5}$



$\frac{1}{5}$



$\frac{2}{5}$



$\frac{2}{5}$



$\frac{2}{5}$



$\frac{2}{5}$



$\frac{3}{5}$



$\frac{4}{5}$



$\frac{5}{5}$

Modelando Quintos (E) Respuestas

Instrucciones: Modele las fracciones coloreando. Intente colorear fracciones similares de formas diferentes.



$\frac{1}{5}$



$\frac{1}{5}$



$\frac{2}{5}$

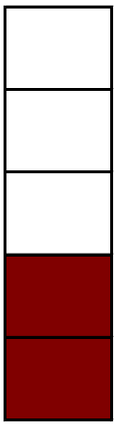

$\frac{2}{5}$



$\frac{2}{5}$



$\frac{2}{5}$



$\frac{3}{5}$



$\frac{4}{5}$



$\frac{5}{5}$