Modelos de Fracciones Equivalentes (I)

Nombre: _____ Fecha: _____

Coloreen el segundo modelo exactamente de la misma manera, y determinen las fracciones equivalentes.

1. 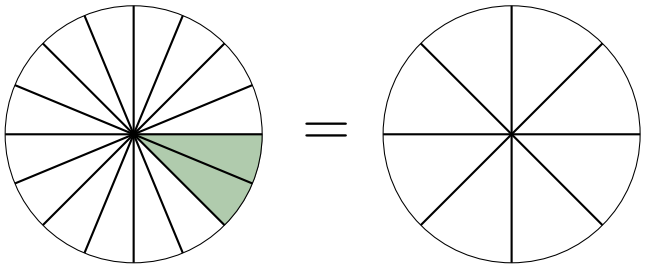 $\frac{\quad}{\quad} = \frac{\quad}{\quad}$

2. 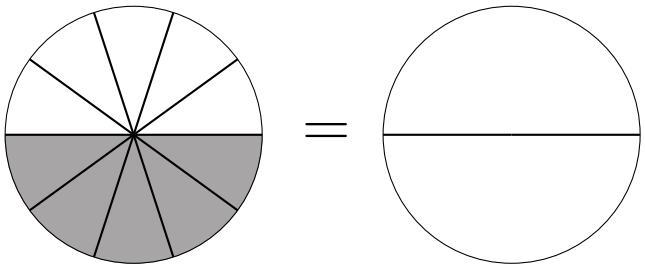 $\frac{\quad}{\quad} = \frac{\quad}{\quad}$

3. 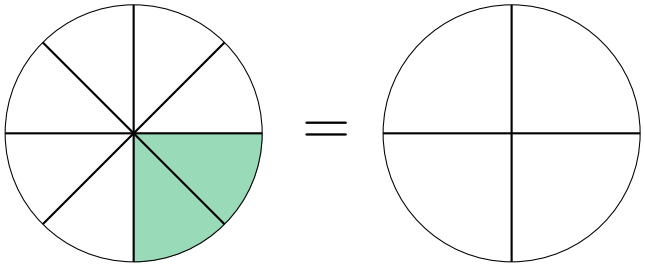 $\frac{\quad}{\quad} = \frac{\quad}{\quad}$

4. 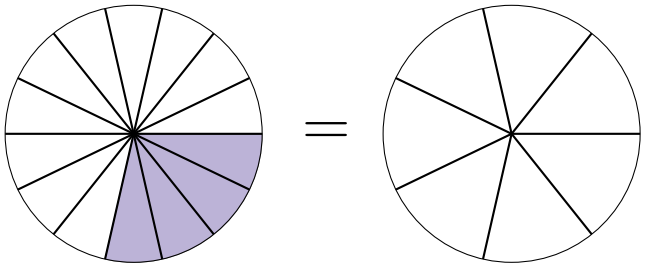 $\frac{\quad}{\quad} = \frac{\quad}{\quad}$

5. 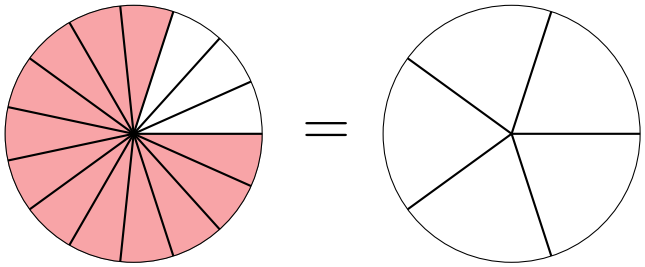 $\frac{\quad}{\quad} = \frac{\quad}{\quad}$

Modelos de Fracciones Equivalentes (I) Respuestas

Nombre: _____ Fecha: _____

Coloreen el segundo modelo exactamente de la misma manera, y determinen las fracciones equivalentes.

1. 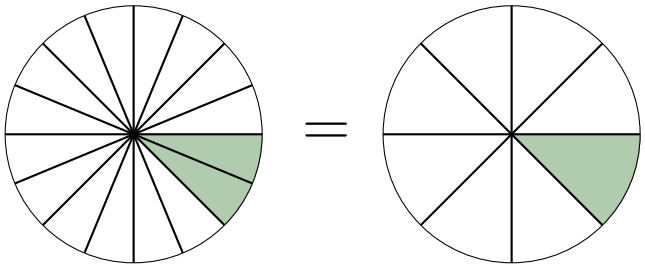 $\frac{1}{8} = \frac{2}{16}$

2. 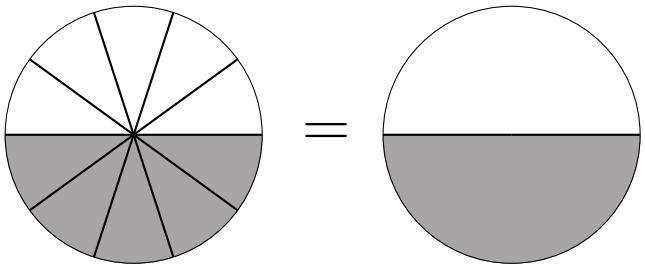 $\frac{1}{2} = \frac{5}{10}$

3. 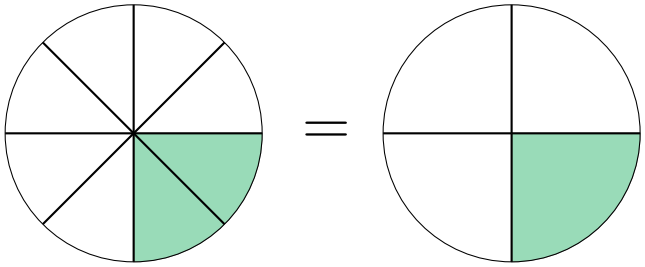 $\frac{1}{4} = \frac{2}{8}$

4. 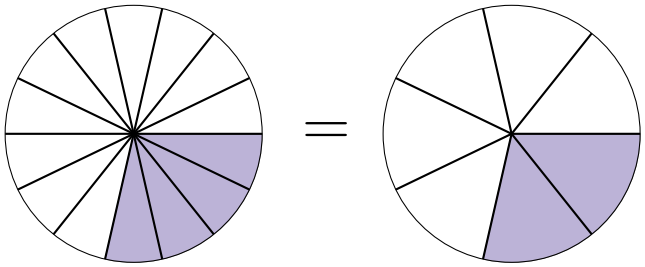 $\frac{2}{7} = \frac{4}{14}$

5. 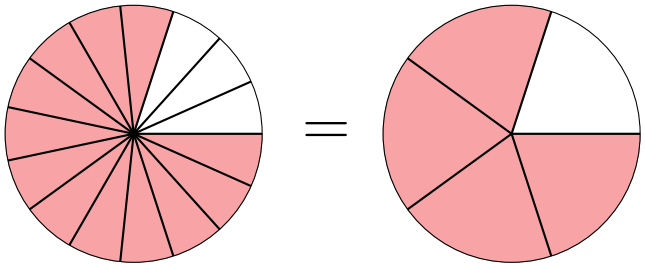 $\frac{4}{5} = \frac{12}{15}$