Modelos de Fracciones Equivalentes (B)

Nombre: _____ Fecha: _____

Coloreen el segundo modelo exactamente de la misma manera, y determinen las fracciones equivalentes.

1. 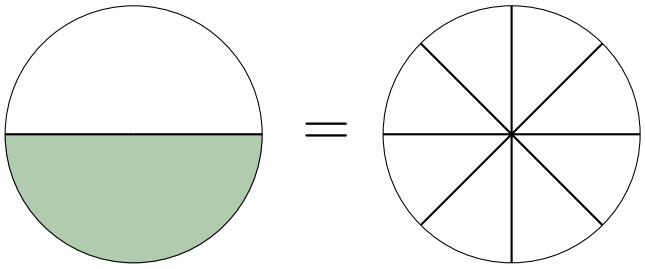 $\frac{\quad}{\quad} = \frac{\quad}{\quad}$

2. 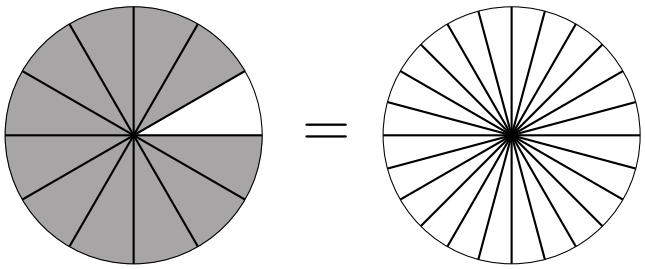 $\frac{\quad}{\quad} = \frac{\quad}{\quad}$

3. 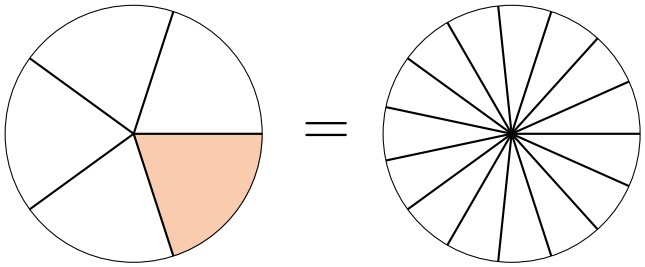 $\frac{\quad}{\quad} = \frac{\quad}{\quad}$

4. 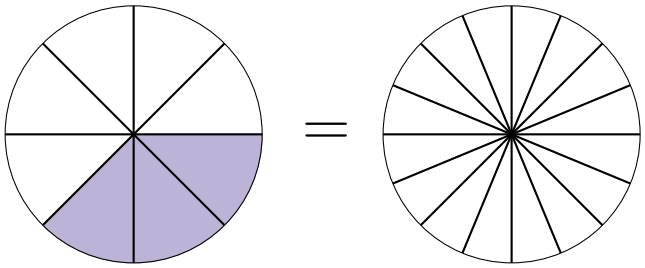 $\frac{\quad}{\quad} = \frac{\quad}{\quad}$

5. 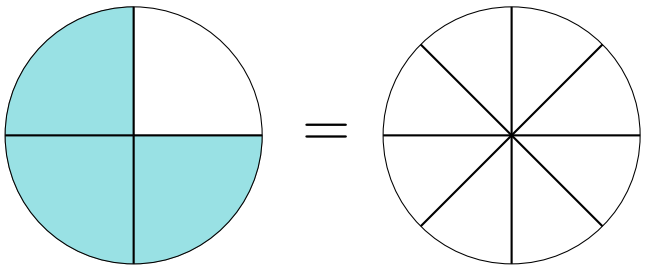 $\frac{\quad}{\quad} = \frac{\quad}{\quad}$