Modelos de Fracciones (G)

Coloree secciones de cada círculo para modelar cada fracción.

1.

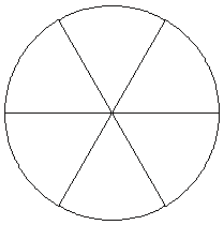

$\frac{3}{6}$

2.

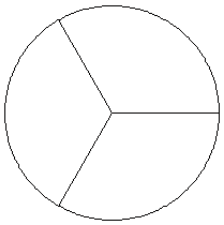

$\frac{2}{3}$

3.

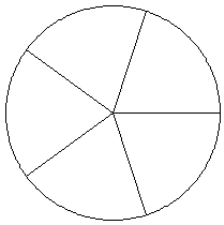

$\frac{5}{5}$

4.

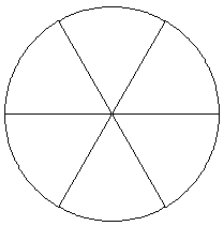

$\frac{3}{6}$

5.

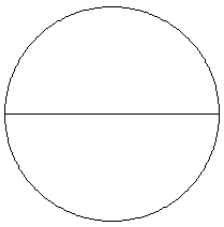

$\frac{0}{2}$

6.

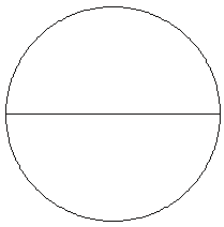

$\frac{1}{2}$

7.

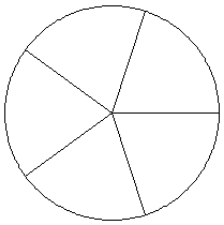

$\frac{3}{5}$

8.

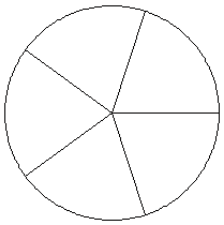

$\frac{3}{5}$

9.

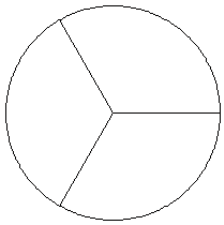

$\frac{2}{3}$

10.

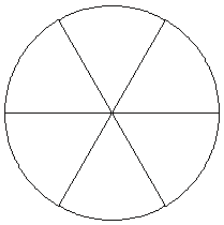

$\frac{2}{6}$

11.

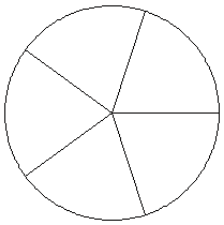

$\frac{1}{5}$

12.

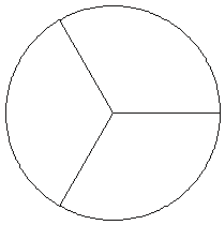

$\frac{1}{3}$

Modelos de Fracciones (G) Respuestas

Coloree secciones de cada círculo para modelar cada fracción.

1.

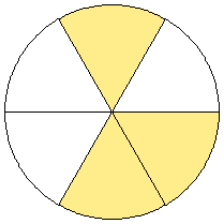

2.

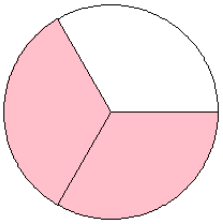

3.

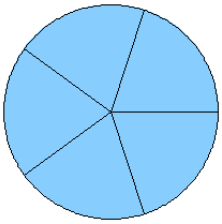

4.

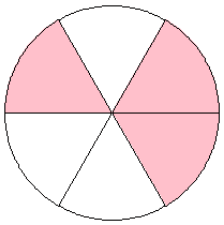

5.

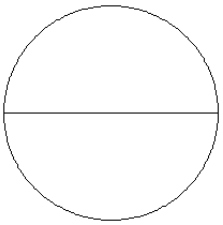

6.

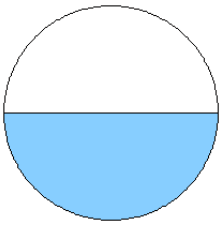

7.

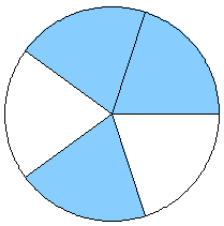

8.

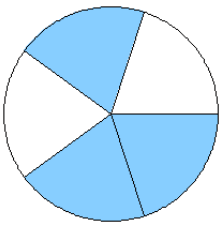

9.

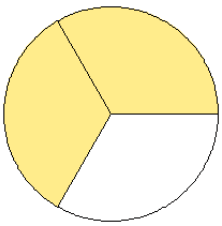

10.

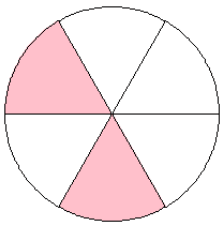

11.

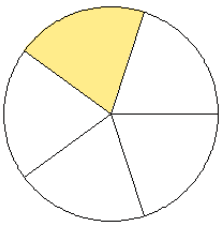
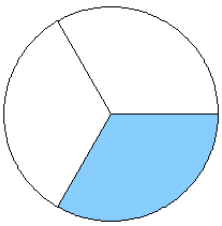
12.