Modelos de Fracciones (J)

Coloree secciones de cada círculo para modelar cada fracción.

1.

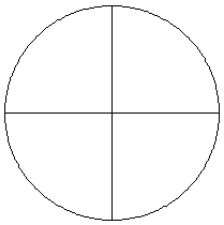

$\frac{4}{4}$

2.

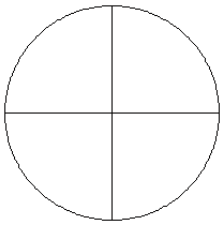

$\frac{2}{4}$

3.

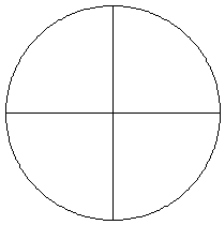

$\frac{3}{4}$

4.

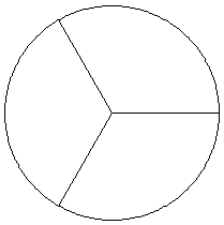

$\frac{1}{3}$

5.

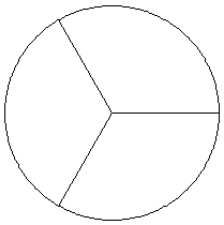

$\frac{1}{3}$

6.

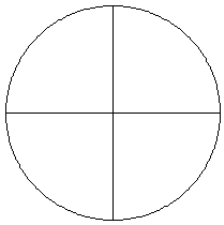

$\frac{2}{4}$

7.

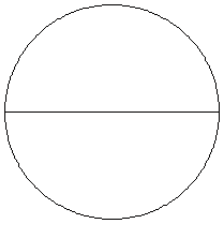

$\frac{2}{2}$

8.

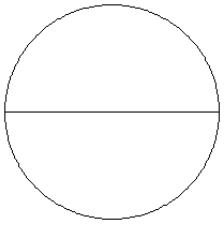

$\frac{1}{2}$

9.

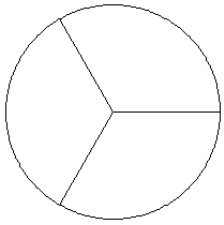

$\frac{1}{3}$

10.

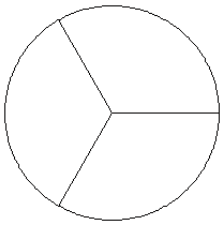

$\frac{0}{3}$

11.

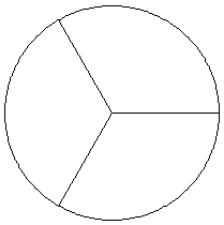

$\frac{1}{3}$

12.

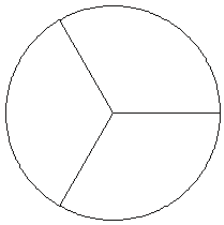

$\frac{1}{3}$

Modelos de Fracciones (J) Respuestas

Coloree secciones de cada círculo para modelar cada fracción.

1.

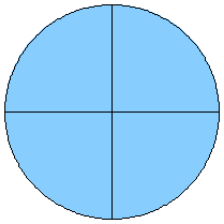

2.

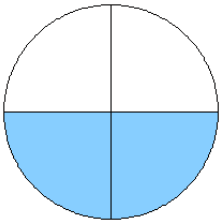

3.

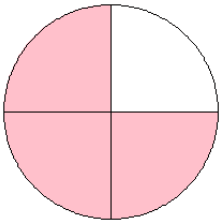

4.

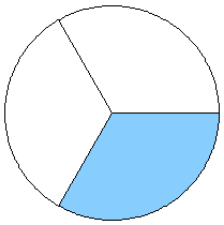

5.

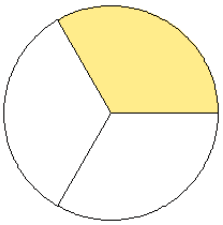

6.

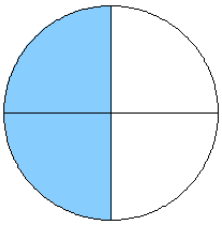

7.

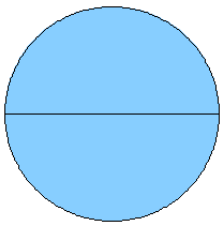

8.

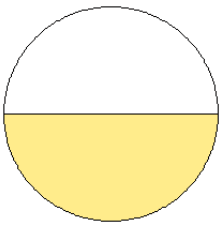

9.

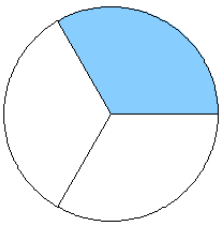

10.

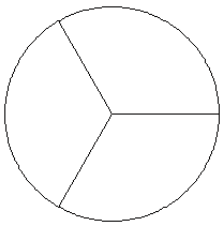

11.

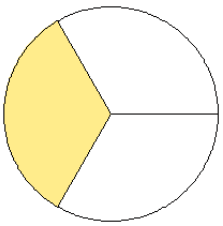
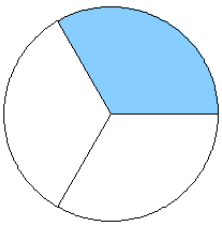
12.