Colorear Fracciones (G)

Coloreen cada grupo de figuras para representar la fracción correspondiente.

1.

$\frac{2}{3}$



2.

$\frac{1}{4}$



3.

$\frac{1}{4}$

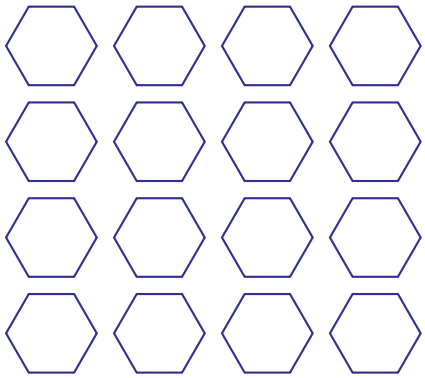

4.

$\frac{3}{4}$



5.

$\frac{1}{2}$

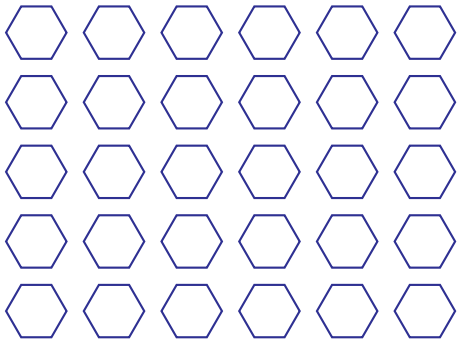

6.

$\frac{1}{3}$