Redondear Fracciones (A)

Nombre: _____ Fecha: _____

Redondee cada fracción hasta la mitad más cercana. Redondee por exceso.

1. $\frac{1}{5} \simeq$

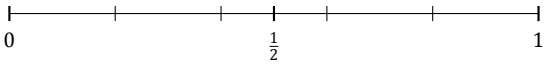

2. $\frac{7}{10} \simeq$

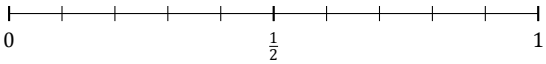

3. $\frac{6}{8} \simeq$

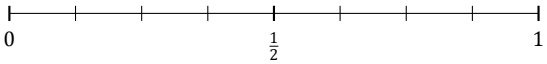

4. $\frac{1}{6} \simeq$

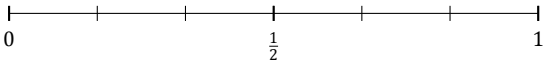

5. $\frac{4}{7} \simeq$

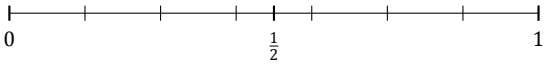

6. $\frac{7}{12} \simeq$

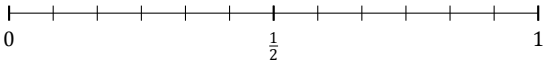

7. $\frac{8}{11} \simeq$

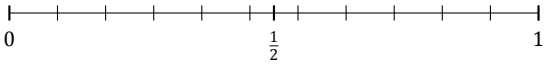

8. $\frac{5}{7} \simeq$

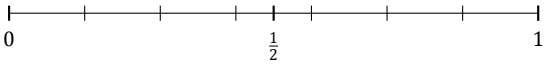

9. $\frac{9}{10} \simeq$

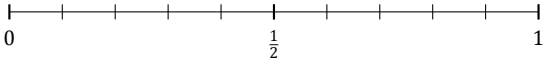

10. $\frac{5}{9} \simeq$

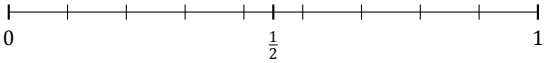

11. $\frac{2}{4} \simeq$

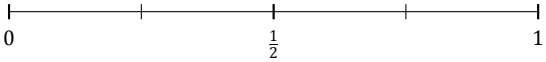

12. $\frac{2}{6} \simeq$

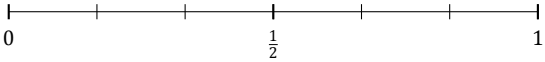

13. $\frac{4}{10} \simeq$

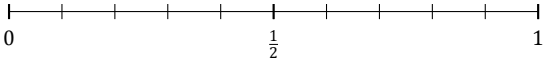

14. $\frac{8}{12} \simeq$

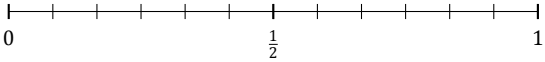

15. $\frac{6}{11} \simeq$

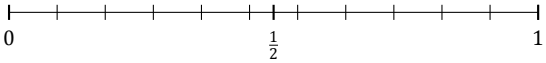

16. $\frac{5}{8} \simeq$

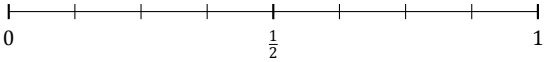

17. $\frac{1}{9} \simeq$

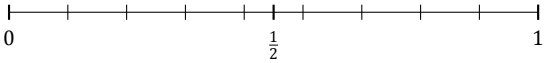

18. $\frac{9}{11} \simeq$

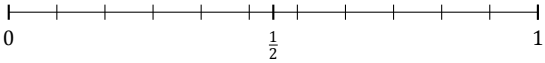

19. $\frac{4}{9} \simeq$

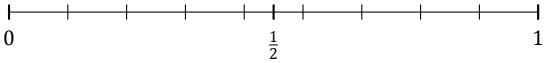

20. $\frac{2}{9} \simeq$

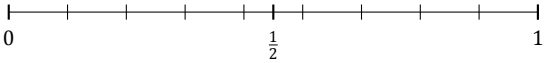

Redondear Fracciones (A) Respuestas

Nombre: _____ Fecha: _____

Redondee cada fracción hasta la mitad más cercana. Redondee por exceso.

1. $\frac{1}{5} \simeq 0$

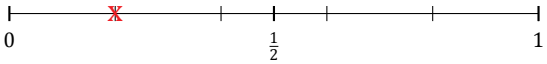

2. $\frac{7}{10} \simeq \frac{1}{2}$

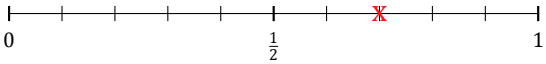

3. $\frac{6}{8} \simeq 1$

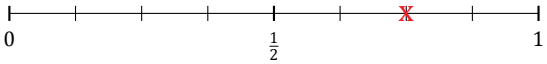

4. $\frac{1}{6} \simeq 0$

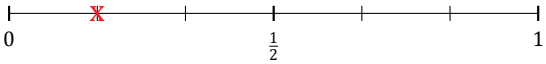

5. $\frac{4}{7} \simeq \frac{1}{2}$

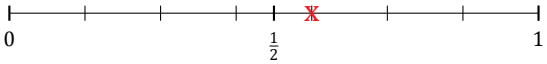

6. $\frac{7}{12} \simeq \frac{1}{2}$

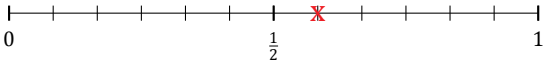

7. $\frac{8}{11} \simeq \frac{1}{2}$

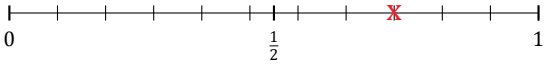

8. $\frac{5}{7} \simeq \frac{1}{2}$

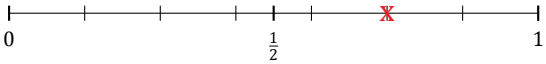

9. $\frac{9}{10} \simeq 1$

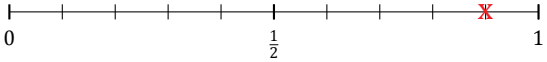

10. $\frac{5}{9} \simeq \frac{1}{2}$

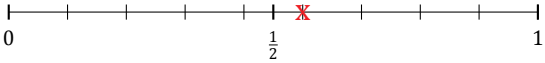

11. $\frac{2}{4} \simeq \frac{1}{2}$

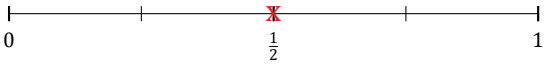

12. $\frac{2}{6} \simeq \frac{1}{2}$

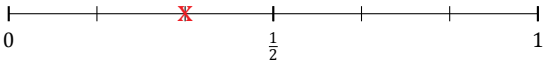

13. $\frac{4}{10} \simeq \frac{1}{2}$

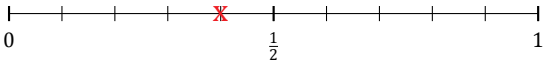

14. $\frac{8}{12} \simeq \frac{1}{2}$

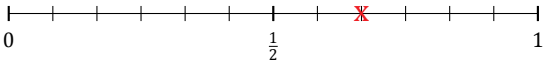

15. $\frac{6}{11} \simeq \frac{1}{2}$

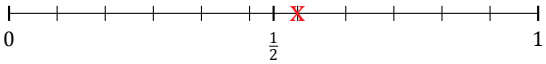

16. $\frac{5}{8} \simeq \frac{1}{2}$

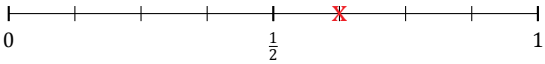

17. $\frac{1}{9} \simeq 0$

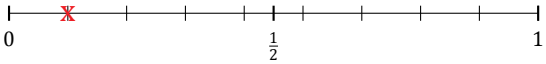

18. $\frac{9}{11} \simeq 1$

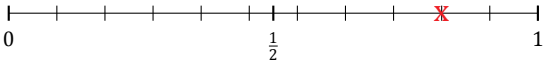

19. $\frac{4}{9} \simeq \frac{1}{2}$

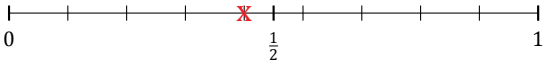

20. $\frac{2}{9} \simeq 0$

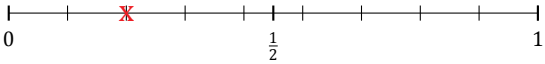

Redondear Fracciones (B)

Nombre: _____ Fecha: _____

Redondee cada fracción hasta la mitad más cercana. Redondee por exceso.

1. $\frac{2}{12} \simeq$

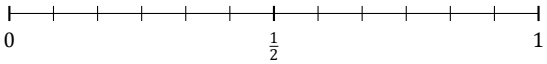

2. $\frac{1}{4} \simeq$

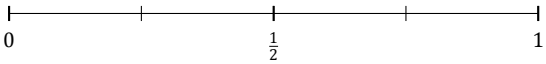

3. $\frac{5}{10} \simeq$

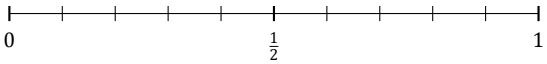

4. $\frac{4}{5} \simeq$

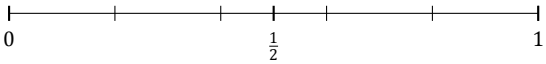

5. $\frac{3}{5} \simeq$

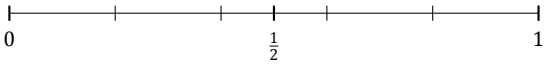

6. $\frac{6}{7} \simeq$

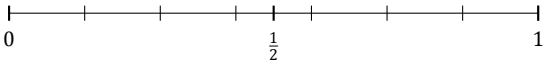

7. $\frac{1}{2} \simeq$

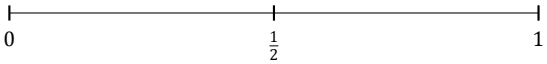

8. $\frac{5}{6} \simeq$

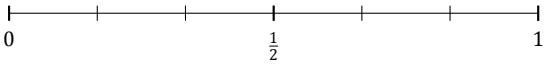

9. $\frac{1}{3} \simeq$

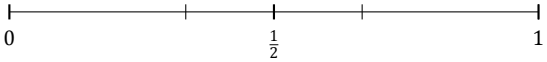

10. $\frac{5}{8} \simeq$

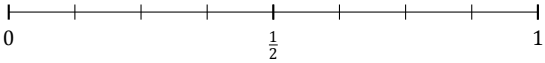

11. $\frac{11}{12} \simeq$

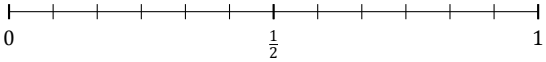

12. $\frac{2}{8} \simeq$

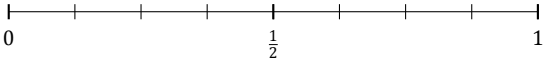

13. $\frac{6}{9} \simeq$

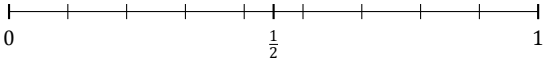

14. $\frac{8}{9} \simeq$

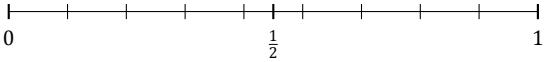

15. $\frac{2}{5} \simeq$

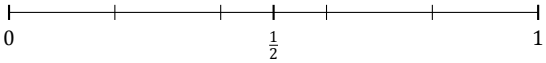

16. $\frac{10}{12} \simeq$

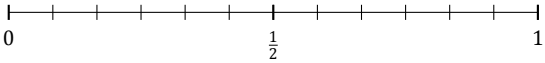

17. $\frac{6}{10} \simeq$

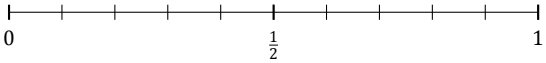

18. $\frac{4}{6} \simeq$

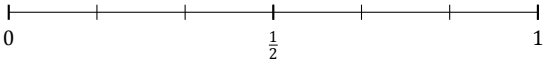

19. $\frac{1}{12} \simeq$

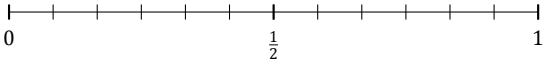

20. $\frac{5}{7} \simeq$

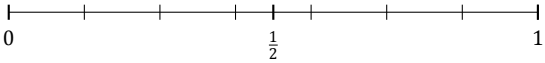

Redondear Fracciones (B) Respuestas

Nombre: _____ Fecha: _____

Redondee cada fracción hasta la mitad más cercana. Redondee por exceso.

1. $\frac{2}{12} \simeq 0$

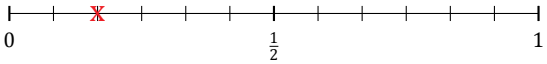

2. $\frac{1}{4} \simeq \frac{1}{2}$

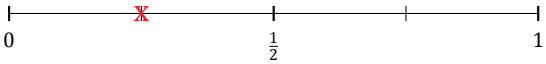

3. $\frac{5}{10} \simeq \frac{1}{2}$

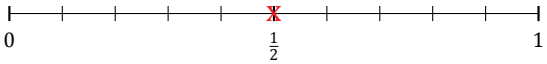

4. $\frac{4}{5} \simeq 1$

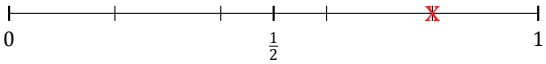

5. $\frac{3}{5} \simeq \frac{1}{2}$

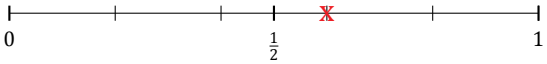

6. $\frac{6}{7} \simeq 1$

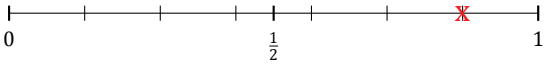

7. $\frac{1}{2} \simeq \frac{1}{2}$

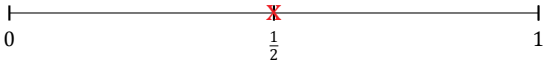

8. $\frac{5}{6} \simeq 1$

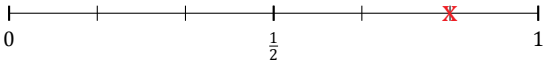

9. $\frac{1}{3} \simeq \frac{1}{2}$

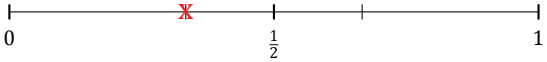

10. $\frac{5}{8} \simeq \frac{1}{2}$

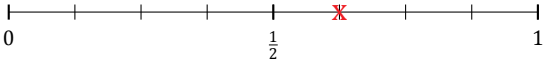

11. $\frac{11}{12} \simeq 1$

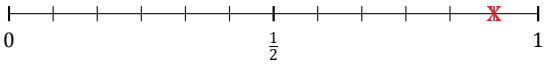

12. $\frac{2}{8} \simeq \frac{1}{2}$

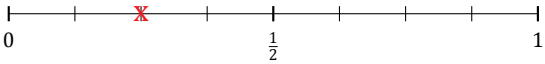

13. $\frac{6}{9} \simeq \frac{1}{2}$

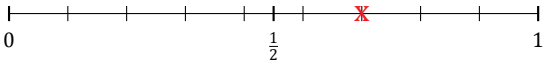

14. $\frac{8}{9} \simeq 1$

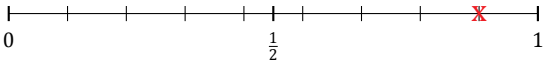

15. $\frac{2}{5} \simeq \frac{1}{2}$

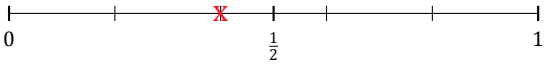

16. $\frac{10}{12} \simeq 1$

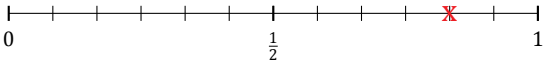

17. $\frac{6}{10} \simeq \frac{1}{2}$

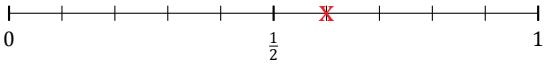

18. $\frac{4}{6} \simeq \frac{1}{2}$

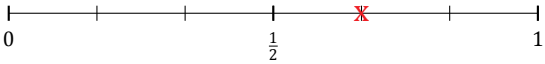

19. $\frac{1}{12} \simeq 0$

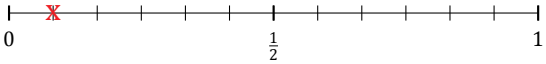

20. $\frac{5}{7} \simeq \frac{1}{2}$

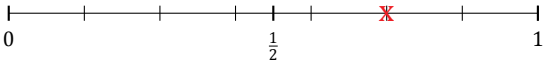

Redondear Fracciones (C)

Nombre: _____ Fecha: _____

Redondee cada fracción hasta la mitad más cercana. Redondee por exceso.

1. $\frac{6}{12} \simeq$

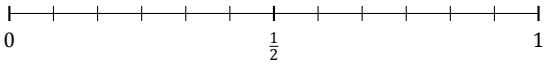

2. $\frac{4}{6} \simeq$

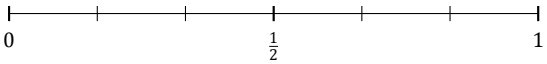

3. $\frac{2}{12} \simeq$

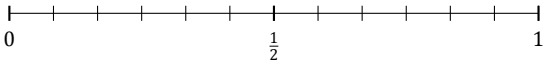

4. $\frac{5}{10} \simeq$

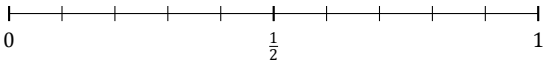

5. $\frac{4}{10} \simeq$

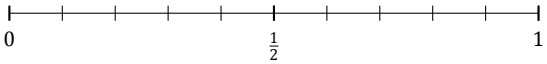

6. $\frac{6}{11} \simeq$

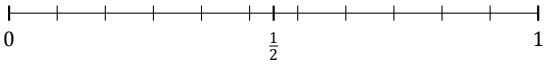

7. $\frac{7}{8} \simeq$

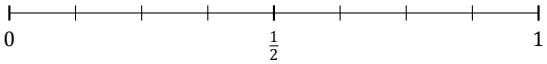

8. $\frac{6}{7} \simeq$

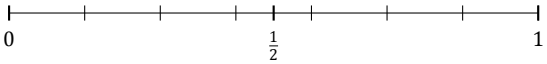

9. $\frac{6}{10} \simeq$

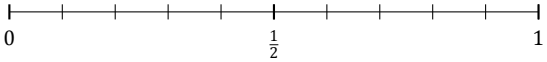

10. $\frac{3}{6} \simeq$

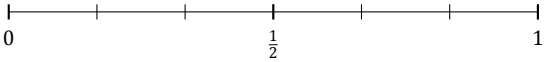

11. $\frac{1}{2} \simeq$

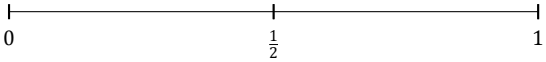

12. $\frac{9}{12} \simeq$

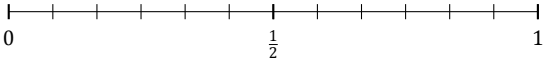

13. $\frac{7}{9} \simeq$

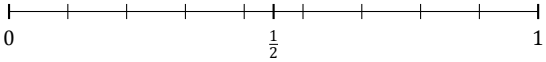

14. $\frac{1}{8} \simeq$

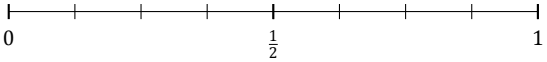

15. $\frac{8}{11} \simeq$

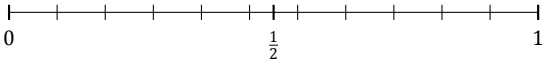

16. $\frac{1}{3} \simeq$

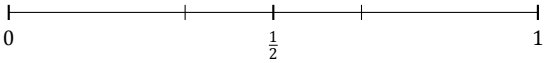

17. $\frac{3}{12} \simeq$

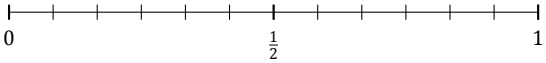

18. $\frac{1}{6} \simeq$

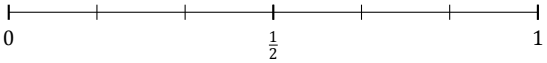

19. $\frac{5}{8} \simeq$

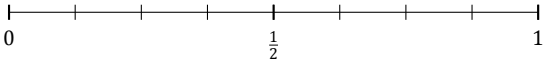

20. $\frac{3}{4} \simeq$

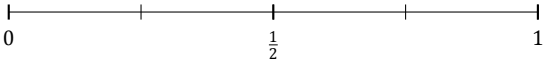

Redondear Fracciones (C) Respuestas

Nombre: _____ Fecha: _____

Redondee cada fracción hasta la mitad más cercana. Redondee por exceso.

1. $\frac{6}{12} \simeq \frac{1}{2}$

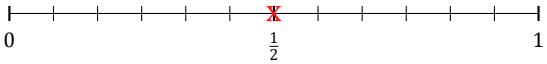

2. $\frac{4}{6} \simeq \frac{1}{2}$

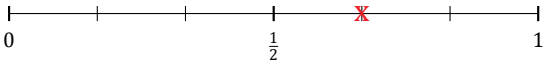

3. $\frac{2}{12} \simeq 0$

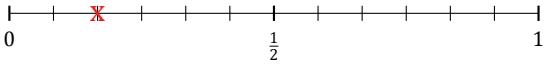

4. $\frac{5}{10} \simeq \frac{1}{2}$

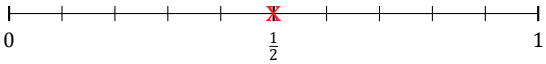

5. $\frac{4}{10} \simeq \frac{1}{2}$

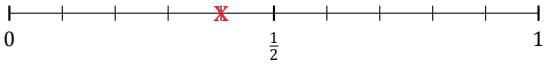

6. $\frac{6}{11} \simeq \frac{1}{2}$

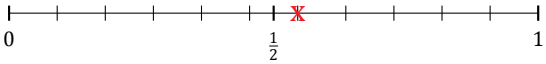

7. $\frac{7}{8} \simeq 1$

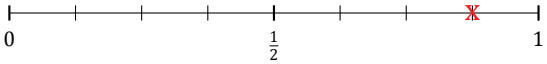

8. $\frac{6}{7} \simeq 1$

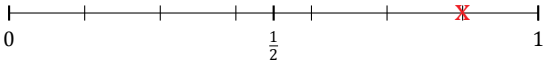

9. $\frac{6}{10} \simeq \frac{1}{2}$

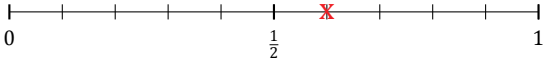

10. $\frac{3}{6} \simeq \frac{1}{2}$

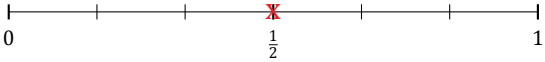

11. $\frac{1}{2} \simeq \frac{1}{2}$

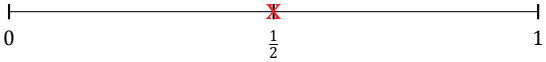

12. $\frac{9}{12} \simeq 1$

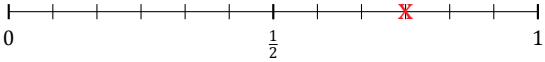

13. $\frac{7}{9} \simeq 1$

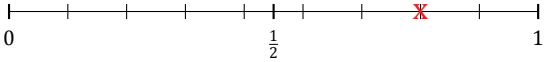

14. $\frac{1}{8} \simeq 0$

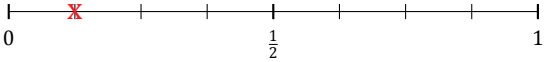

15. $\frac{8}{11} \simeq \frac{1}{2}$

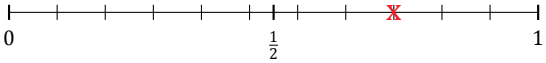

16. $\frac{1}{3} \simeq \frac{1}{2}$

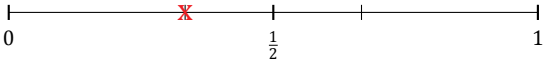

17. $\frac{3}{12} \simeq \frac{1}{2}$

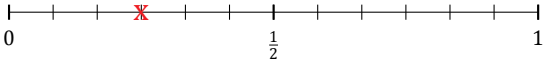

18. $\frac{1}{6} \simeq 0$

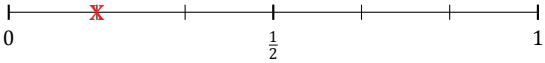

19. $\frac{5}{8} \simeq \frac{1}{2}$

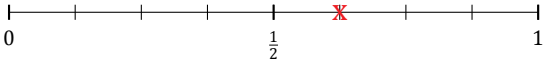

20. $\frac{3}{4} \simeq 1$

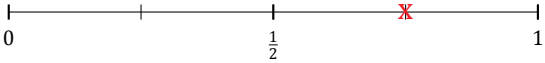

Redondear Fracciones (D)

Nombre: _____ Fecha: _____

Redondee cada fracción hasta la mitad más cercana. Redondee por exceso.

1. $\frac{6}{12} \simeq$

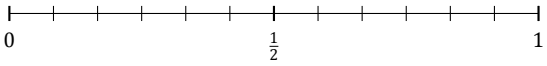

2. $\frac{5}{11} \simeq$

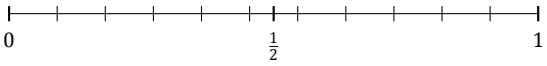

3. $\frac{4}{5} \simeq$

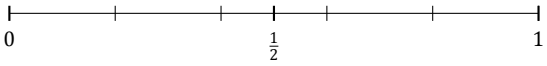

4. $\frac{1}{2} \simeq$

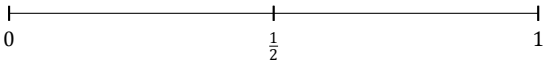

5. $\frac{1}{7} \simeq$

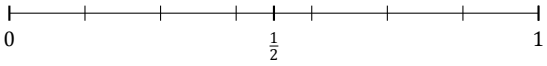

6. $\frac{3}{9} \simeq$

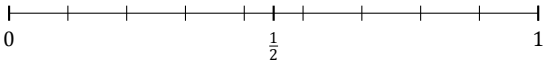

7. $\frac{9}{11} \simeq$

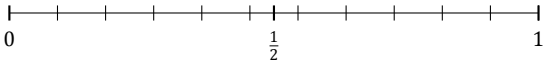

8. $\frac{11}{12} \simeq$

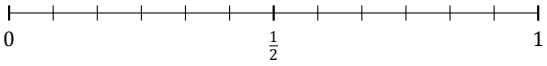

9. $\frac{7}{10} \simeq$

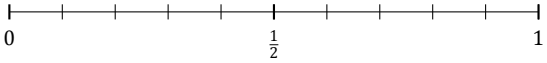

10. $\frac{1}{10} \simeq$

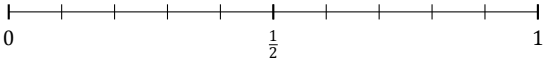

11. $\frac{2}{9} \simeq$

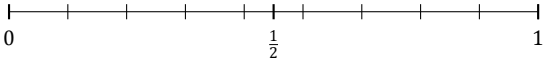

12. $\frac{4}{9} \simeq$

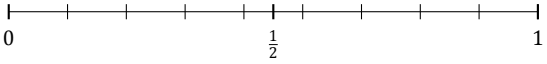

13. $\frac{3}{5} \simeq$

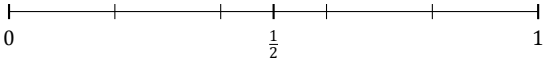

14. $\frac{2}{7} \simeq$

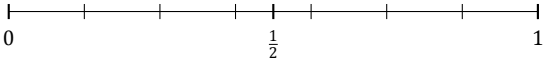

15. $\frac{5}{6} \simeq$

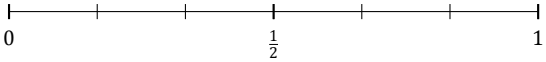

16. $\frac{1}{5} \simeq$

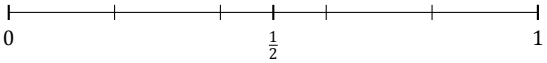

17. $\frac{5}{10} \simeq$

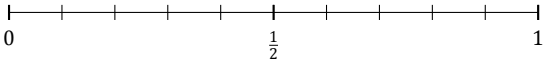

18. $\frac{5}{9} \simeq$

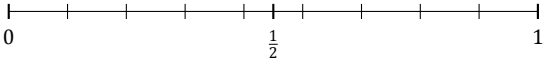

19. $\frac{3}{12} \simeq$

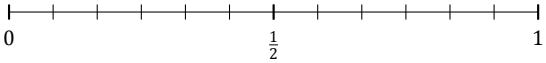

20. $\frac{9}{10} \simeq$

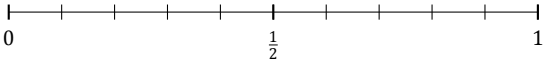

Redondear Fracciones (D) Respuestas

Nombre: _____ Fecha: _____

Redondee cada fracción hasta la mitad más cercana. Redondee por exceso.

1. $\frac{6}{12} \simeq \frac{1}{2}$

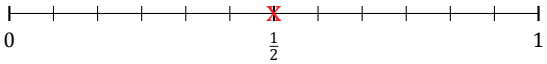

2. $\frac{5}{11} \simeq \frac{1}{2}$

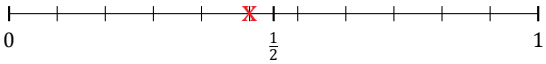

3. $\frac{4}{5} \simeq 1$

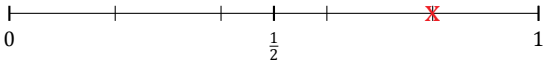

4. $\frac{1}{2} \simeq \frac{1}{2}$

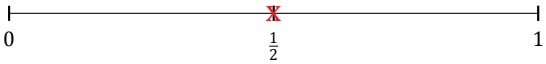

5. $\frac{1}{7} \simeq 0$

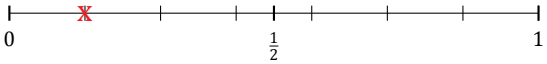

6. $\frac{3}{9} \simeq \frac{1}{2}$

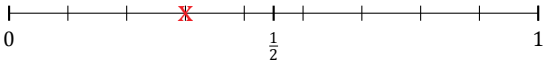

7. $\frac{9}{11} \simeq 1$

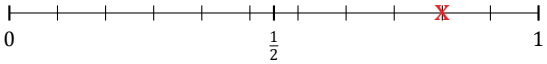

8. $\frac{11}{12} \simeq 1$

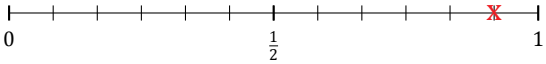

9. $\frac{7}{10} \simeq \frac{1}{2}$

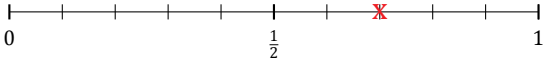

10. $\frac{1}{10} \simeq 0$

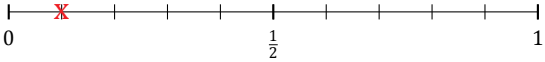

11. $\frac{2}{9} \simeq 0$

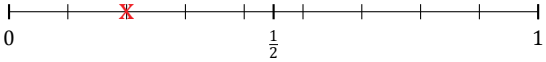

12. $\frac{4}{9} \simeq \frac{1}{2}$

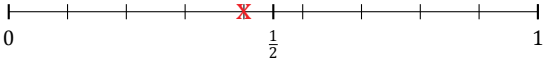

13. $\frac{3}{5} \simeq \frac{1}{2}$

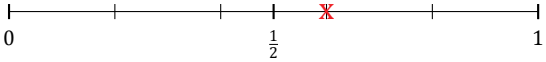

14. $\frac{2}{7} \simeq \frac{1}{2}$

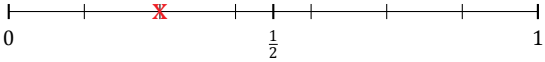

15. $\frac{5}{6} \simeq 1$

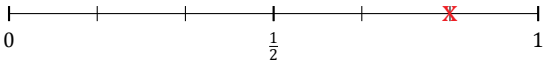

16. $\frac{1}{5} \simeq 0$

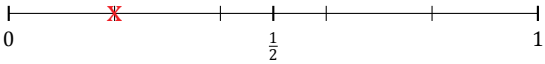

17. $\frac{5}{10} \simeq \frac{1}{2}$

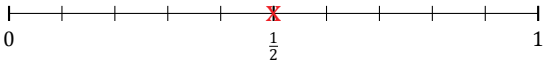

18. $\frac{5}{9} \simeq \frac{1}{2}$

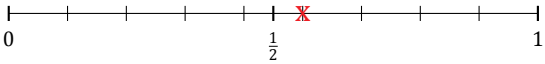

19. $\frac{3}{12} \simeq \frac{1}{2}$

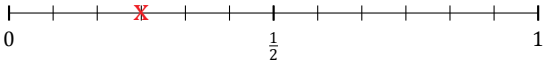

20. $\frac{9}{10} \simeq 1$

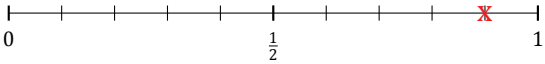

Redondear Fracciones (E)

Nombre: _____ Fecha: _____

Redondee cada fracción hasta la mitad más cercana. Redondee por exceso.

1. $\frac{2}{11} \simeq$

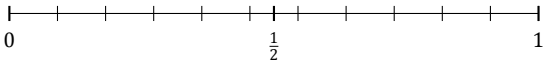

2. $\frac{1}{8} \simeq$

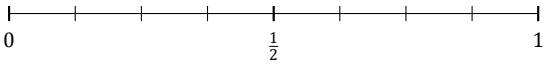

3. $\frac{4}{11} \simeq$

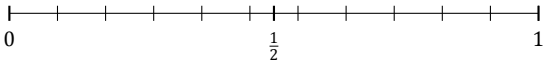

4. $\frac{3}{11} \simeq$

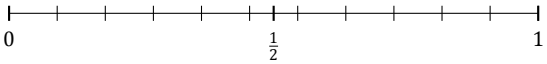

5. $\frac{6}{9} \simeq$

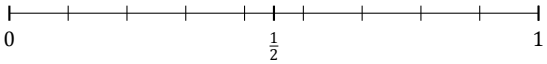

6. $\frac{2}{3} \simeq$

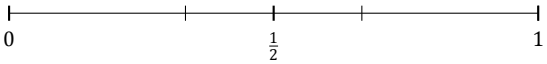

7. $\frac{1}{7} \simeq$

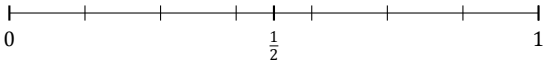

8. $\frac{7}{11} \simeq$

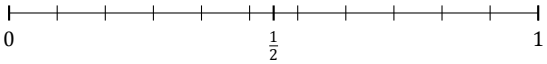

9. $\frac{4}{8} \simeq$

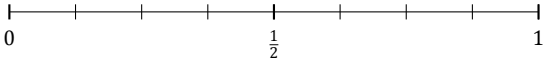

10. $\frac{7}{9} \simeq$

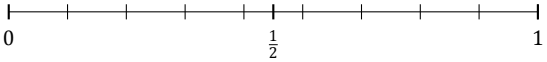

11. $\frac{4}{10} \simeq$

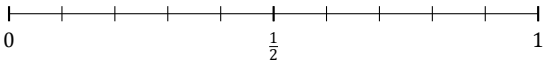

12. $\frac{4}{9} \simeq$

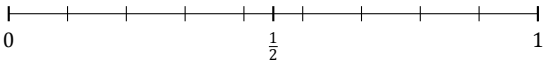

13. $\frac{1}{2} \simeq$

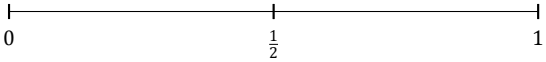

14. $\frac{10}{12} \simeq$

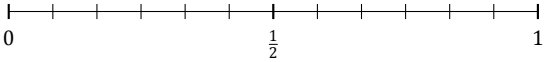

15. $\frac{2}{4} \simeq$

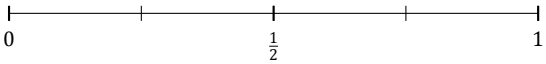

16. $\frac{11}{12} \simeq$

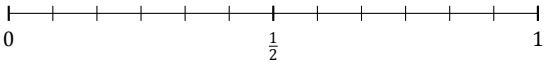

17. $\frac{9}{10} \simeq$

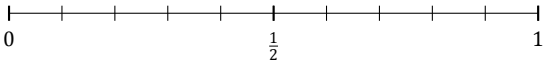

18. $\frac{3}{6} \simeq$

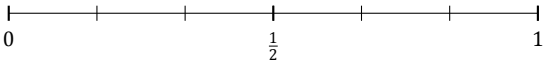

19. $\frac{1}{3} \simeq$

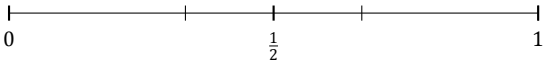

20. $\frac{1}{10} \simeq$

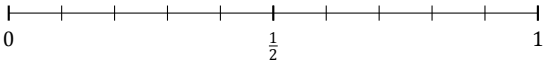

Redondear Fracciones (E) Respuestas

Nombre: _____ Fecha: _____

Redondee cada fracción hasta la mitad más cercana. Redondee por exceso.

1. $\frac{2}{11} \simeq 0$

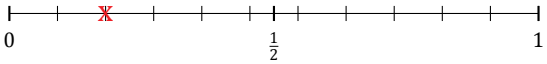

2. $\frac{1}{8} \simeq 0$

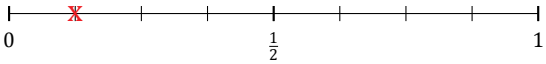

3. $\frac{4}{11} \simeq \frac{1}{2}$

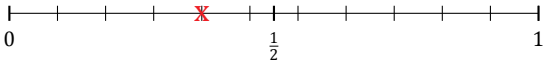

4. $\frac{3}{11} \simeq \frac{1}{2}$

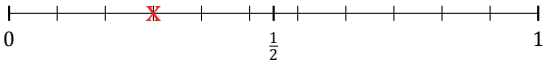

5. $\frac{6}{9} \simeq \frac{1}{2}$

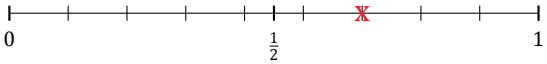

6. $\frac{2}{3} \simeq \frac{1}{2}$

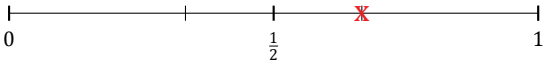

7. $\frac{1}{7} \simeq 0$

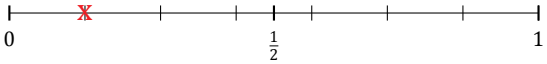

8. $\frac{7}{11} \simeq \frac{1}{2}$

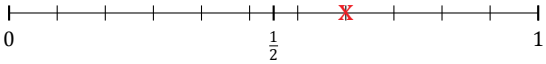

9. $\frac{4}{8} \simeq \frac{1}{2}$

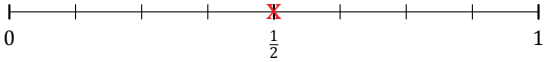

10. $\frac{7}{9} \simeq 1$

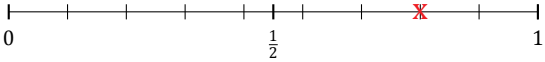

11. $\frac{4}{10} \simeq \frac{1}{2}$

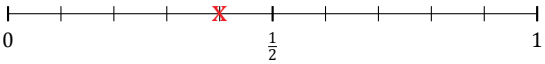

12. $\frac{4}{9} \simeq \frac{1}{2}$

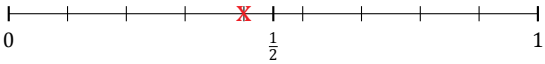

13. $\frac{1}{2} \simeq \frac{1}{2}$

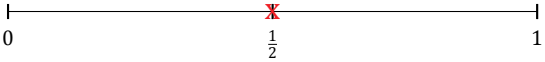

14. $\frac{10}{12} \simeq 1$

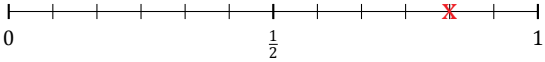

15. $\frac{2}{4} \simeq \frac{1}{2}$

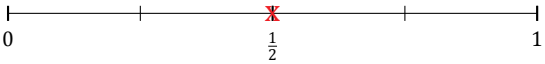

16. $\frac{11}{12} \simeq 1$

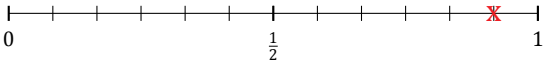

17. $\frac{9}{10} \simeq 1$

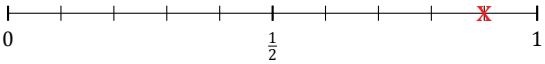

18. $\frac{3}{6} \simeq \frac{1}{2}$

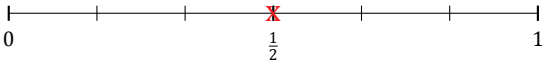

19. $\frac{1}{3} \simeq \frac{1}{2}$

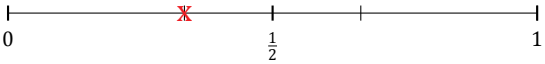

20. $\frac{1}{10} \simeq 0$

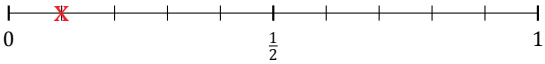

Redondear Fracciones (F)

Nombre: _____ Fecha: _____

Redondee cada fracción hasta la mitad más cercana. Redondee por exceso.

1. $\frac{4}{5} \simeq$

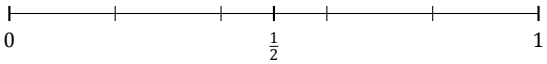

2. $\frac{3}{4} \simeq$

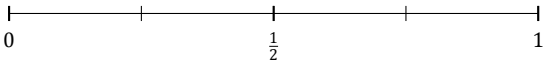

3. $\frac{7}{8} \simeq$

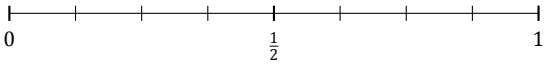

4. $\frac{9}{10} \simeq$

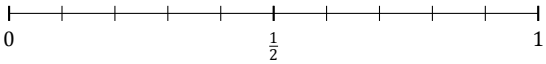

5. $\frac{6}{7} \simeq$

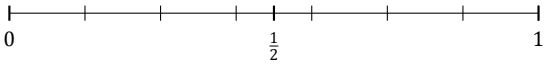

6. $\frac{8}{12} \simeq$

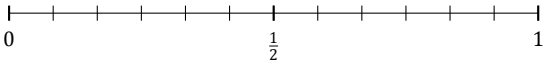

7. $\frac{1}{3} \simeq$

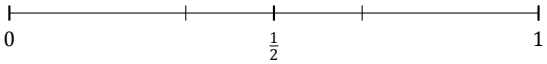

8. $\frac{1}{6} \simeq$

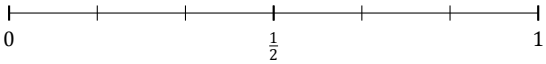

9. $\frac{1}{8} \simeq$

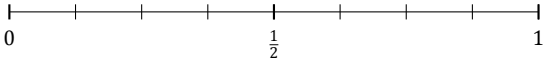

10. $\frac{8}{9} \simeq$

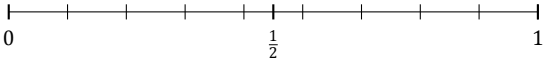

11. $\frac{5}{8} \simeq$

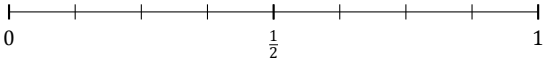

12. $\frac{3}{10} \simeq$

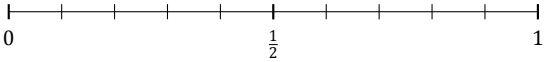

13. $\frac{5}{11} \simeq$

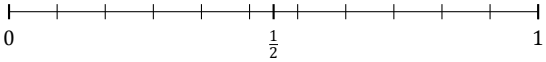

14. $\frac{9}{12} \simeq$

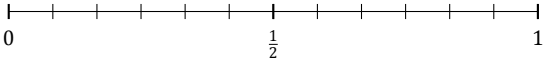

15. $\frac{6}{10} \simeq$

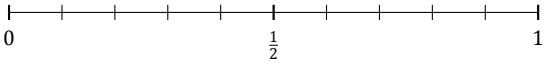

16. $\frac{4}{11} \simeq$

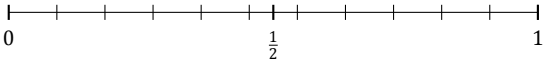

17. $\frac{3}{5} \simeq$

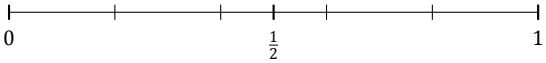

18. $\frac{11}{12} \simeq$

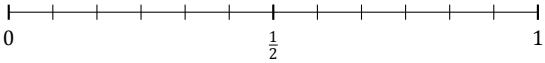

19. $\frac{2}{8} \simeq$

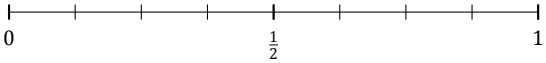

20. $\frac{6}{9} \simeq$

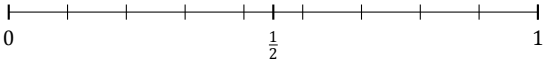

Redondear Fracciones (F) Respuestas

Nombre: _____ Fecha: _____

Redondee cada fracción hasta la mitad más cercana. Redondee por exceso.

1. $\frac{4}{5} \simeq 1$

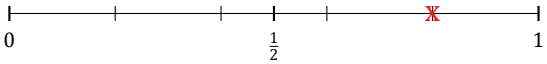

2. $\frac{3}{4} \simeq 1$

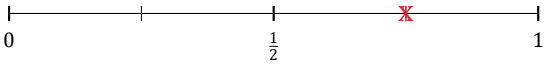

3. $\frac{7}{8} \simeq 1$

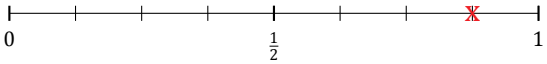

4. $\frac{9}{10} \simeq 1$

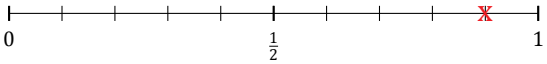

5. $\frac{6}{7} \simeq 1$

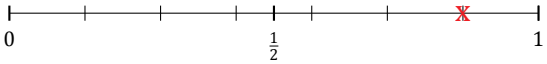

6. $\frac{8}{12} \simeq \frac{1}{2}$

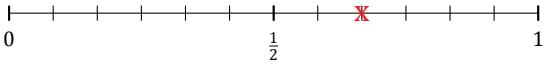

7. $\frac{1}{3} \simeq \frac{1}{2}$

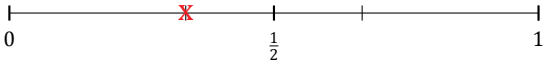

8. $\frac{1}{6} \simeq 0$

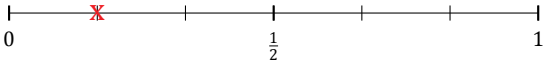

9. $\frac{1}{8} \simeq 0$

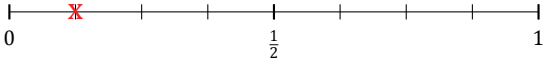

10. $\frac{8}{9} \simeq 1$

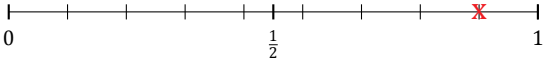

11. $\frac{5}{8} \simeq \frac{1}{2}$

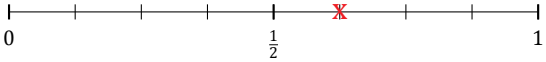

12. $\frac{3}{10} \simeq \frac{1}{2}$

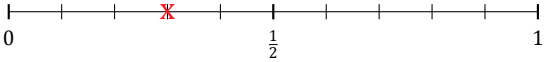

13. $\frac{5}{11} \simeq \frac{1}{2}$

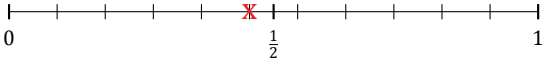

14. $\frac{9}{12} \simeq 1$

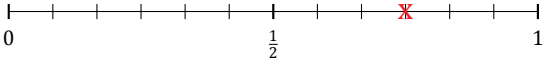

15. $\frac{6}{10} \simeq \frac{1}{2}$

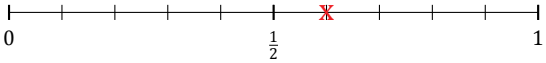

16. $\frac{4}{11} \simeq \frac{1}{2}$

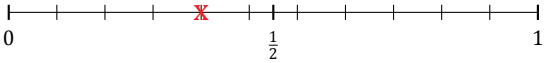

17. $\frac{3}{5} \simeq \frac{1}{2}$

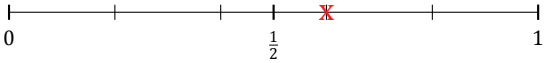

18. $\frac{11}{12} \simeq 1$

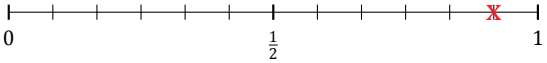

19. $\frac{2}{8} \simeq \frac{1}{2}$

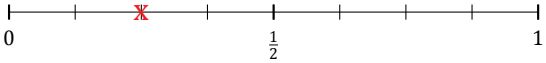

20. $\frac{6}{9} \simeq \frac{1}{2}$

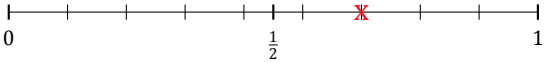

Redondear Fracciones (G)

Nombre: _____ Fecha: _____

Redondee cada fracción hasta la mitad más cercana. Redondee por exceso.

1. $\frac{7}{8} \simeq$

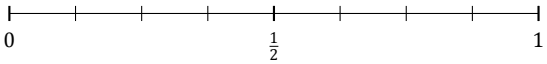

2. $\frac{2}{12} \simeq$

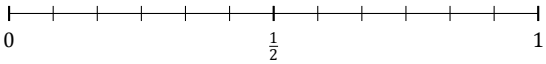

3. $\frac{6}{11} \simeq$

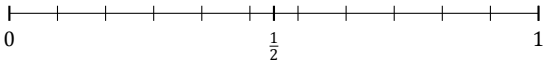

4. $\frac{11}{12} \simeq$

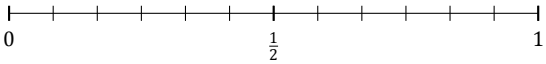

5. $\frac{7}{11} \simeq$

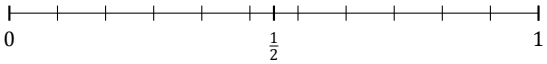

6. $\frac{2}{7} \simeq$

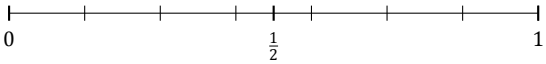

7. $\frac{1}{3} \simeq$

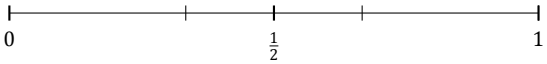

8. $\frac{9}{12} \simeq$

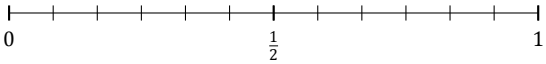

9. $\frac{2}{6} \simeq$

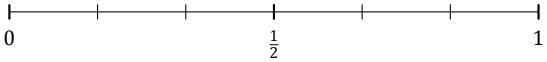

10. $\frac{5}{12} \simeq$

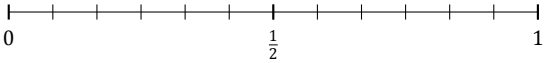

11. $\frac{2}{8} \simeq$

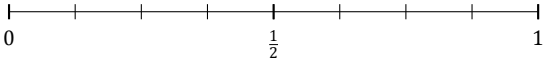

12. $\frac{1}{6} \simeq$

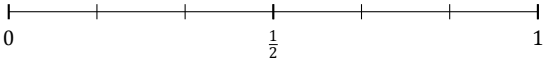

13. $\frac{6}{9} \simeq$

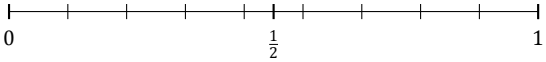

14. $\frac{1}{5} \simeq$

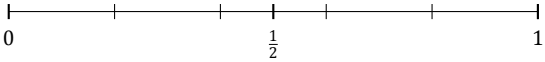

15. $\frac{2}{4} \simeq$

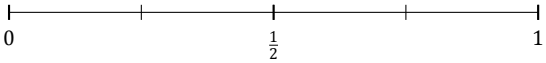

16. $\frac{8}{10} \simeq$

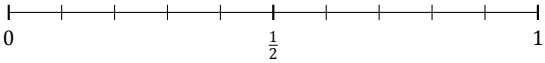

17. $\frac{6}{10} \simeq$

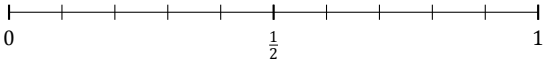

18. $\frac{7}{12} \simeq$

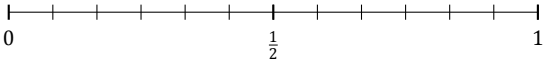

19. $\frac{1}{10} \simeq$

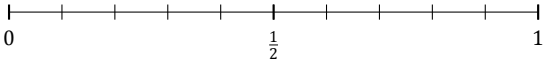

20. $\frac{6}{12} \simeq$

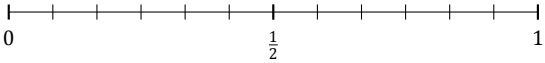

Redondear Fracciones (G) Respuestas

Nombre: _____ Fecha: _____

Redondee cada fracción hasta la mitad más cercana. Redondee por exceso.

1. $\frac{7}{8} \simeq 1$

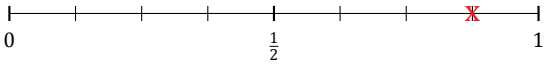

2. $\frac{2}{12} \simeq 0$

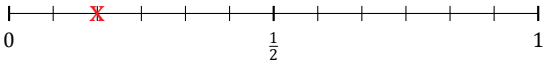

3. $\frac{6}{11} \simeq \frac{1}{2}$

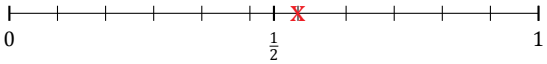

4. $\frac{11}{12} \simeq 1$

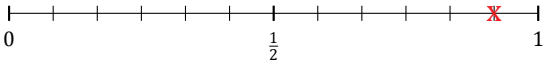

5. $\frac{7}{11} \simeq \frac{1}{2}$

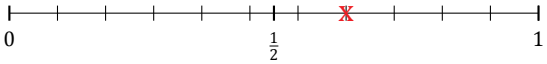

6. $\frac{2}{7} \simeq \frac{1}{2}$

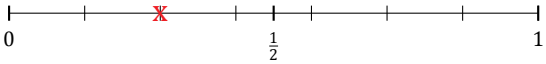

7. $\frac{1}{3} \simeq \frac{1}{2}$

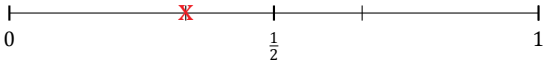

8. $\frac{9}{12} \simeq 1$

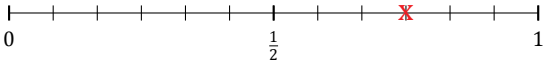

9. $\frac{2}{6} \simeq \frac{1}{2}$

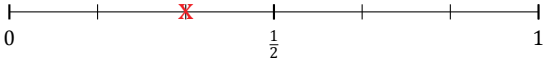

10. $\frac{5}{12} \simeq \frac{1}{2}$

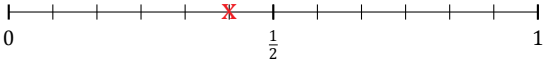

11. $\frac{2}{8} \simeq \frac{1}{2}$

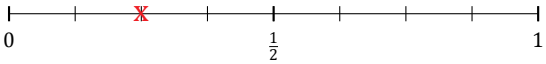

12. $\frac{1}{6} \simeq 0$

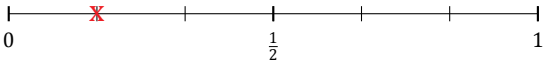

13. $\frac{6}{9} \simeq \frac{1}{2}$

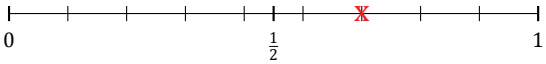

14. $\frac{1}{5} \simeq 0$

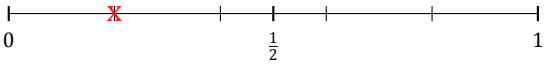

15. $\frac{2}{4} \simeq \frac{1}{2}$

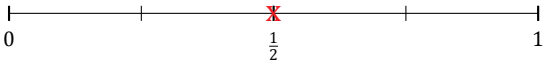

16. $\frac{8}{10} \simeq 1$

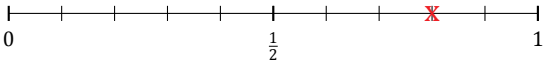

17. $\frac{6}{10} \simeq \frac{1}{2}$

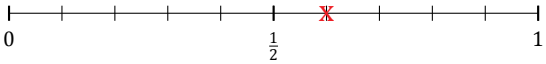

18. $\frac{7}{12} \simeq \frac{1}{2}$

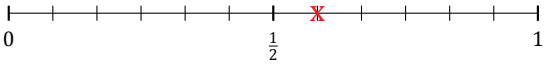

19. $\frac{1}{10} \simeq 0$

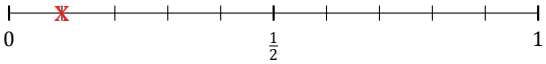

20. $\frac{6}{12} \simeq \frac{1}{2}$

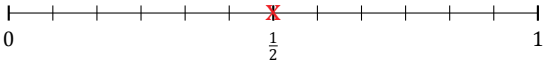

Redondear Fracciones (H)

Nombre: _____ Fecha: _____

Redondee cada fracción hasta la mitad más cercana. Redondee por exceso.

1. $\frac{5}{12} \simeq$

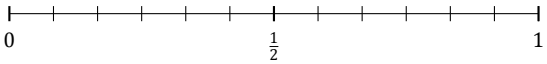

2. $\frac{3}{10} \simeq$

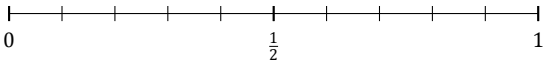

3. $\frac{3}{9} \simeq$

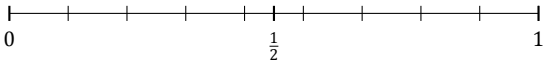

4. $\frac{3}{4} \simeq$

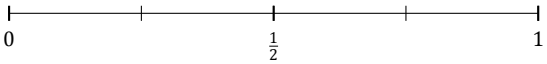

5. $\frac{3}{7} \simeq$

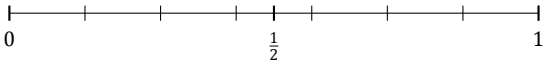

6. $\frac{9}{11} \simeq$

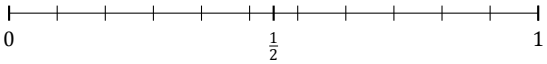

7. $\frac{4}{10} \simeq$

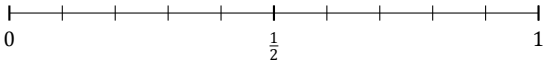

8. $\frac{4}{9} \simeq$

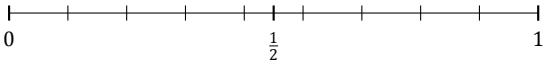

9. $\frac{2}{10} \simeq$

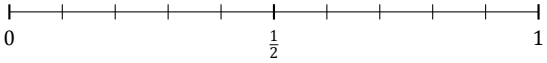

10. $\frac{4}{8} \simeq$

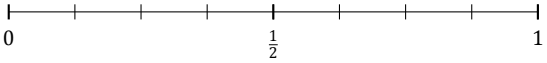

11. $\frac{11}{12} \simeq$

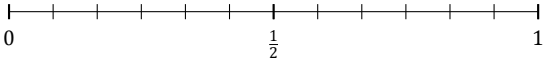

12. $\frac{2}{12} \simeq$

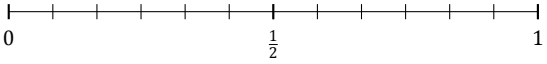

13. $\frac{5}{11} \simeq$

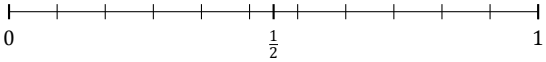

14. $\frac{5}{10} \simeq$

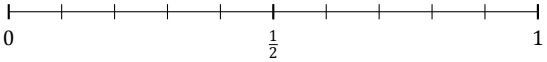

15. $\frac{4}{7} \simeq$

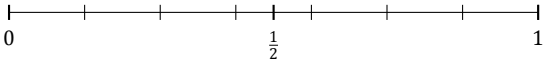

16. $\frac{2}{8} \simeq$

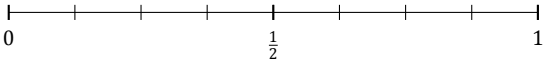

17. $\frac{4}{5} \simeq$

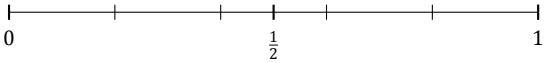

18. $\frac{5}{7} \simeq$

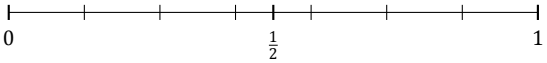

19. $\frac{2}{5} \simeq$

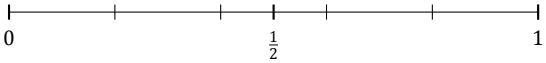

20. $\frac{1}{3} \simeq$

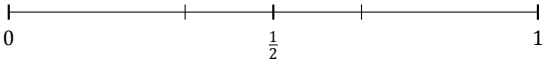

Redondear Fracciones (H) Respuestas

Nombre: _____ Fecha: _____

Redondee cada fracción hasta la mitad más cercana. Redondee por exceso.

1. $\frac{5}{12} \simeq \frac{1}{2}$

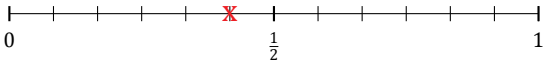

2. $\frac{3}{10} \simeq \frac{1}{2}$

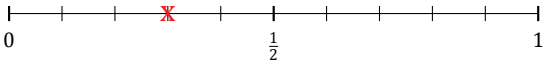

3. $\frac{3}{9} \simeq \frac{1}{2}$

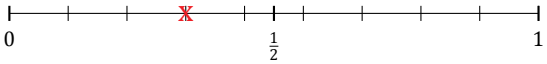

4. $\frac{3}{4} \simeq 1$

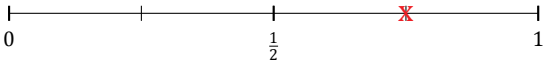

5. $\frac{3}{7} \simeq \frac{1}{2}$

6. $\frac{9}{11} \simeq 1$

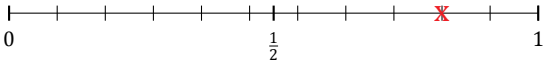

7. $\frac{4}{10} \simeq \frac{1}{2}$

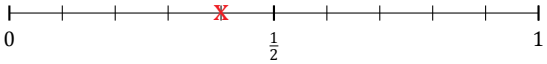

8. $\frac{4}{9} \simeq \frac{1}{2}$

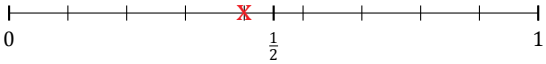

9. $\frac{2}{10} \simeq 0$

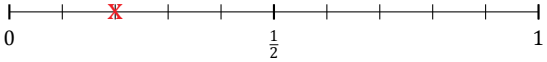

10. $\frac{4}{8} \simeq \frac{1}{2}$

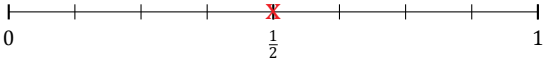

11. $\frac{11}{12} \simeq 1$

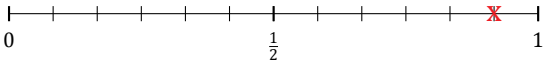

12. $\frac{2}{12} \simeq 0$

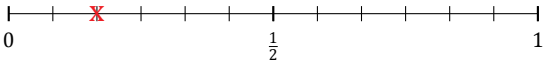

13. $\frac{5}{11} \simeq \frac{1}{2}$

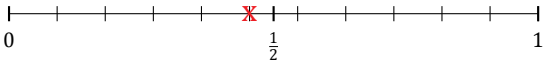

14. $\frac{5}{10} \simeq \frac{1}{2}$

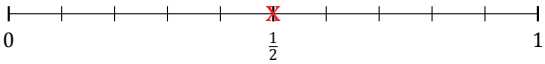

15. $\frac{4}{7} \simeq \frac{1}{2}$

16. $\frac{2}{8} \simeq \frac{1}{2}$

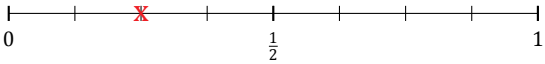

17. $\frac{4}{5} \simeq 1$

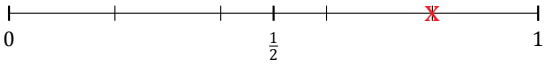

18. $\frac{5}{7} \simeq \frac{1}{2}$

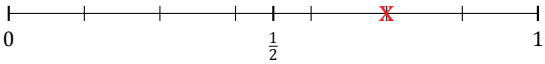

19. $\frac{2}{5} \simeq \frac{1}{2}$

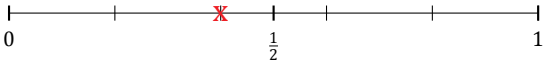

20. $\frac{1}{3} \simeq \frac{1}{2}$

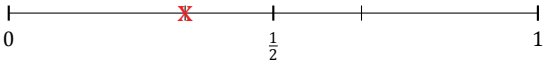

Redondear Fracciones (I)

Nombre: _____ Fecha: _____

Redondee cada fracción hasta la mitad más cercana. Redondee por exceso.

1. $\frac{2}{9} \simeq$

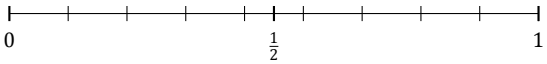

2. $\frac{2}{6} \simeq$

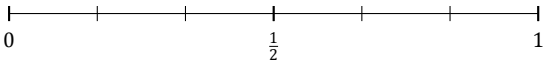

3. $\frac{4}{7} \simeq$

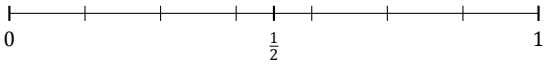

4. $\frac{3}{6} \simeq$

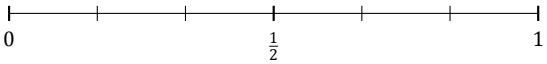

5. $\frac{1}{2} \simeq$

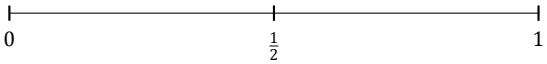

6. $\frac{5}{8} \simeq$

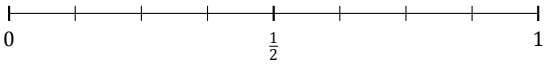

7. $\frac{1}{3} \simeq$

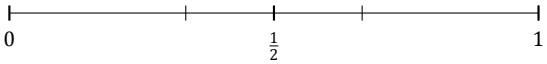

8. $\frac{6}{9} \simeq$

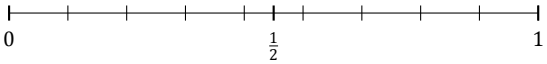

9. $\frac{2}{11} \simeq$

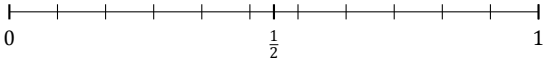

10. $\frac{1}{8} \simeq$

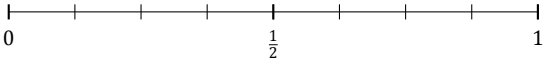

11. $\frac{4}{9} \simeq$

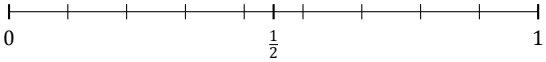

12. $\frac{3}{9} \simeq$

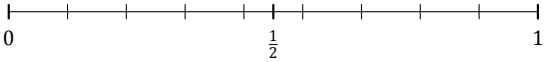

13. $\frac{8}{11} \simeq$

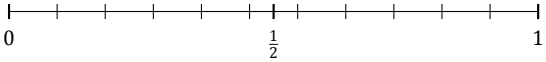

14. $\frac{2}{7} \simeq$

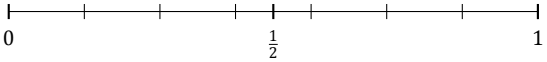

15. $\frac{5}{12} \simeq$

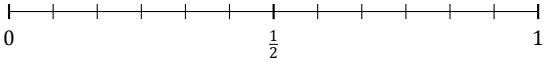

16. $\frac{5}{10} \simeq$

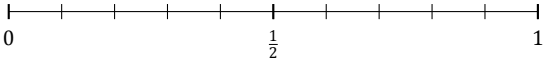

17. $\frac{7}{11} \simeq$

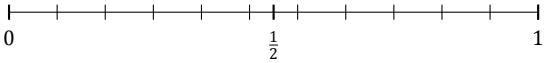

18. $\frac{2}{8} \simeq$

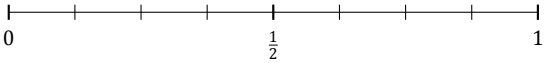

19. $\frac{10}{11} \simeq$

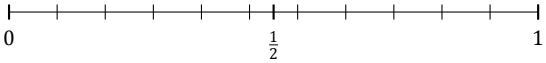

20. $\frac{7}{9} \simeq$

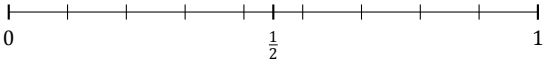

Redondear Fracciones (I) Respuestas

Nombre: _____ Fecha: _____

Redondee cada fracción hasta la mitad más cercana. Redondee por exceso.

1. $\frac{2}{9} \simeq 0$

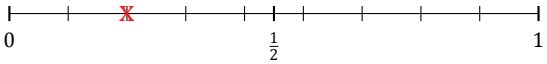

2. $\frac{2}{6} \simeq \frac{1}{2}$

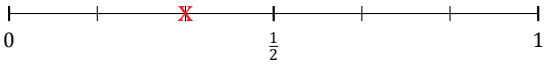

3. $\frac{4}{7} \simeq \frac{1}{2}$

4. $\frac{3}{6} \simeq \frac{1}{2}$

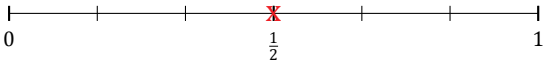

5. $\frac{1}{2} \simeq \frac{1}{2}$

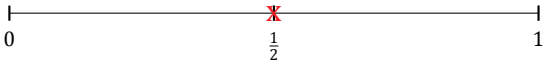

6. $\frac{5}{8} \simeq \frac{1}{2}$

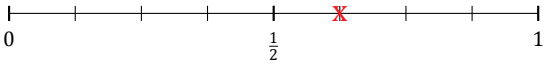

7. $\frac{1}{3} \simeq \frac{1}{2}$

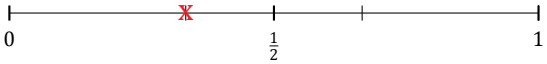

8. $\frac{6}{9} \simeq \frac{1}{2}$

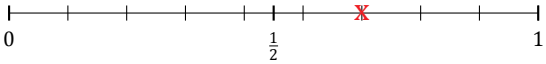

9. $\frac{2}{11} \simeq 0$

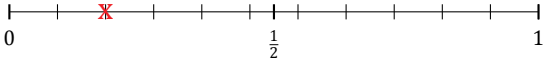

10. $\frac{1}{8} \simeq 0$

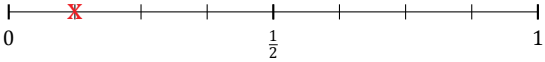

11. $\frac{4}{9} \simeq \frac{1}{2}$

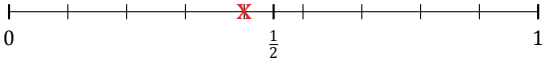

12. $\frac{3}{9} \simeq \frac{1}{2}$

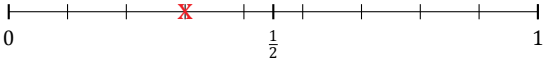

13. $\frac{8}{11} \simeq \frac{1}{2}$

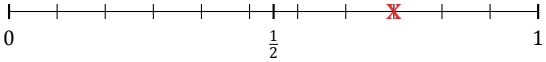

14. $\frac{2}{7} \simeq \frac{1}{2}$

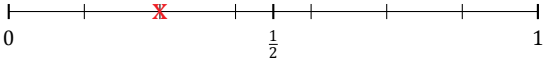

15. $\frac{5}{12} \simeq \frac{1}{2}$

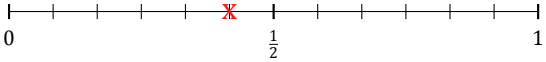

16. $\frac{5}{10} \simeq \frac{1}{2}$

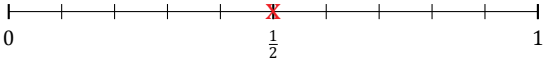

17. $\frac{7}{11} \simeq \frac{1}{2}$

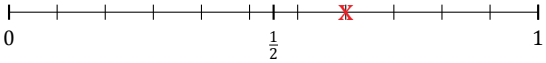

18. $\frac{2}{8} \simeq \frac{1}{2}$

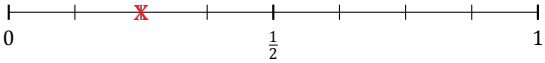

19. $\frac{10}{11} \simeq 1$

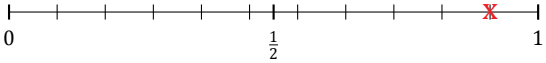

20. $\frac{7}{9} \simeq 1$

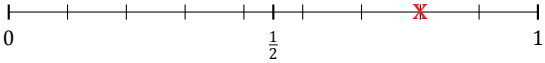

Redondear Fracciones (J)

Nombre: _____ Fecha: _____

Redondee cada fracción hasta la mitad más cercana. Redondee por exceso.

1. $\frac{7}{9} \simeq$

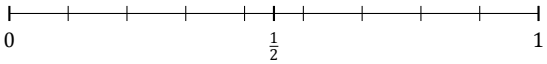

2. $\frac{5}{10} \simeq$

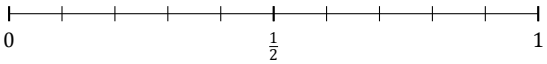

3. $\frac{1}{9} \simeq$

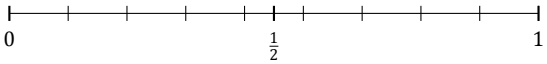

4. $\frac{3}{7} \simeq$

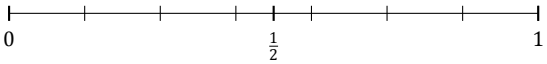

5. $\frac{8}{11} \simeq$

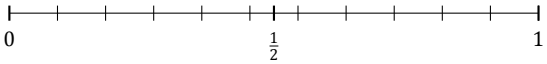

6. $\frac{8}{9} \simeq$

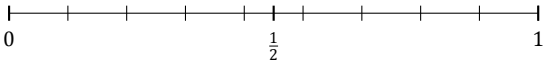

7. $\frac{2}{3} \simeq$

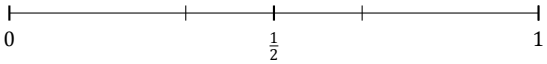

8. $\frac{2}{7} \simeq$

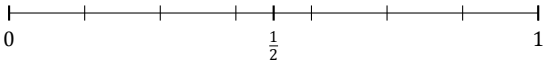

9. $\frac{8}{10} \simeq$

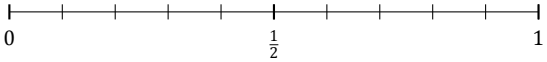

10. $\frac{4}{9} \simeq$

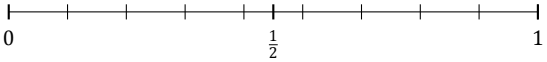

11. $\frac{2}{10} \simeq$

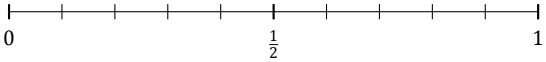

12. $\frac{5}{11} \simeq$

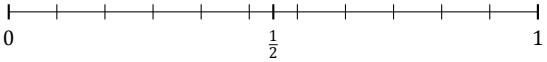

13. $\frac{6}{11} \simeq$

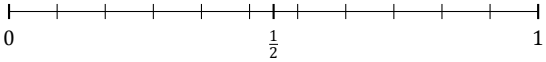

14. $\frac{3}{4} \simeq$

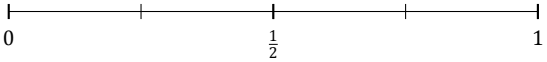

15. $\frac{10}{12} \simeq$

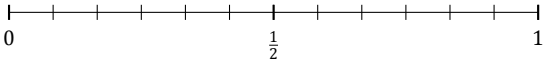

16. $\frac{2}{12} \simeq$

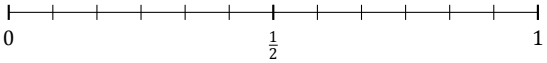

17. $\frac{2}{9} \simeq$

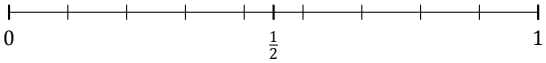

18. $\frac{3}{12} \simeq$

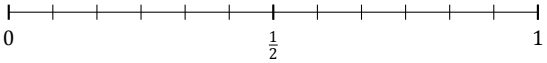

19. $\frac{3}{6} \simeq$

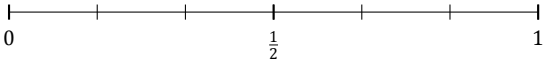

20. $\frac{1}{10} \simeq$

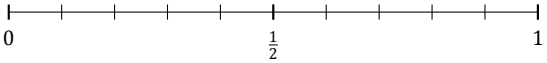

Redondear Fracciones (J) Respuestas

Nombre: _____ Fecha: _____

Redondee cada fracción hasta la mitad más cercana. Redondee por exceso.

1. $\frac{7}{9} \simeq 1$

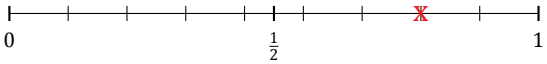

2. $\frac{5}{10} \simeq \frac{1}{2}$

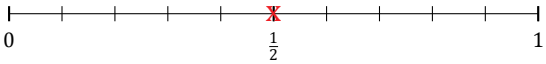

3. $\frac{1}{9} \simeq 0$

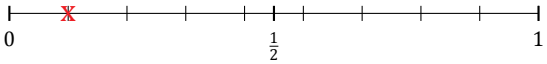

4. $\frac{3}{7} \simeq \frac{1}{2}$

5. $\frac{8}{11} \simeq \frac{1}{2}$

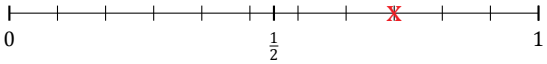

6. $\frac{8}{9} \simeq 1$

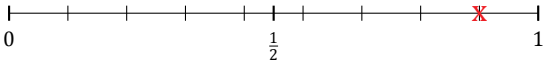

7. $\frac{2}{3} \simeq \frac{1}{2}$

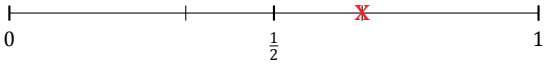

8. $\frac{2}{7} \simeq \frac{1}{2}$

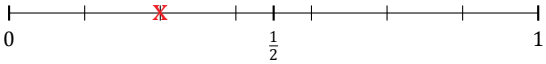

9. $\frac{8}{10} \simeq 1$

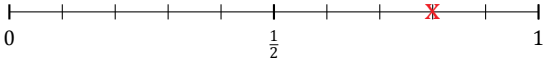

10. $\frac{4}{9} \simeq \frac{1}{2}$

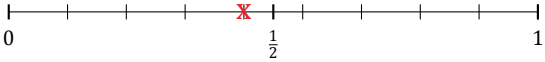

11. $\frac{2}{10} \simeq 0$

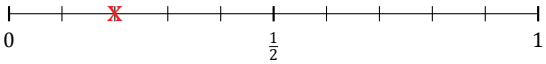

12. $\frac{5}{11} \simeq \frac{1}{2}$

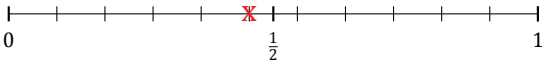

13. $\frac{6}{11} \simeq \frac{1}{2}$

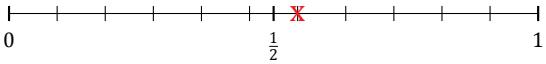

14. $\frac{3}{4} \simeq 1$

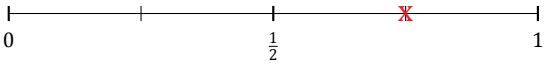

15. $\frac{10}{12} \simeq 1$

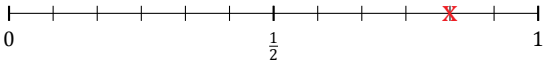

16. $\frac{2}{12} \simeq 0$

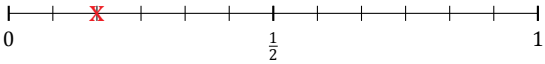

17. $\frac{2}{9} \simeq 0$

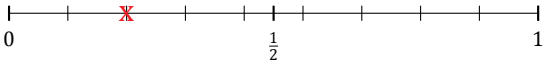

18. $\frac{3}{12} \simeq \frac{1}{2}$

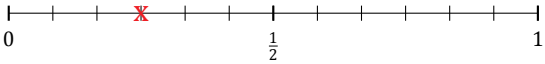

19. $\frac{3}{6} \simeq \frac{1}{2}$

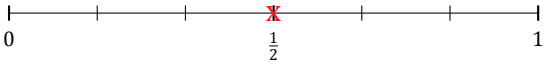
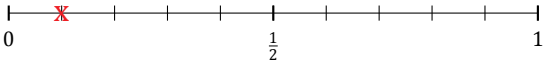
20. $\frac{1}{10} \simeq 0$