Ordenar Fracciones (A)

Ordene cada conjunto de fracciones usando la recta numérica.

$\frac{4}{5},\ 1\frac{1}{2},\ 1\frac{1}{5},\ \frac{1}{2},\ \frac{1}{5}$

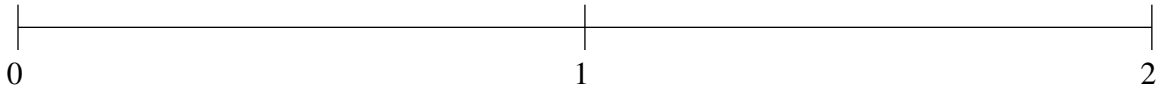

$1\frac{1}{2},\ \frac{9}{10},\ \frac{1}{5},\ 1\frac{4}{5},\ \frac{1}{2}$

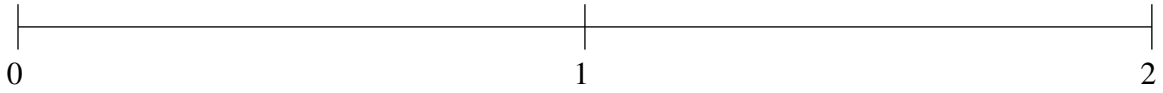

$\frac{4}{5},\ \frac{1}{2},\ 1\frac{4}{5},\ 1\frac{1}{5},\ 1\frac{1}{2}$

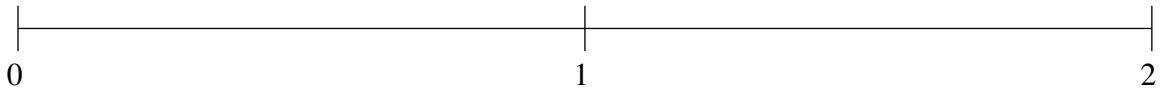

Ordenar Fracciones (A) Respuestas

Ordene cada conjunto de fracciones usando la recta numérica.

$\frac{4}{5},\ 1\frac{1}{2},\ 1\frac{1}{5},\ \frac{1}{2},\ \frac{1}{5}$

$\frac{1}{5},\ \frac{1}{2},\ \frac{4}{5},\ 1\frac{1}{5},\ 1\frac{1}{2}$

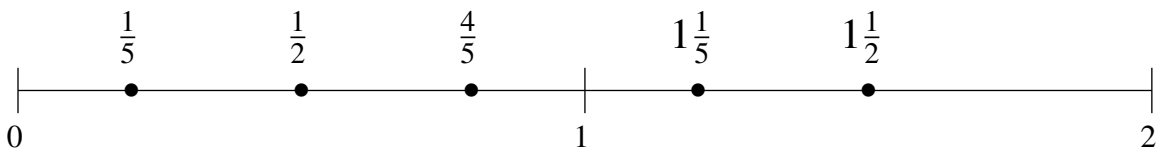

$1\frac{1}{2},\ \frac{9}{10},\ \frac{1}{5},\ 1\frac{4}{5},\ \frac{1}{2}$

$\frac{1}{5},\ \frac{1}{2},\ \frac{9}{10},\ 1\frac{1}{2},\ 1\frac{4}{5}$

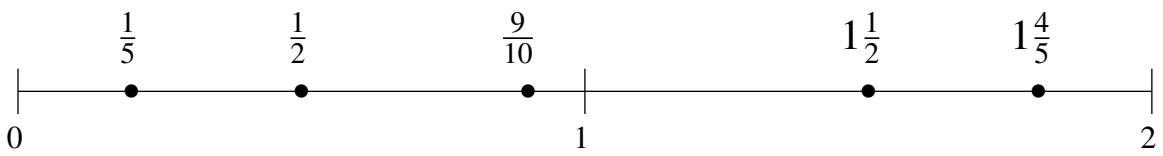

$\frac{4}{5},\ \frac{1}{2},\ 1\frac{4}{5},\ 1\frac{1}{5},\ 1\frac{1}{2}$
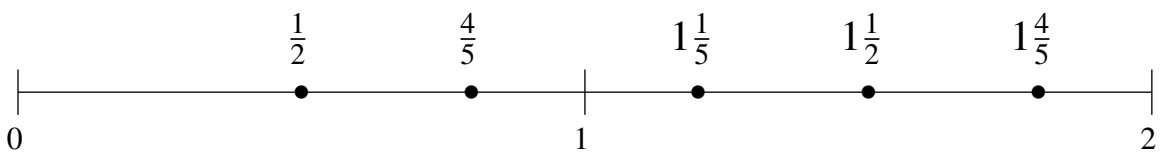
$\frac{1}{2},\ \frac{4}{5},\ 1\frac{1}{5},\ 1\frac{1}{2},\ 1\frac{4}{5}$