Ordenar Fracciones (C)

Ordene cada conjunto de fracciones usando la recta numérica.

$-1\frac{2}{5},\ -1\frac{22}{25},\ -\frac{1}{20},\ \frac{3}{5},\ 1\frac{1}{2},\ 1\frac{3}{4},\ -\frac{1}{2},\ 1\frac{1}{5}$

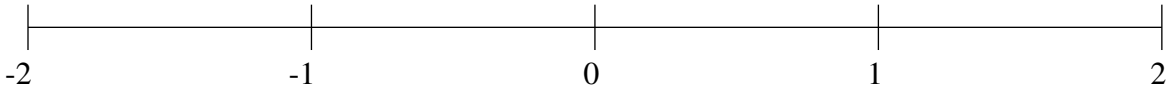

$1\frac{3}{4},\ -1\frac{18}{25},\ -\frac{1}{4},\ \frac{3}{4},\ -1\frac{2}{5},\ \frac{1}{2},\ \frac{1}{5},\ 1\frac{1}{2}$

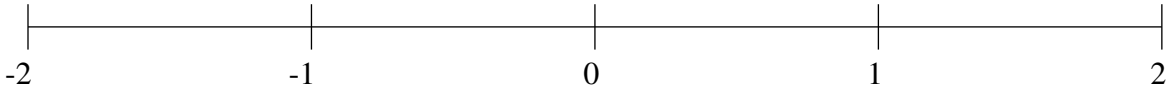

$\frac{1}{2},\ -1\frac{1}{5},\ 1\frac{1}{2},\ -1\frac{9}{10},\ -\frac{1}{5},\ -\frac{1}{2},\ 1\frac{3}{4},\ \frac{1}{10}$

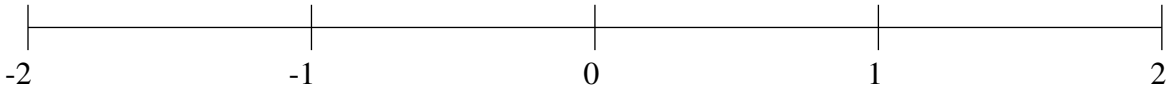

Ordenar Fracciones (C) Respuestas

Ordene cada conjunto de fracciones usando la recta numérica.

$-1\frac{2}{5},\ -1\frac{22}{25},\ -\frac{1}{20},\ \frac{3}{5},\ 1\frac{1}{2},\ 1\frac{3}{4},\ -\frac{1}{2},\ 1\frac{1}{5}$

$-1\frac{22}{25},\ -1\frac{2}{5},\ -\frac{1}{2},\ -\frac{1}{20},\ \frac{3}{5},\ 1\frac{1}{5},\ 1\frac{1}{2},\ 1\frac{3}{4}$

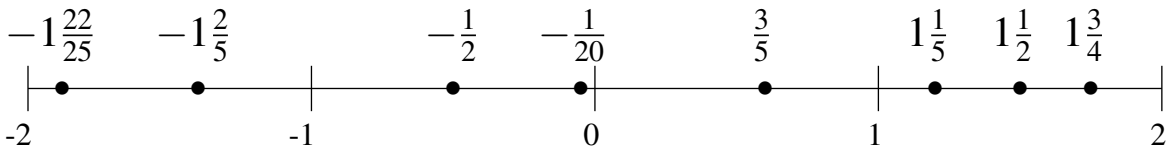

$1\frac{3}{4},\ -1\frac{18}{25},\ -\frac{1}{4},\ \frac{3}{4},\ -1\frac{2}{5},\ \frac{1}{2},\ \frac{1}{5},\ 1\frac{1}{2}$

$-1\frac{18}{25},\ -1\frac{2}{5},\ -\frac{1}{4},\ \frac{1}{5},\ \frac{1}{2},\ \frac{3}{4},\ 1\frac{1}{2},\ 1\frac{3}{4}$

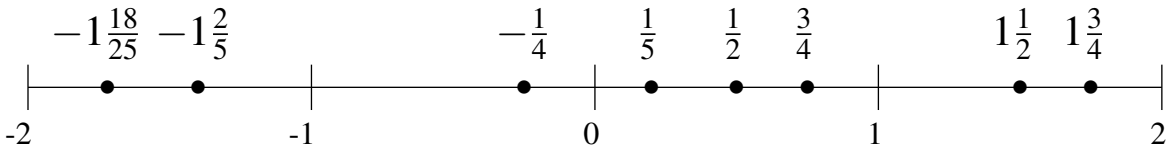

$\frac{1}{2},\ -1\frac{1}{5},\ 1\frac{1}{2},\ -1\frac{9}{10},\ -\frac{1}{5},\ -\frac{1}{2},\ 1\frac{3}{4},\ \frac{1}{10}$
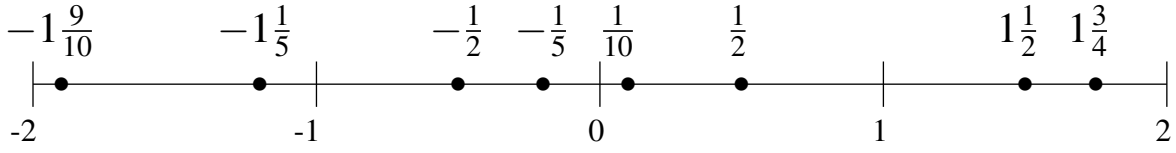
$-1\frac{9}{10},\ -1\frac{1}{5},\ -\frac{1}{2},\ -\frac{1}{5},\ \frac{1}{10},\ \frac{1}{2},\ 1\frac{1}{2},\ 1\frac{3}{4}$