Clasificar Cuadriláteros (C)

Identifique cada cuadrilátero.



_____

_____

_____



_____

_____



_____

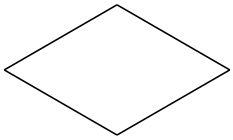

_____



_____

_____



_____

Clasificar Cuadriláteros (C) Respuesta

Identifique cada cuadrilátero.



cuadrado

paralelogramo

cuadrado



rectángulo

paralelogramo



paralelogramo

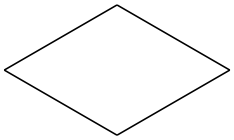

rombo



rectángulo

cuadrado



cuadrado