Clasificar Figuras (C)

Identifique cada figura.

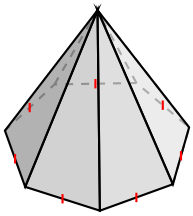

_____

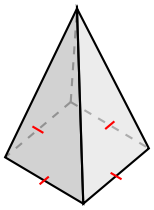

_____

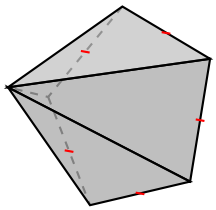

_____

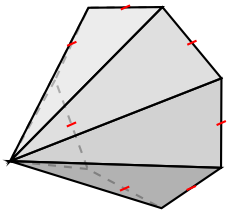

_____

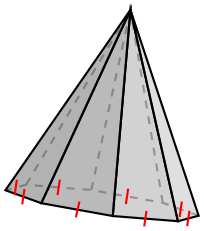

_____

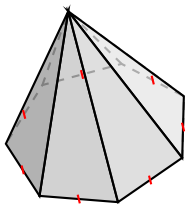

_____

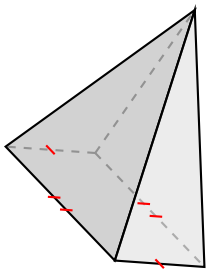

_____

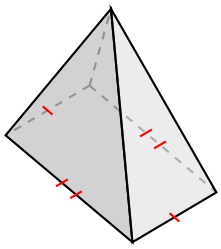

_____

Clasificar Figuras (C) Respuestas

Identifique cada figura.

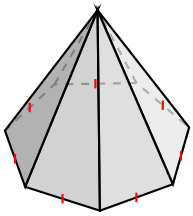

pirámide heptagonal

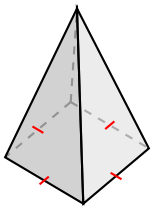

pirámide cuadrada

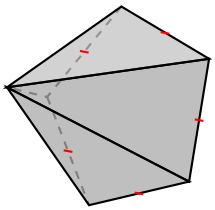

pentagonal pyramid

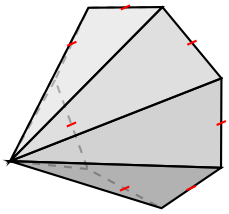

pirámide heptagonal

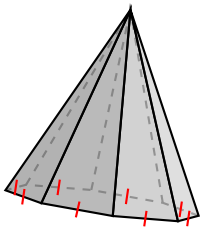

pirámide octagonal

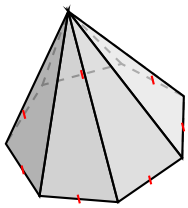

pirámide heptagonal

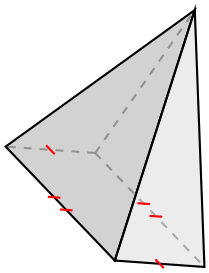

pirámide rectangular

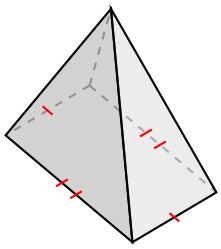

pirámide rectangular