Clasificar Ángulos (D)

Clasifique cada ángulo como agudo, recto, obtuso, llano o reflejo.

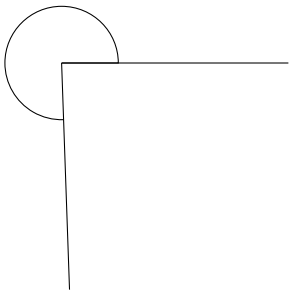

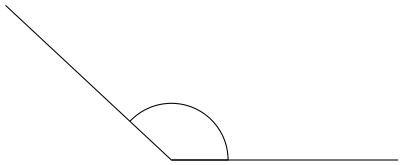

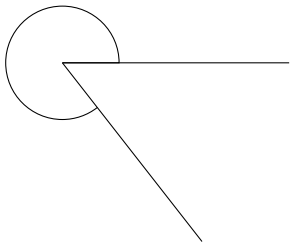

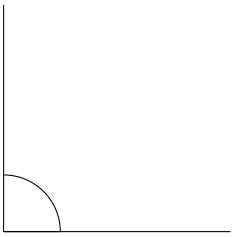

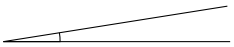

Clasificar Ángulos (D) Respuestas

Clasifique cada ángulo como agudo, recto, obtuso, llano o reflejo.

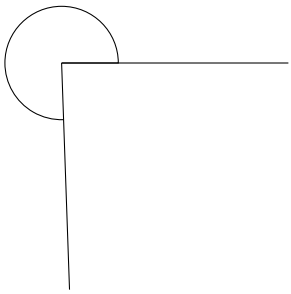

reflejo

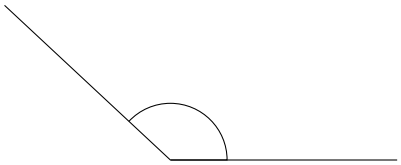

obtuso

llano

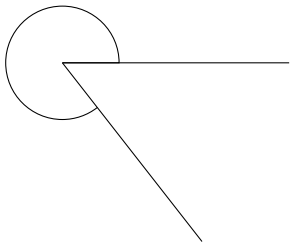

reflejo

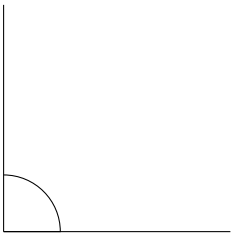

recto

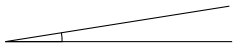

agudo