Clasificar Ángulos (F)

Clasifique cada ángulo como agudo, recto, obtuso, llano o reflejo.

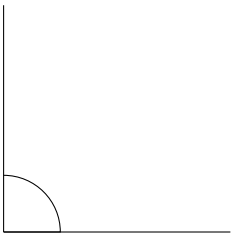

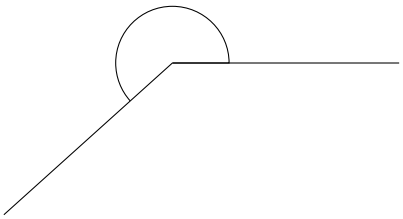

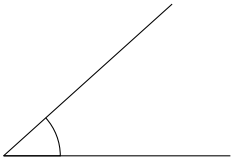

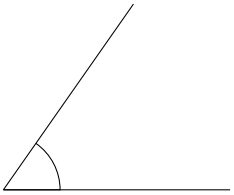

Clasificar Ángulos (F) Respuestas

Clasifique cada ángulo como agudo, recto, obtuso, llano o reflejo.

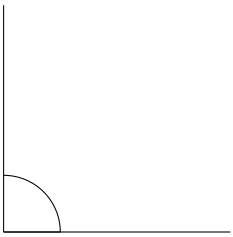

recto

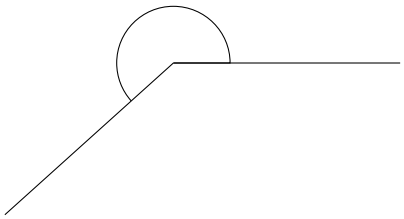

reflejo

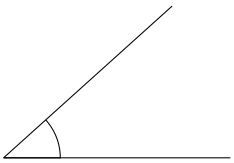

agudo

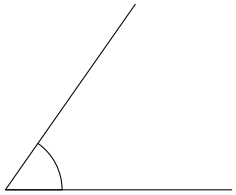

agudo

obtuso

llano