Clasificar Ángulos (H)

Clasifique cada ángulo como agudo, recto, obtuso, llano o reflejo.

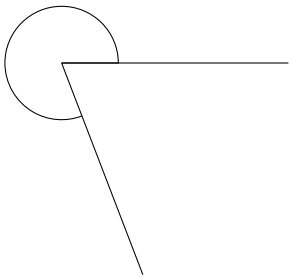

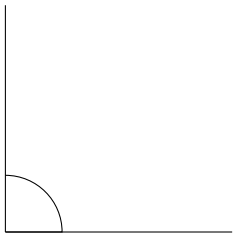

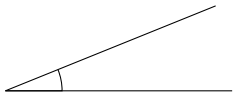

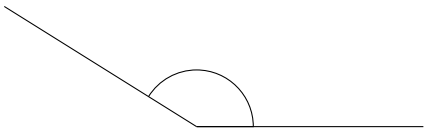

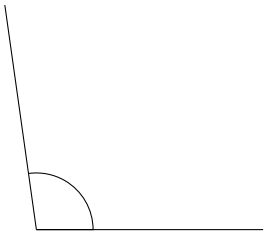

Clasificar Ángulos (H) Respuestas

Clasifique cada ángulo como agudo, recto, obtuso, llano o reflejo.

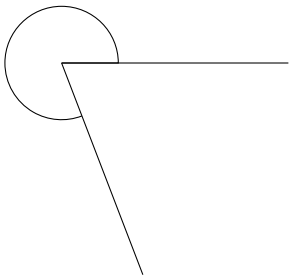

reflejo

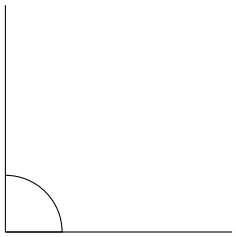

recto

llano

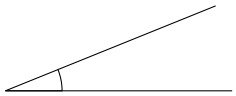

agudo

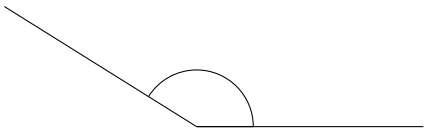

obtuso

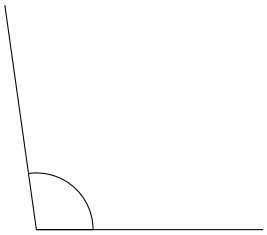

obtuso