Clasificar Ángulos (A)

Clasifique cada ángulo como agudo, recto, obtuso, llano o reflejo.

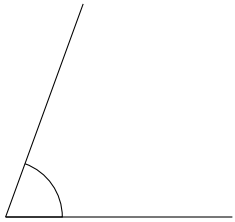

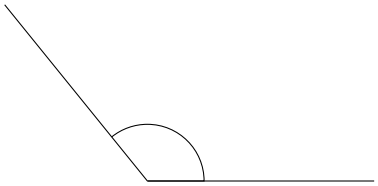

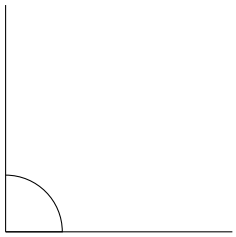

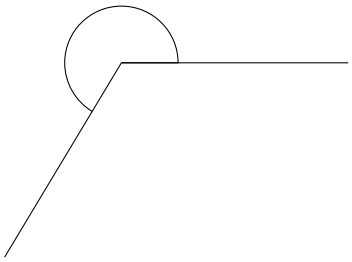

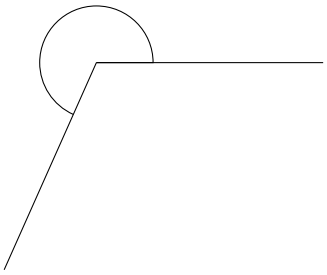

Clasificar Ángulos (A) Respuestas

Clasifique cada ángulo como agudo, recto, obtuso, llano o reflejo.

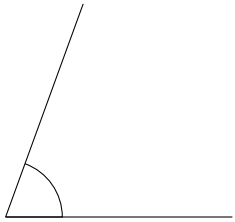

agudo

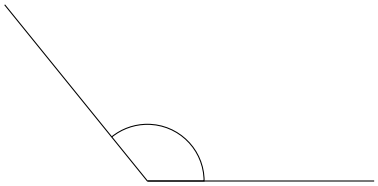

obtuso

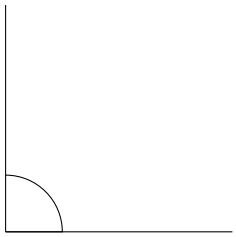

recto

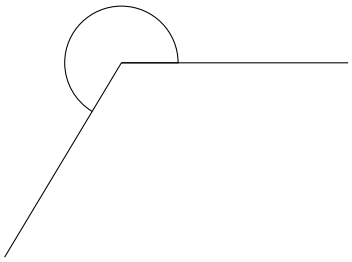

reflejo

llano

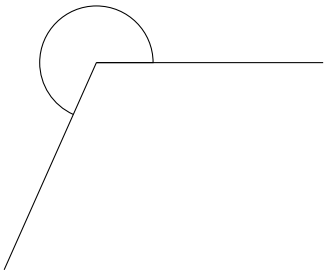

reflejo

Clasificar Ángulos (B)

Clasifique cada ángulo como agudo, recto, obtuso, llano o reflejo.

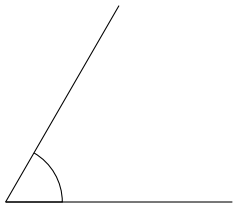

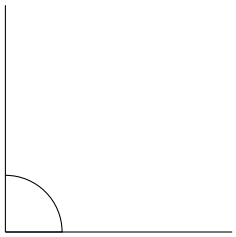

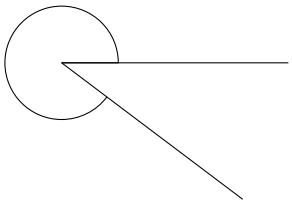

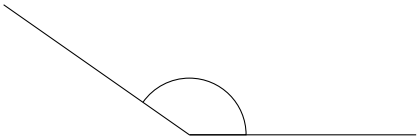

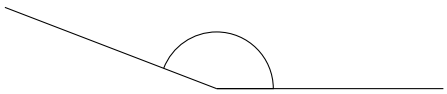

Clasificar Ángulos (B) Respuestas

Clasifique cada ángulo como agudo, recto, obtuso, llano o reflejo.

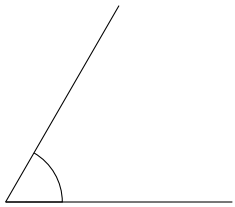

agudo

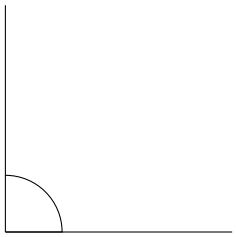

recto

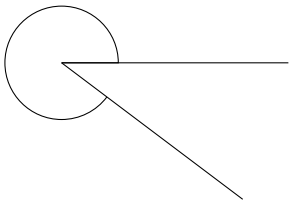

reflejo

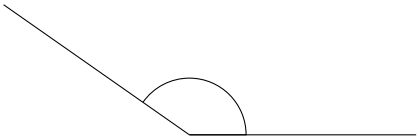

obtuso

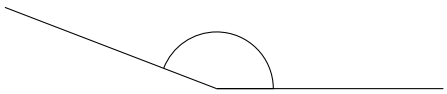

obtuso

llano

Clasificar Ángulos (C)

Clasifique cada ángulo como agudo, recto, obtuso, llano o reflejo.

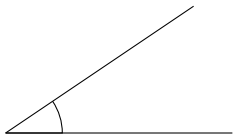

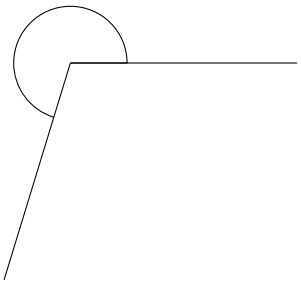

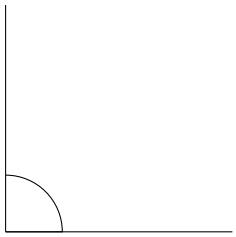

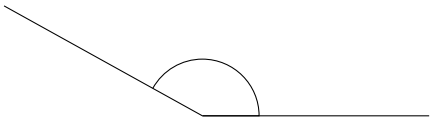

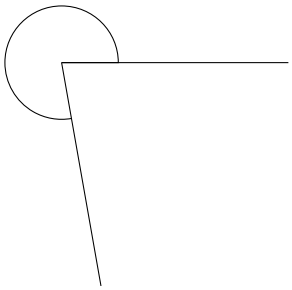

Clasificar Ángulos (C) Respuestas

Clasifique cada ángulo como agudo, recto, obtuso, llano o reflejo.

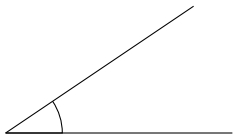

agudo

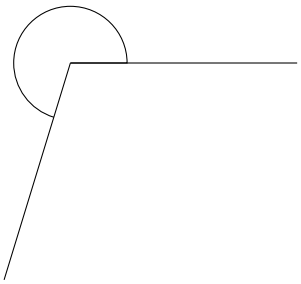

reflejo

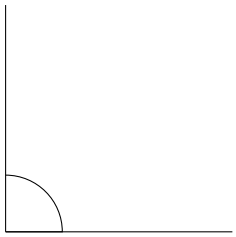

recto

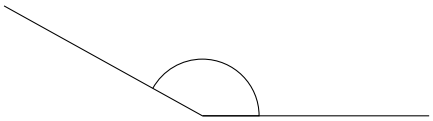

obtuso

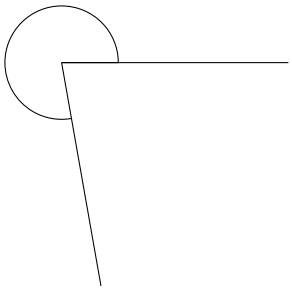

reflejo

llano

Clasificar Ángulos (D)

Clasifique cada ángulo como agudo, recto, obtuso, llano o reflejo.

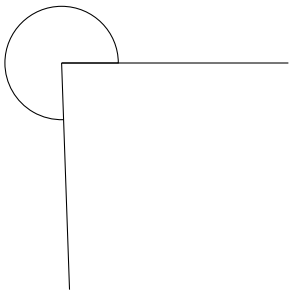

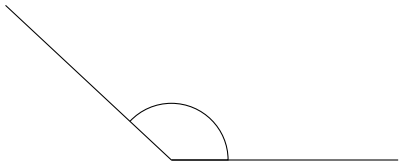

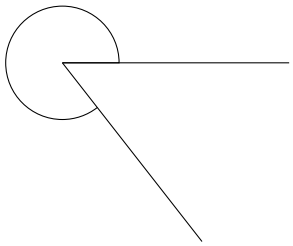

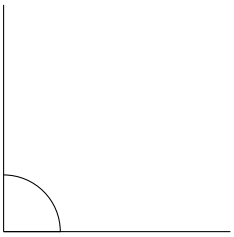

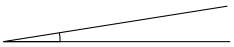

Clasificar Ángulos (D) Respuestas

Clasifique cada ángulo como agudo, recto, obtuso, llano o reflejo.

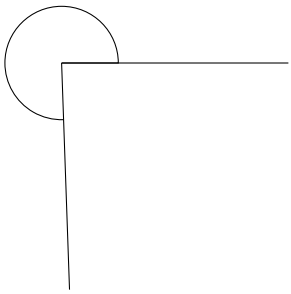

reflejo

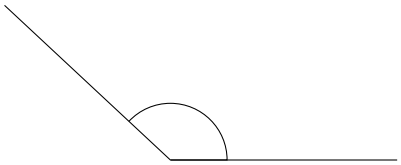

obtuso

llano

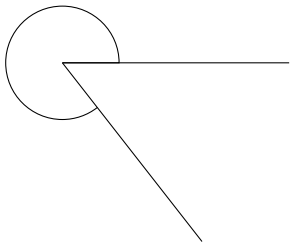

reflejo

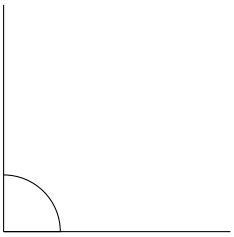

recto

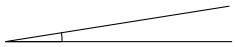

agudo

Clasificar Ángulos (E)

Clasifique cada ángulo como agudo, recto, obtuso, llano o reflejo.

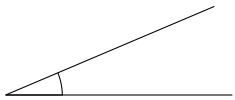

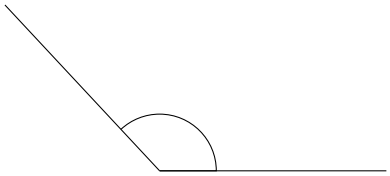

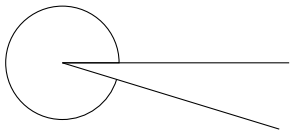

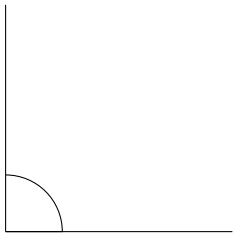

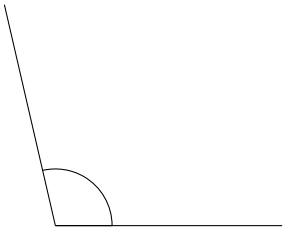

Clasificar Ángulos (E) Respuestas

Clasifique cada ángulo como agudo, recto, obtuso, llano o reflejo.

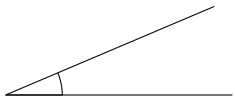

agudo

llano

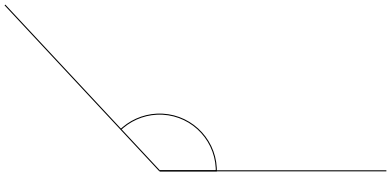

obtuso

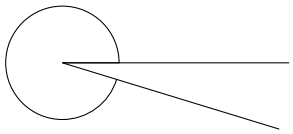

reflejo

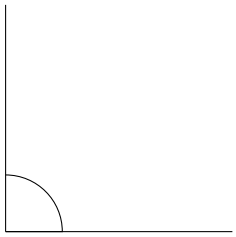

recto

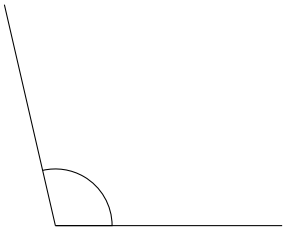

obtuso

Clasificar Ángulos (F)

Clasifique cada ángulo como agudo, recto, obtuso, llano o reflejo.

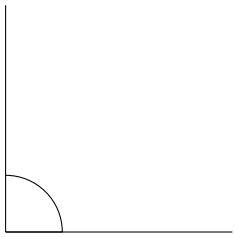

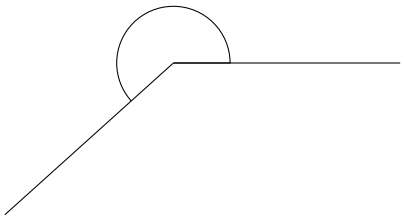

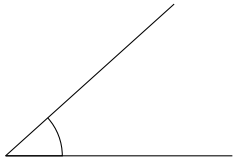

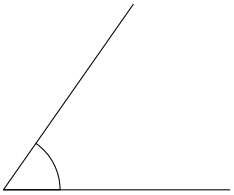

Clasificar Ángulos (F) Respuestas

Clasifique cada ángulo como agudo, recto, obtuso, llano o reflejo.

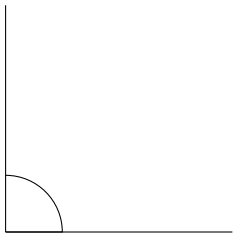

recto

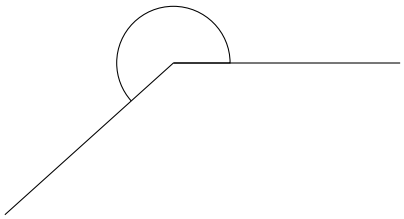

reflejo

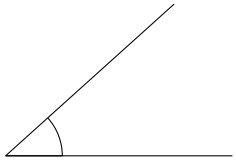

agudo

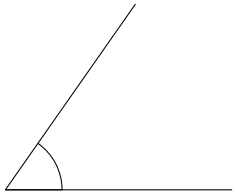

agudo

obtuso

llano

Clasificar Ángulos (G)

Clasifique cada ángulo como agudo, recto, obtuso, llano o reflejo.

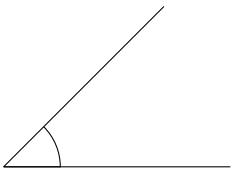

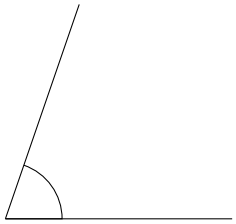

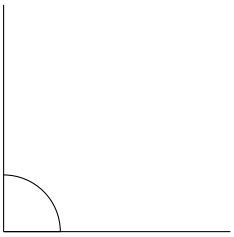

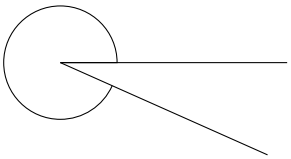

Clasificar Ángulos (G) Respuestas

Clasifique cada ángulo como agudo, recto, obtuso, llano o reflejo.

llano

obtuso

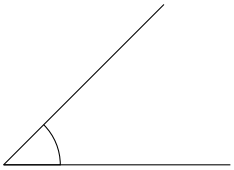

agudo

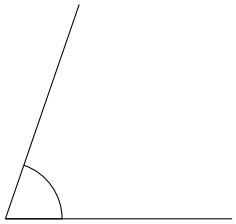

agudo

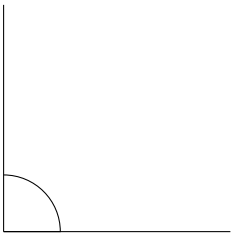

recto

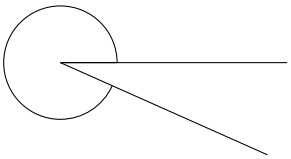

reflejo

Clasificar Ángulos (H)

Clasifique cada ángulo como agudo, recto, obtuso, llano o reflejo.

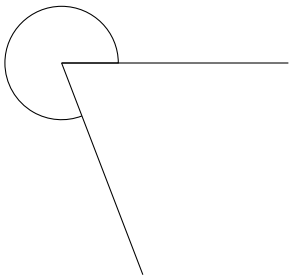

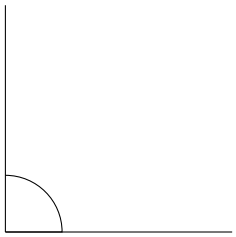

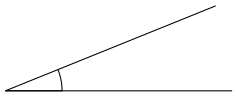

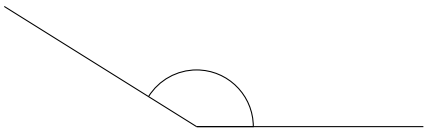

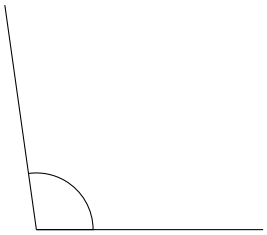

Clasificar Ángulos (H) Respuestas

Clasifique cada ángulo como agudo, recto, obtuso, llano o reflejo.

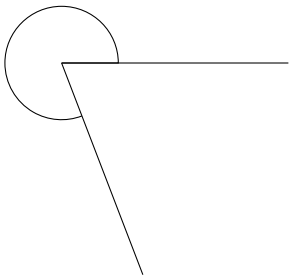

reflejo

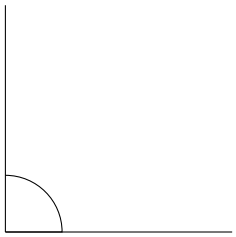

recto

llano

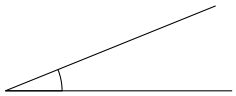

agudo

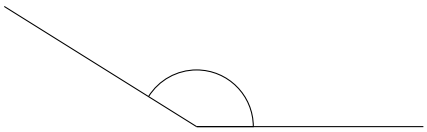

obtuso

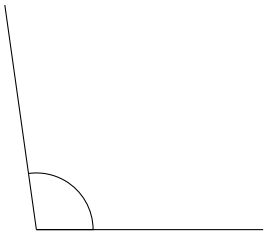

obtuso

Clasificar Ángulos (I)

Clasifique cada ángulo como agudo, recto, obtuso, llano o reflejo.

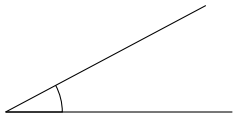

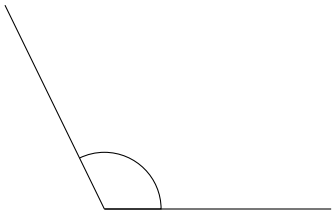

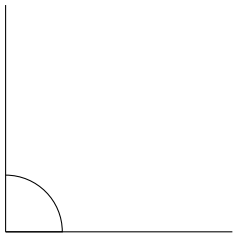

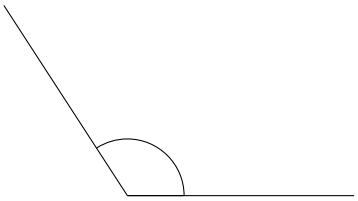

Clasificar Ángulos (I) Respuestas

Clasifique cada ángulo como agudo, recto, obtuso, llano o reflejo.

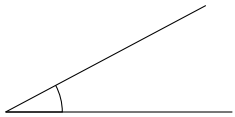

agudo

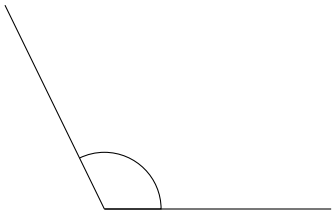

obtuso

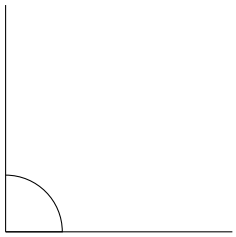

recto

llano

reflejo

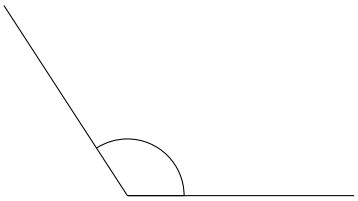

obtuso

Clasificar Ángulos (J)

Clasifique cada ángulo como agudo, recto, obtuso, llano o reflejo.

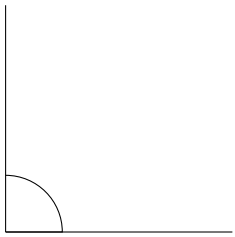

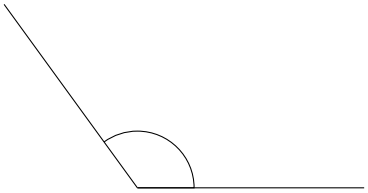

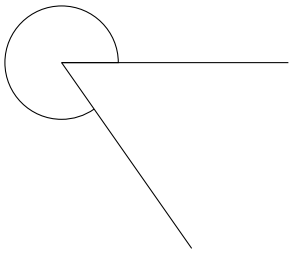

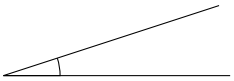

Clasificar Ángulos (J) Respuestas

Clasifique cada ángulo como agudo, recto, obtuso, llano o reflejo.

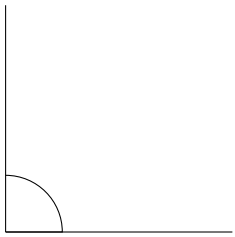

recto

llano

obtuso

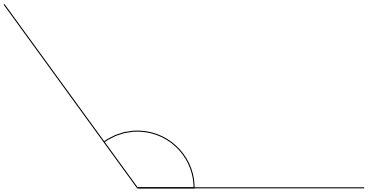

obtuso

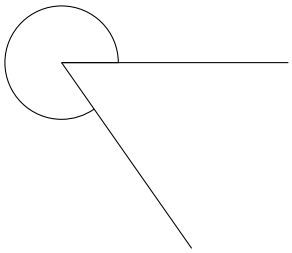

reflejo

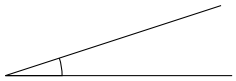

agudo