Función Tangente (E)

Nombre: _____ Fecha: _____

Calcule los valores de los ángulos usando la función tangente: $tan(\alpha) = \frac{C.O.}{C.A.}$

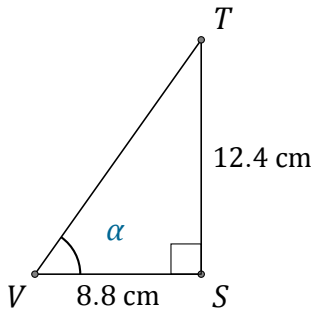

$\alpha = \angle SVT =$ _____

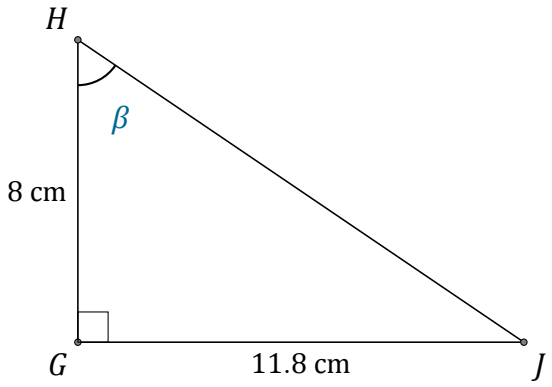

$\beta = \angle GHJ =$ _____

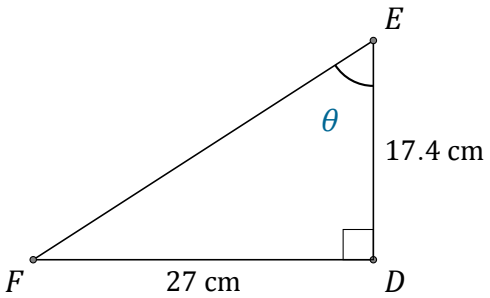

$\theta = \angle DEF =$ _____

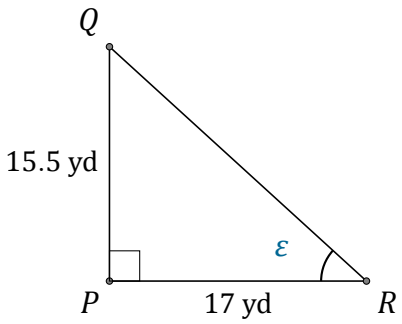

$\varepsilon = \angle PRQ =$ _____

Función Tangente (E) Respuestas

Nombre: _____ Fecha: _____

Calcule los valores de los ángulos usando la función tangente: $tan(\alpha) = \frac{C.O.}{C.A.}$

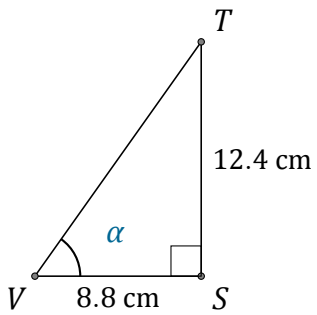

$\alpha = \angle SVT =$ 54.6°

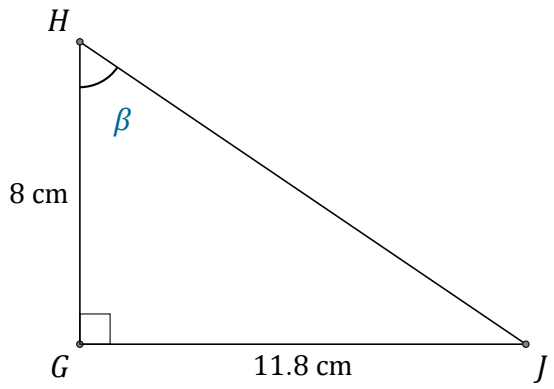

$\beta = \angle GHJ =$ 55.9°

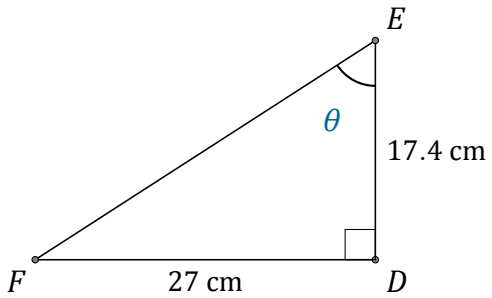

$\theta = \angle DEF =$ 57.2°

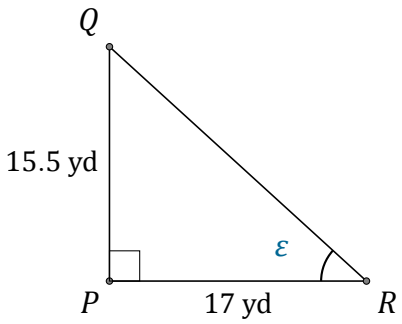

$\varepsilon = \angle PRQ =$ 42.4°