Funciones Trigonométricas (A)

Nombre: _____ Fecha: _____

Calcule los valores de los ángulos y lados usando funciones trigonométricas

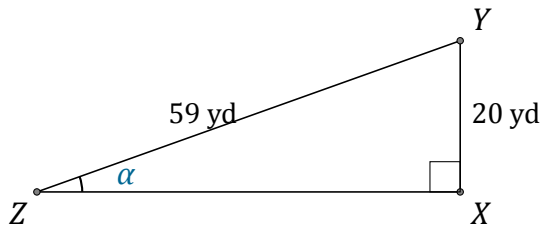

$\alpha = \angle XZY =$ _____

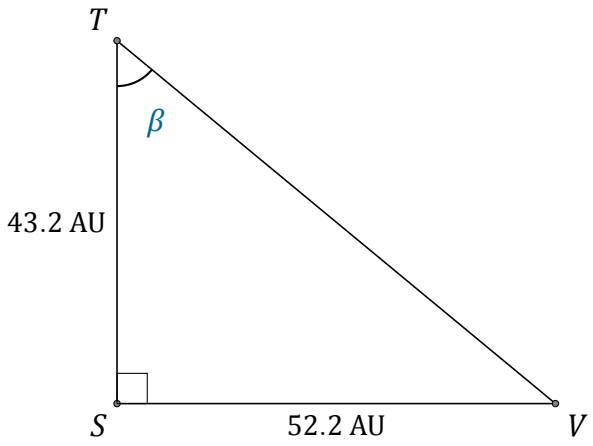

$\beta = \angle STV =$ _____

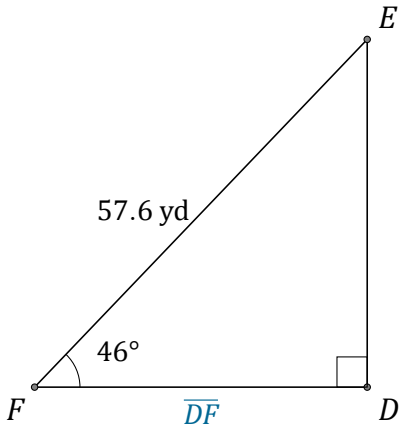

$\overline{DF} =$ _____

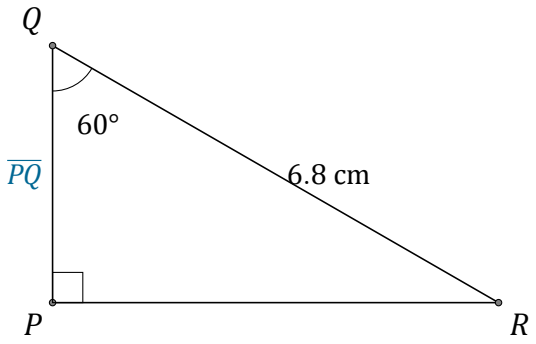

$\overline{PQ} =$ _____

Funciones Trigonométricas (A) Respuestas

Nombre: _____ Fecha: _____

Calcule los valores de los ángulos y lados usando funciones trigonométricas

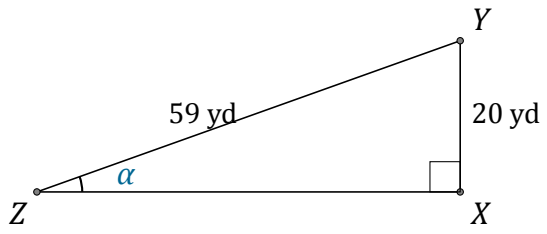

$\alpha = \angle XZY =$ 19.8°

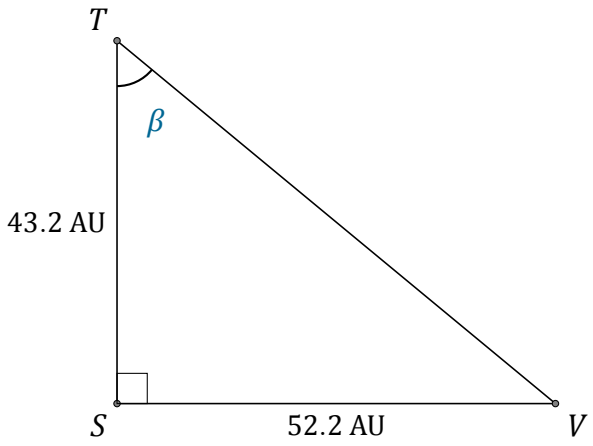

$\beta = \angle STV =$ 50.4°

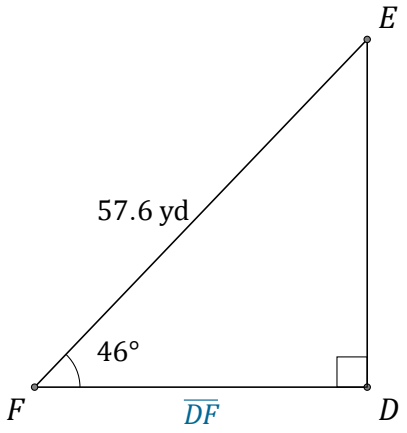

$\overline{DF} =$ 40 yd

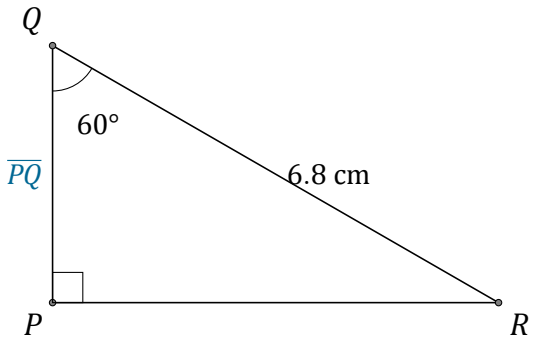

$\overline{PQ} =$ 3.4 cm

Funciones Trigonométricas (B)

Nombre: _____ Fecha: _____

Calcule los valores de los ángulos y lados usando funciones trigonométricas

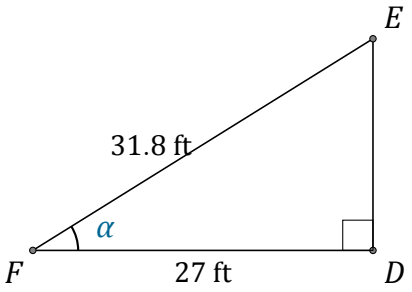

$\alpha = \angle DFE =$ _____

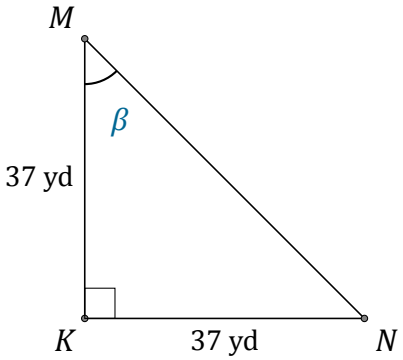

$\beta = \angle KMN =$ _____

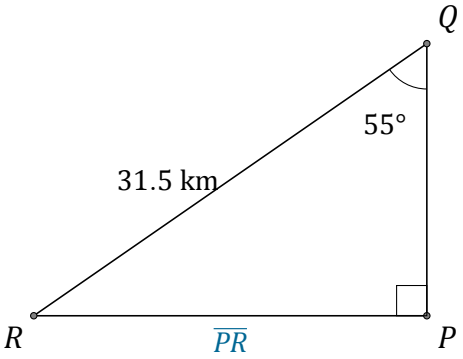

$\overline{PR} =$ _____

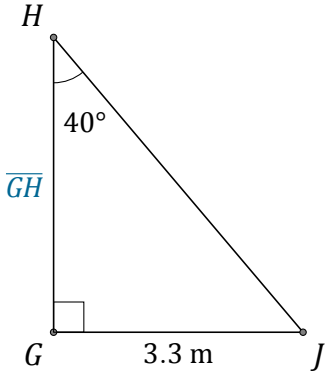

$\overline{GH} =$ _____

Funciones Trigonométricas (B) Respuestas

Nombre: _____ Fecha: _____

Calcule los valores de los ángulos y lados usando funciones trigonométricas

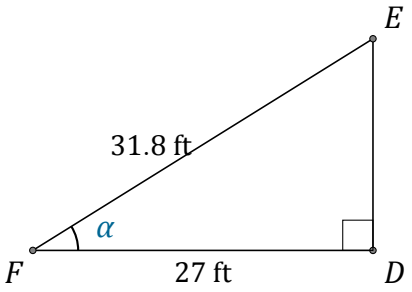

$\alpha = \angle DFE =$ 31.9°

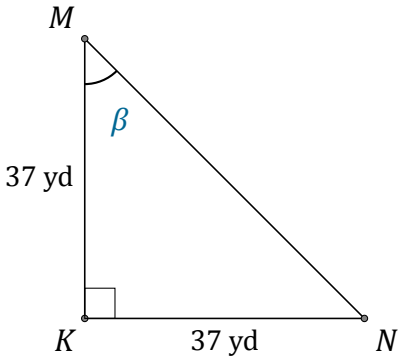

$\beta = \angle KMN =$ 45°

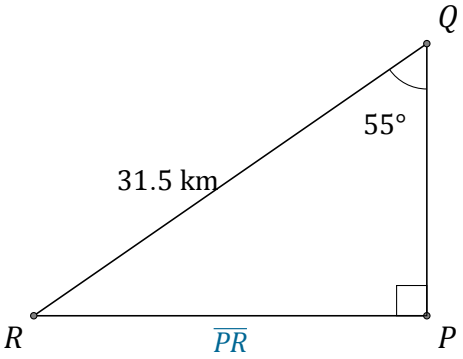

$\overline{PR} =$ 25.8 km

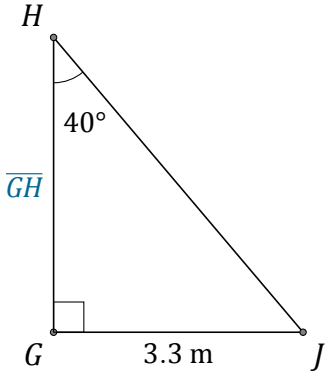

$\overline{GH} =$ 3.9 m

Funciones Trigonométricas (C)

Nombre: _____ Fecha: _____

Calcule los valores de los ángulos y lados usando funciones trigonométricas

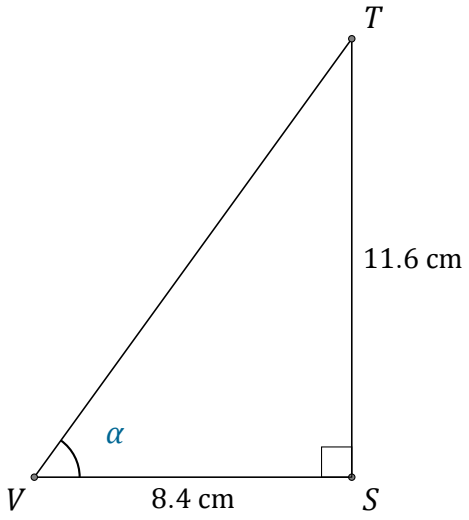

$\alpha = \angle SVT =$ _____

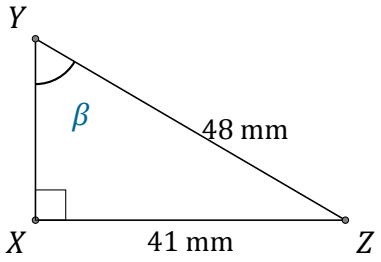

$\beta = \angle XYZ =$ _____

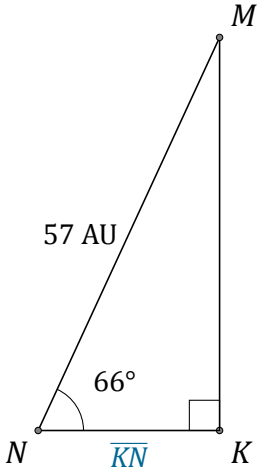

$\overline{KN} =$ _____

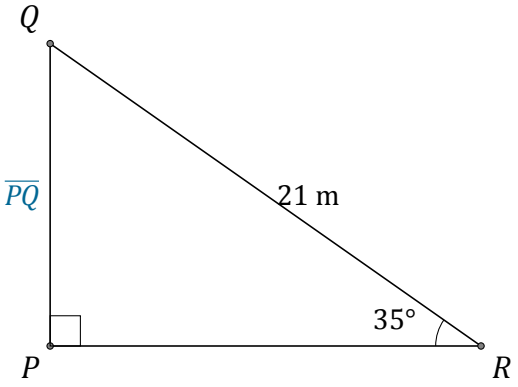

$\overline{PQ} =$ _____

Funciones Trigonométricas (C) Respuestas

Nombre: _____ Fecha: _____

Calcule los valores de los ángulos y lados usando funciones trigonométricas

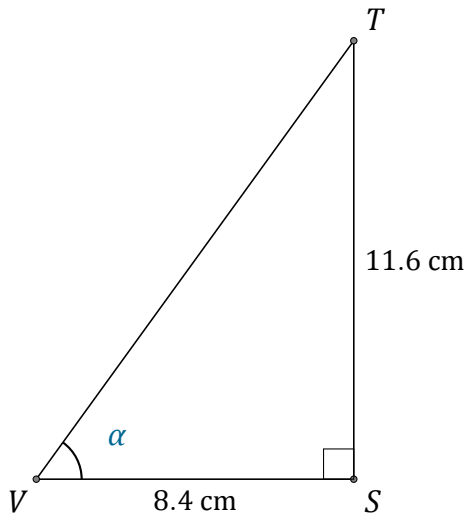

$\alpha = \angle SVT =$ 54.1°

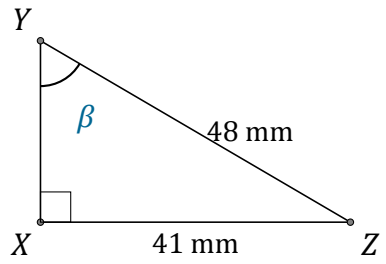

$\beta = \angle XYZ =$ 58.7°

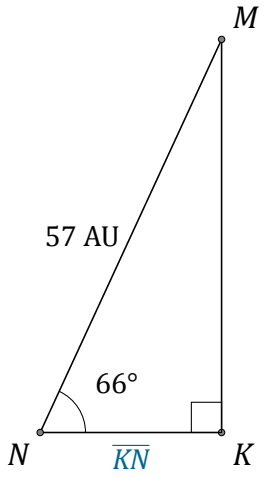

$\overline{KN} =$ 23.2 AU

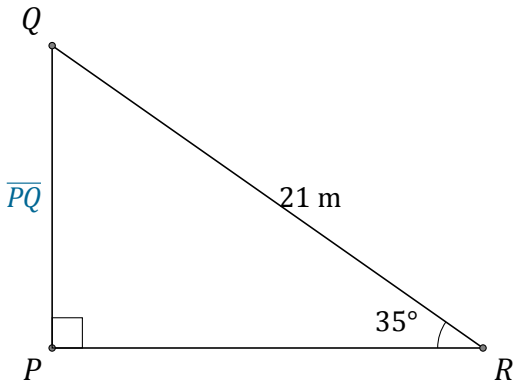

$\overline{PQ} =$ 12 m

Funciones Trigonométricas (D)

Nombre: _____ Fecha: _____

Calcule los valores de los ángulos y lados usando funciones trigonométricas

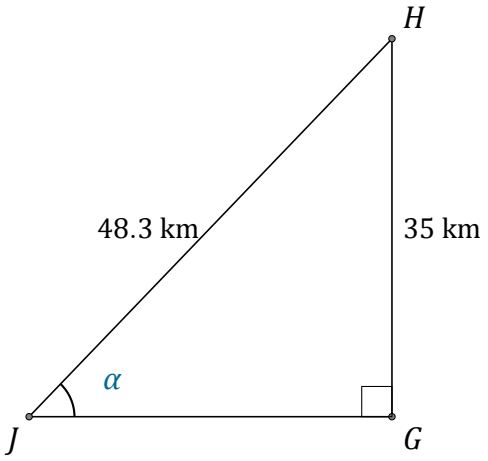

$\alpha = \angle GJH =$ _____

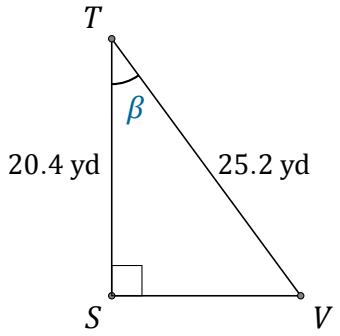

$\beta = \angle STV =$ _____

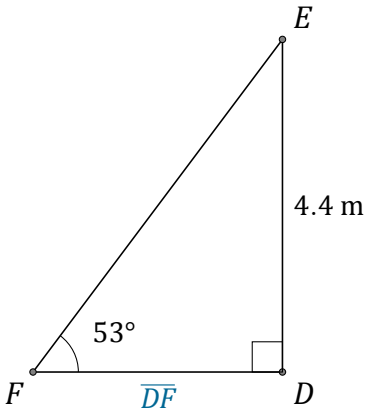

$\overline{DF} =$ _____

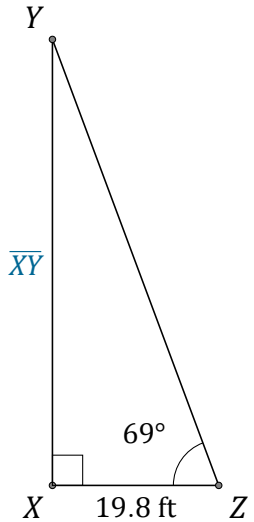

$\overline{XY} =$ _____

Funciones Trigonométricas (D) Respuestas

Nombre: _____ Fecha: _____

Calcule los valores de los ángulos y lados usando funciones trigonométricas

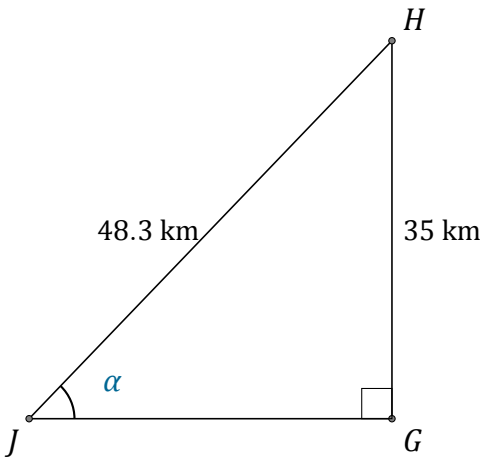

$\alpha = \angle GJH =$ 46.4°

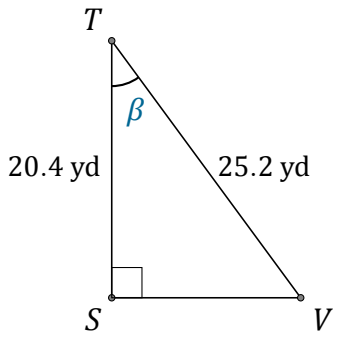

$\beta = \angle STV =$ 36°

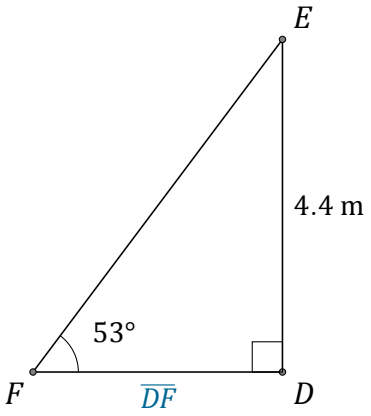

$\overline{DF} =$ 3.3 m

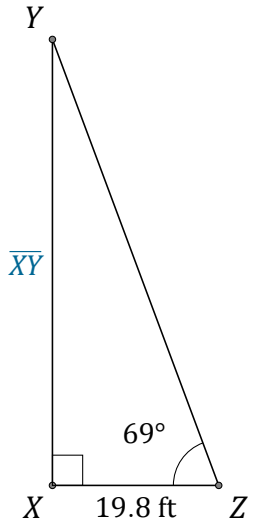

$\overline{XY} =$ 51.6 ft

Funciones Trigonométricas (E)

Nombre: _____ Fecha: _____

Calcule los valores de los ángulos y lados usando funciones trigonométricas

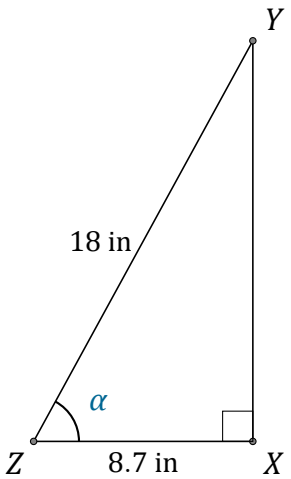

$\alpha = \angle XZY =$ _____

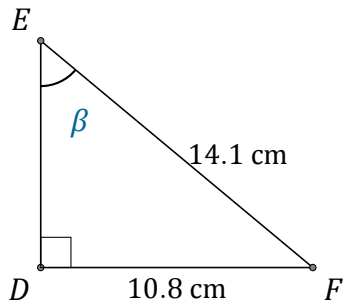

$\beta = \angle DEF =$ _____

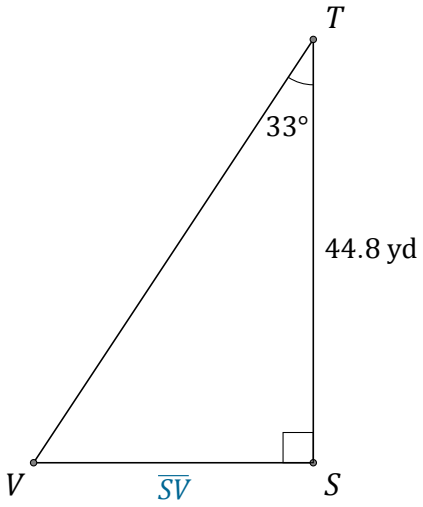

$\overline{SV} =$ _____

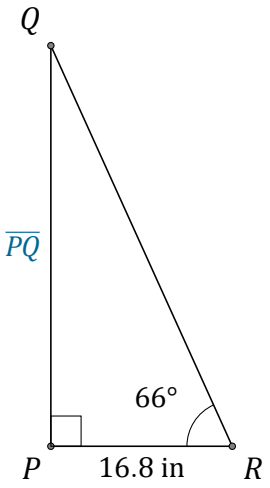

$\overline{PQ} =$ _____

Funciones Trigonométricas (E) Respuestas

Nombre: _____ Fecha: _____

Calcule los valores de los ángulos y lados usando funciones trigonométricas

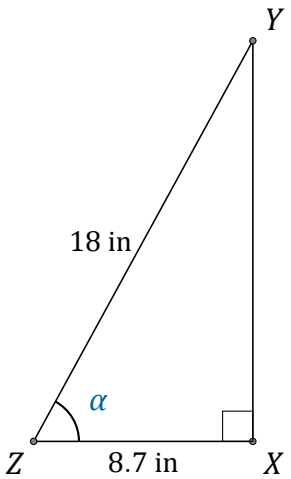

$\alpha = \angle XZY =$ 61.1°

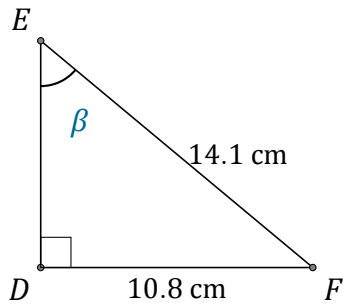

$\beta = \angle DEF =$ 50°

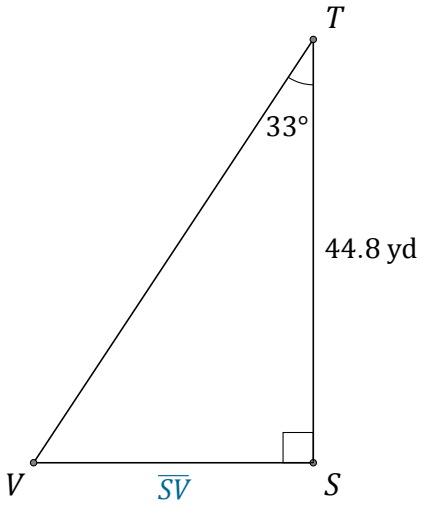

$\overline{SV} =$ 29.1 yd

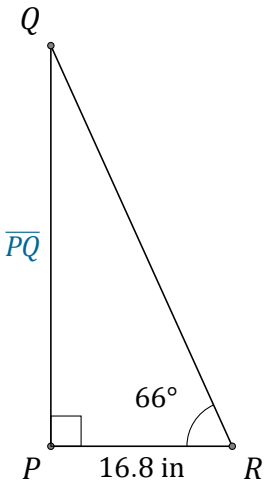

$\overline{PQ} =$ 37.7 in

Funciones Trigonométricas (F)

Nombre: _____ Fecha: _____

Calcule los valores de los ángulos y lados usando funciones trigonométricas

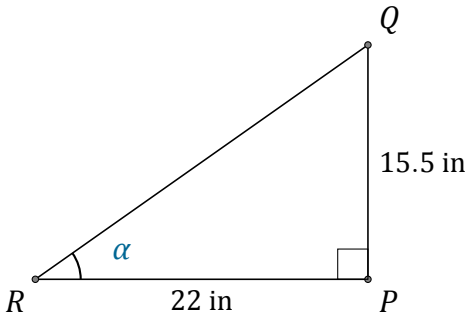

$\alpha = \angle PRQ =$ _____

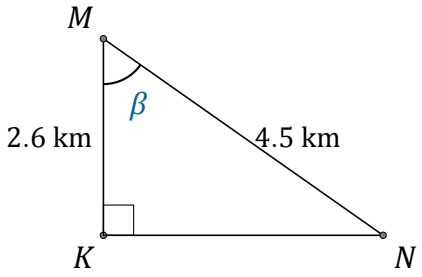

$\beta = \angle KMN =$ _____

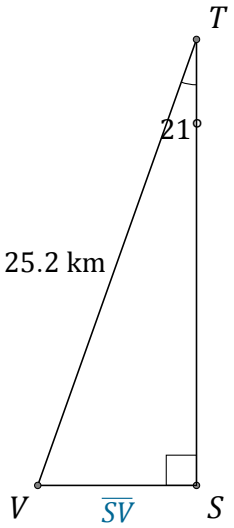

$\overline{SV} =$ _____

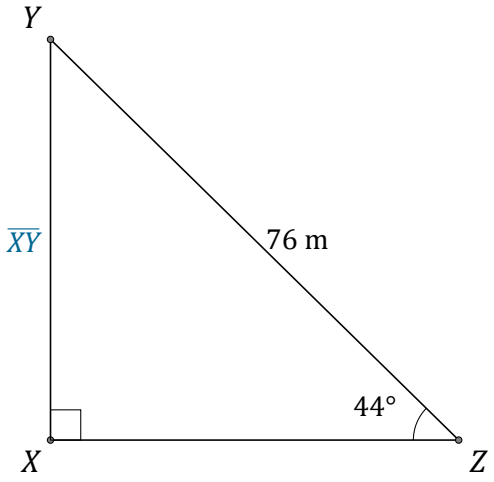

$\overline{XY} =$ _____

Funciones Trigonométricas (F) Respuestas

Nombre: _____ Fecha: _____

Calcule los valores de los ángulos y lados usando funciones trigonométricas

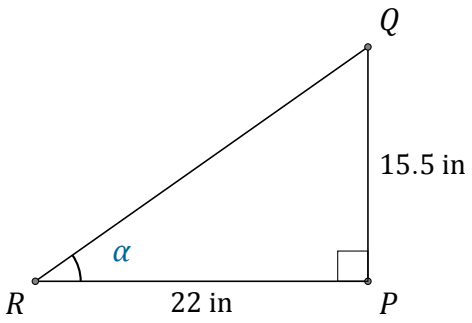

$\alpha = \angle PRQ =$ 35.2°

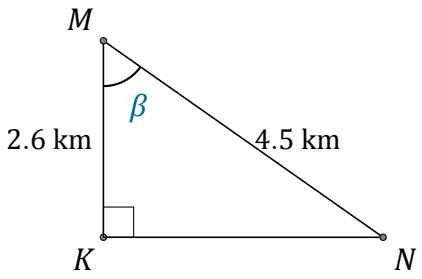

$\beta = \angle KMN =$ 54.7°

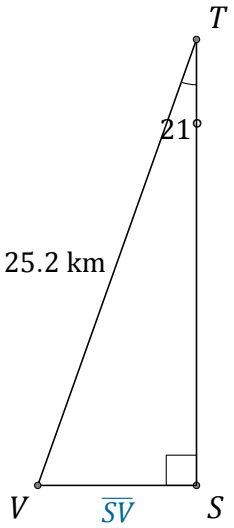

$\overline{SV} =$ 9 km

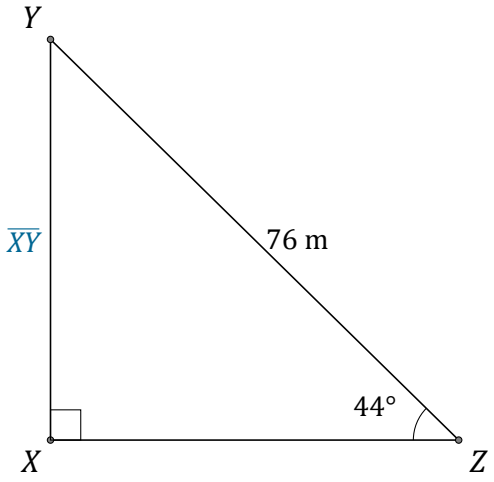

$\overline{XY} =$ 52.8 m

Funciones Trigonométricas (G)

Nombre: _____ Fecha: _____

Calcule los valores de los ángulos y lados usando funciones trigonométricas

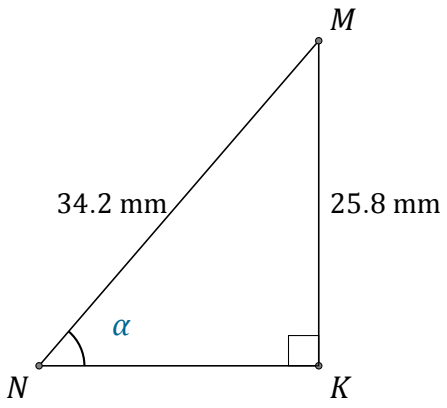

$\alpha = \angle KNM =$ _____

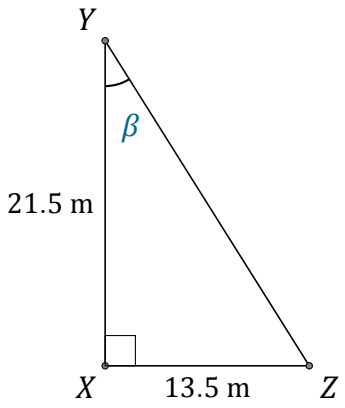

$\beta = \angle XYZ =$ _____

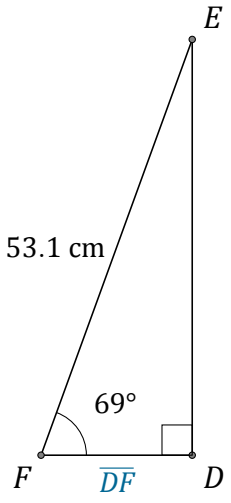

$\overline{DF} =$ _____

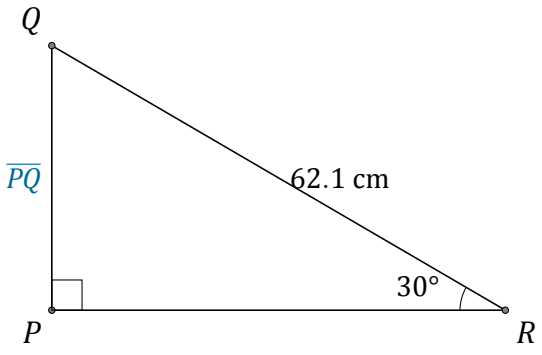

$\overline{PQ} =$ _____

Funciones Trigonométricas (G) Respuestas

Nombre: _____ Fecha: _____

Calcule los valores de los ángulos y lados usando funciones trigonométricas

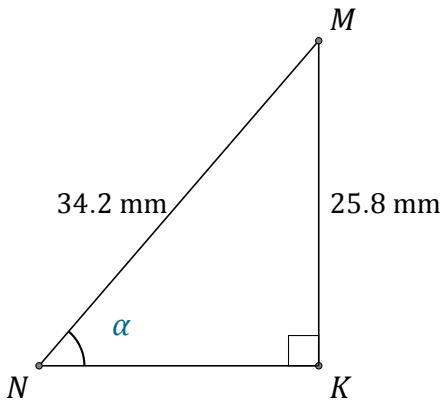

$\alpha = \angle KNM =$ 49°

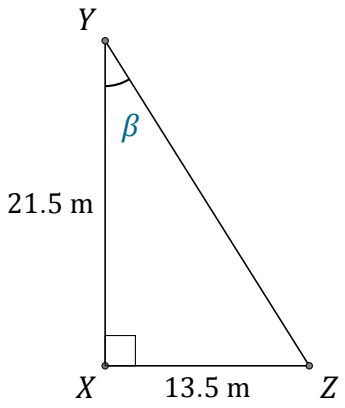

$\beta = \angle XYZ =$ 32.1°

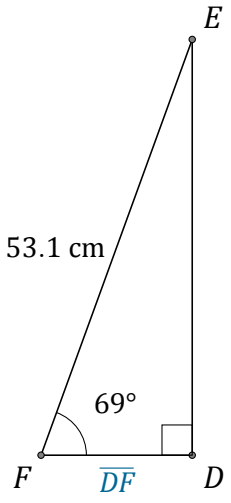

$\overline{DF} =$ 19 cm

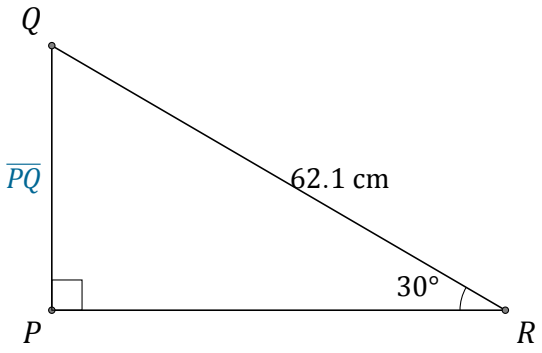

$\overline{PQ} =$ 31.1 cm

Funciones Trigonométricas (H)

Nombre: _____ Fecha: _____

Calcule los valores de los ángulos y lados usando funciones trigonométricas

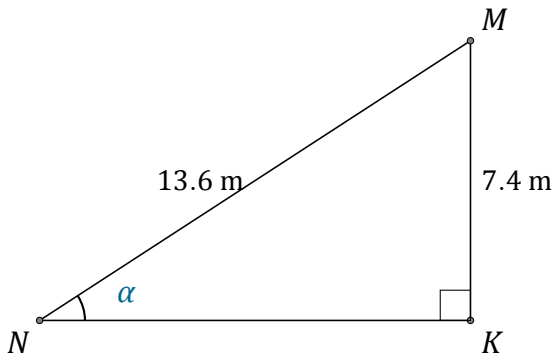

$\alpha = \angle KNM =$ _____

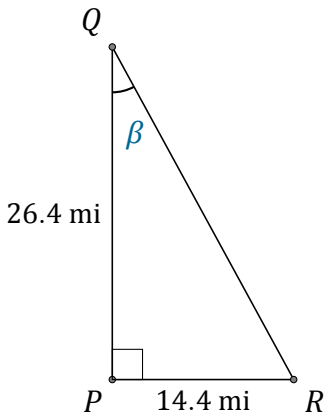

$\beta = \angle PQR =$ _____

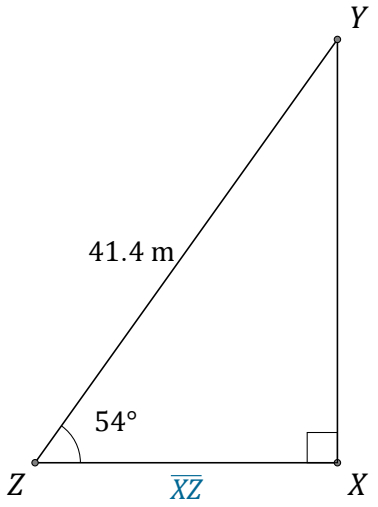

$\overline{XZ} =$ _____

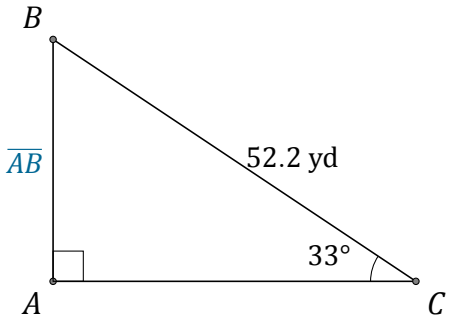

$\overline{AB} =$ _____

Funciones Trigonométricas (H) Respuestas

Nombre: _____ Fecha: _____

Calcule los valores de los ángulos y lados usando funciones trigonométricas

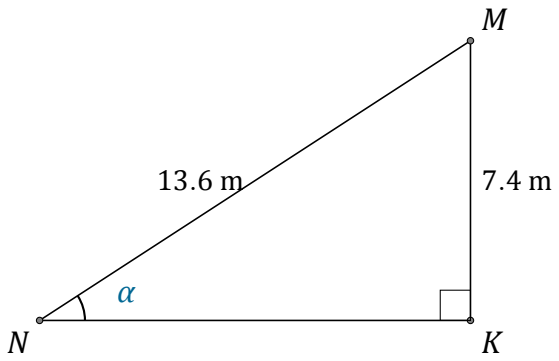

$\alpha = \angle KNM =$ 33°

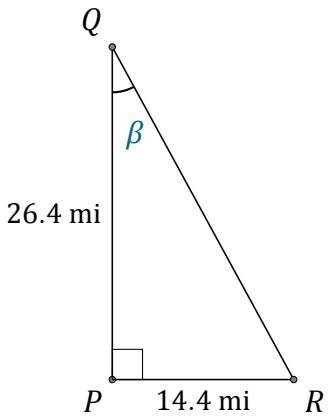

$\beta = \angle PQR =$ 28.6°

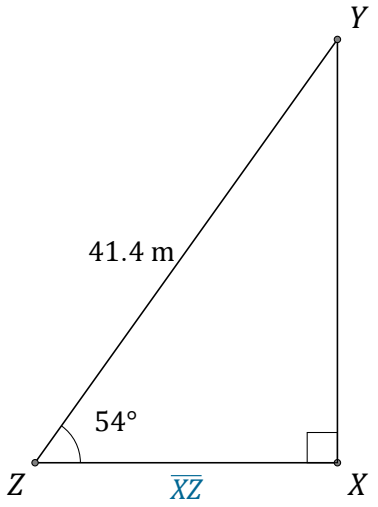

$\overline{XZ} =$ 24.3 m

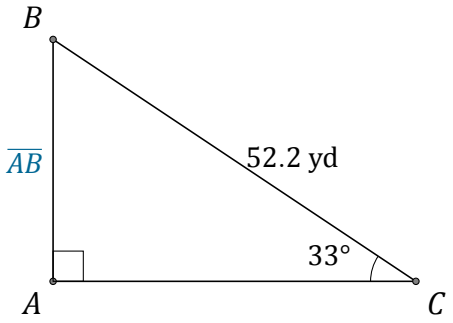

$\overline{AB} =$ 28.4 yd

Funciones Trigonométricas (I)

Nombre: _____ Fecha: _____

Calcule los valores de los ángulos y lados usando funciones trigonométricas

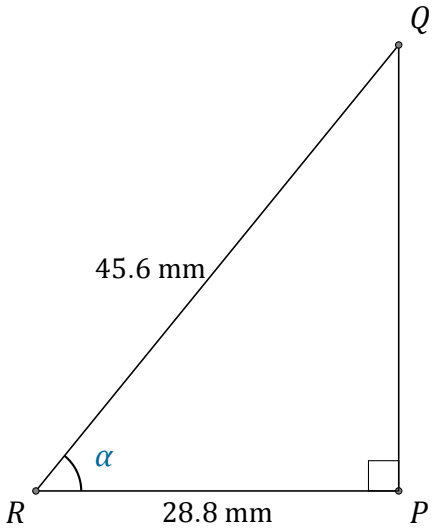

$\alpha = \angle PRQ =$ _____

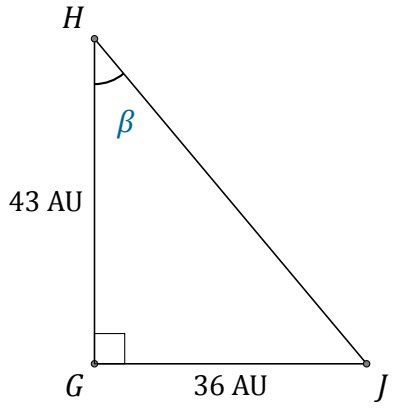

$\beta = \angle GHJ =$ _____

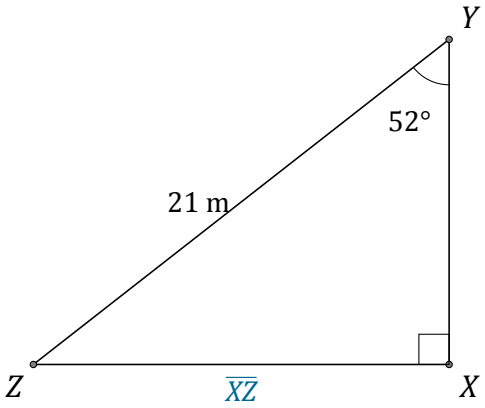

$\overline{XZ} =$ _____

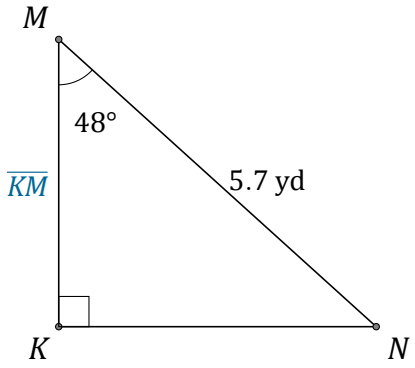

$\overline{KM} =$ _____

Funciones Trigonométricas (I) Respuestas

Nombre: _____ Fecha: _____

Calcule los valores de los ángulos y lados usando funciones trigonométricas

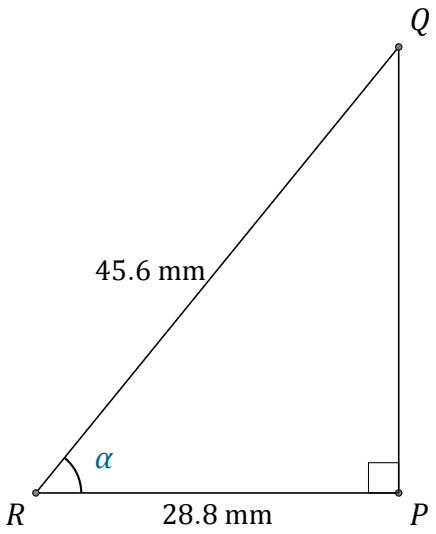

$\alpha = \angle PRQ =$ 50.8°

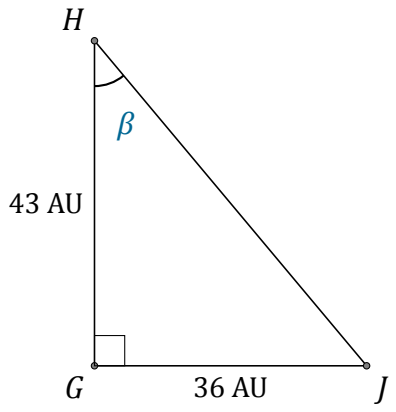

$\beta = \angle GHJ =$ 39.9°

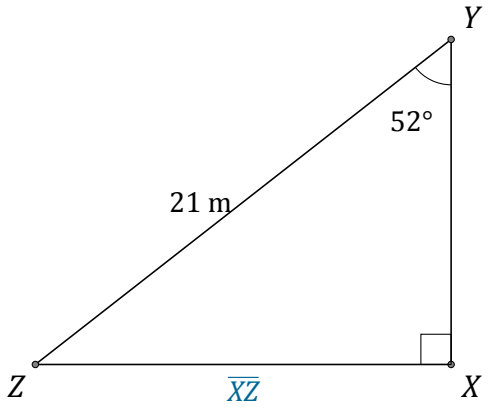

$\overline{XZ} =$ 16.5 m

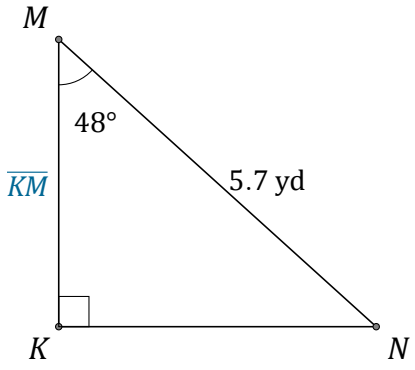

$\overline{KM} =$ 3.8 yd

Funciones Trigonométricas (J)

Nombre: _____ Fecha: _____

Calcule los valores de los ángulos y lados usando funciones trigonométricas

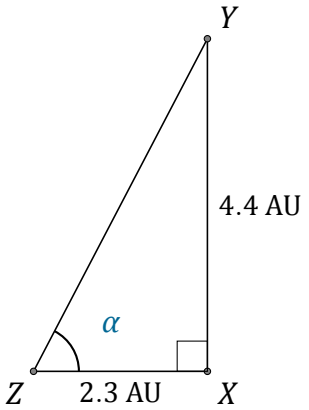

$\alpha = \angle XZY =$ _____

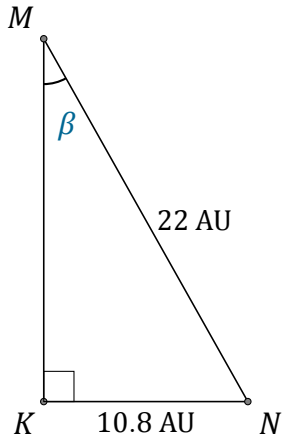

$\beta = \angle KMN =$ _____

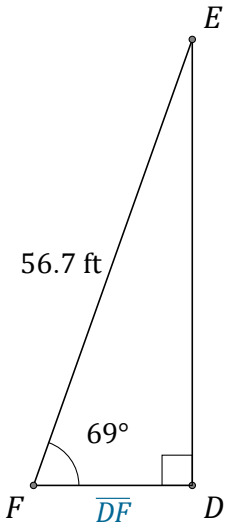

$\overline{DF} =$ _____

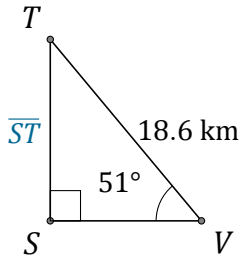

$\overline{ST} =$ _____

Funciones Trigonométricas (J) Respuestas

Nombre: _____ Fecha: _____

Calcule los valores de los ángulos y lados usando funciones trigonométricas

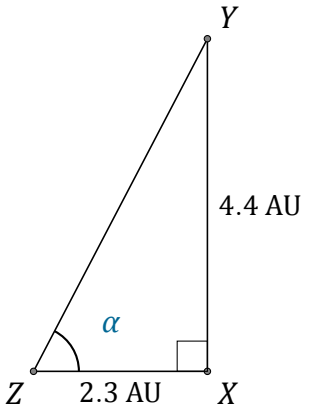

$\alpha = \angle XZY =$ 62.4°

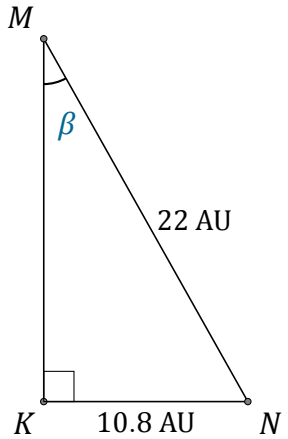

$\beta = \angle KMN =$ 29.4°

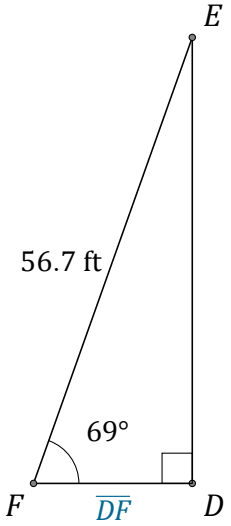

$\overline{DF} =$ 20.3 ft

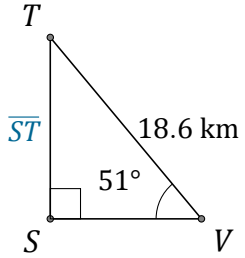

$\overline{ST} =$ 14.5 km