Clasificar Triángulos (D)

Clasifique cada triángulo de acuerdo a la medida de sus ángulos.

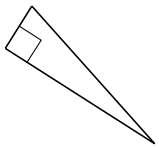

_____

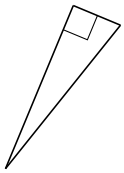

_____

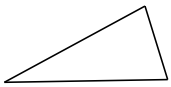

_____

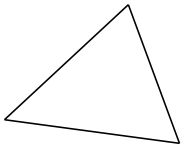

_____

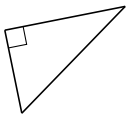

_____

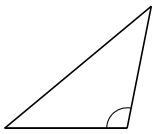

_____

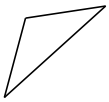

_____

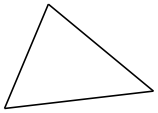

_____

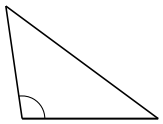

_____

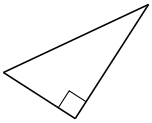

_____

Clasificar Triángulos (D) Respuestas

Clasifique cada triángulo de acuerdo a la medida de sus ángulos.

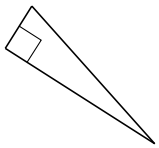

rectángulo

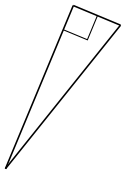

rectángulo

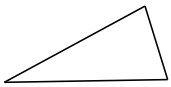

acutángulo

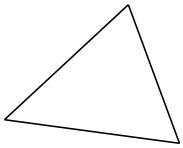

acutángulo

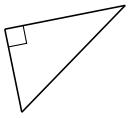

rectángulo

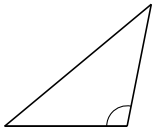

obtusángulo

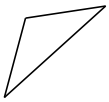

acutángulo

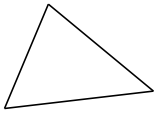

acutángulo

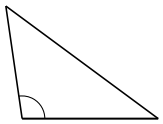

obtusángulo

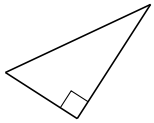

rectángulo