Amplitud y Longitud de Arcos (C)

Nombre: _____ Fecha: _____

Calcule la amplitud angular o la longitud de cada arco.

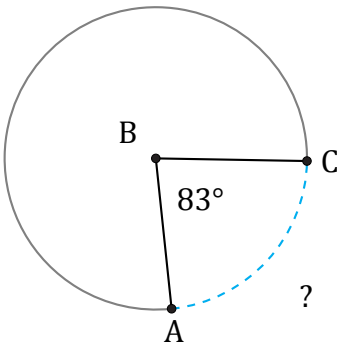

Diámetro = 8 cm

$\overset{\frown}{AC}$ =

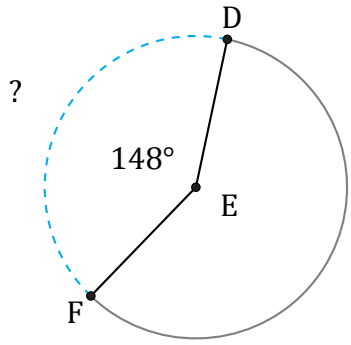

Diámetro = 16 m

$\overset{\frown}{DF}$ =

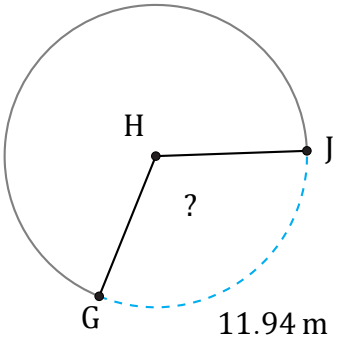

Diámetro = 12 m

∠GHJ =

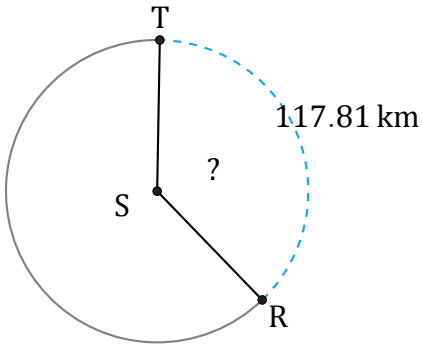

Diámetro = 100 km

∠RST =