Amplitud y Longitud de Arcos (F)

Nombre: _____ Fecha: _____

Calcule la amplitud angular o la longitud de cada arco.

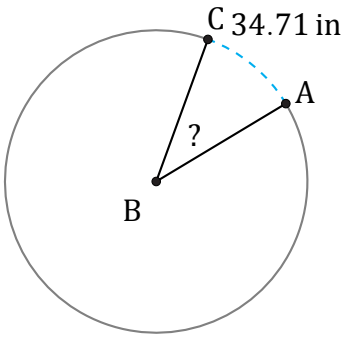

Diámetro = 102 in

∠ABC =

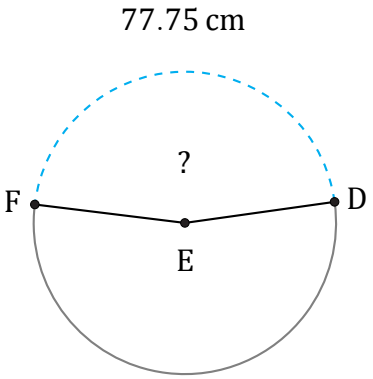

Diámetro = 54 cm

∠DEF =

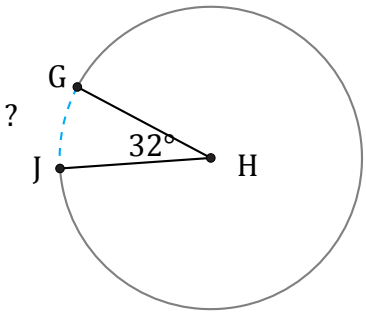

Diámetro = 1804 mi

$\widehat{GJ}$ =

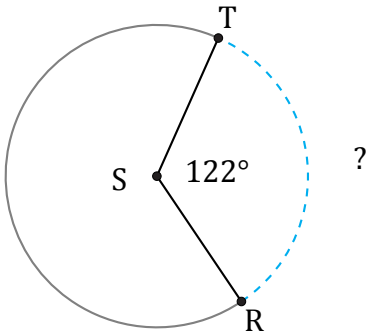

Diámetro = 724 mm

$\widehat{RT}$ =