Amplitud y Longitud de Arcos (A)

Nombre: _____ Fecha: _____

Calcule la amplitud angular o la longitud de cada arco.

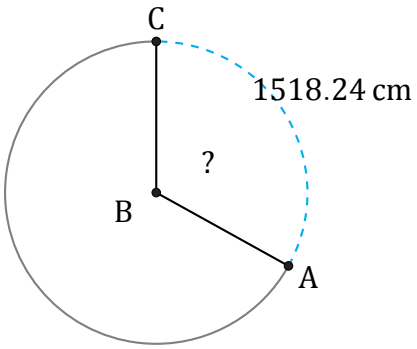

Diámetro = 1462 cm

$\angle ABC =$

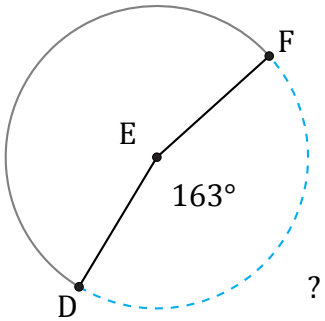

Radio = 2 mm

$\overset{\frown}{DF} =$

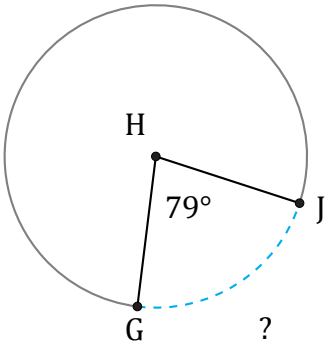

Diámetro = 364 in

$\overset{\frown}{GJ} =$

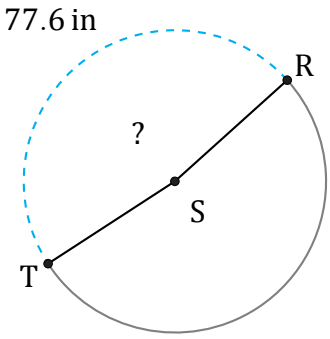

Radio = 26 in

$\angle RST =$