Amplitud y Longitud de Arcos (G)

Nombre: _____ Fecha: _____

Calcule la amplitud angular o la longitud de cada arco.

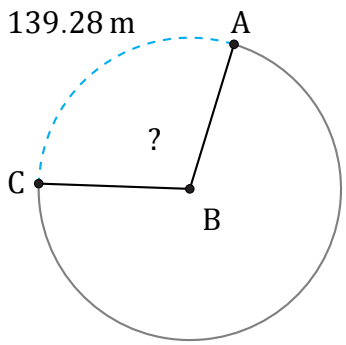

Diámetro = 152 m

$\angle ABC$ =

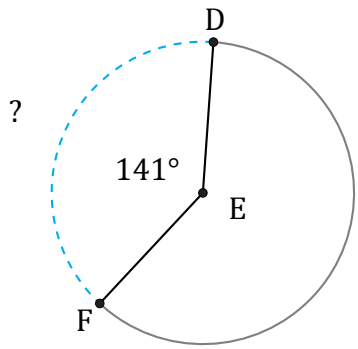

Radio = 7 AU

$\overset{\frown}{DF}$ =

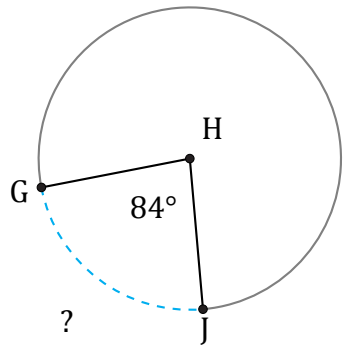

Diámetro = 10 AU

$\overset{\frown}{GJ}$ =

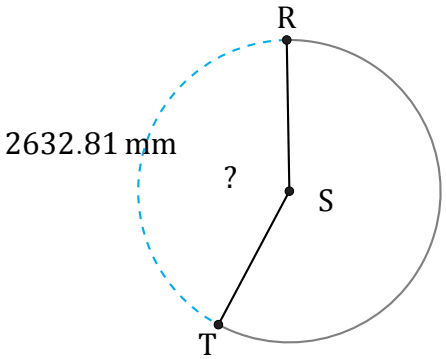

Radio = 999 mm

$\angle RST$ =