Longitud de Arcos (H)

Nombre: _____ Fecha: _____

Calcule la longitud de cada arco.

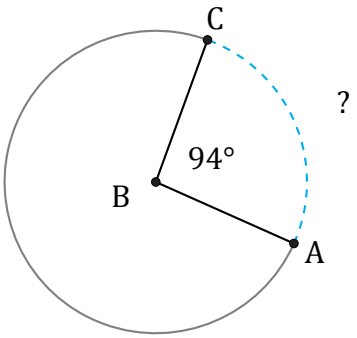

Diámetro = 14 cm

$\overset{\frown}{AC}$ =

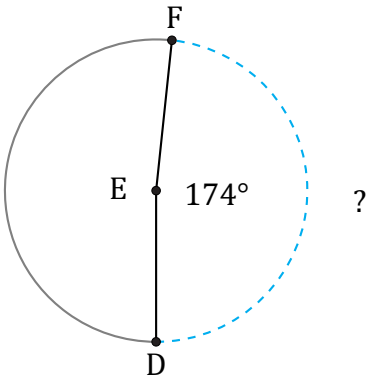

Diámetro = 12 m

$\overset{\frown}{DF}$ =

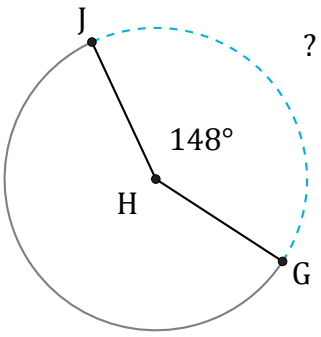

Diámetro = 54 mm

$\overset{\frown}{GJ}$ =

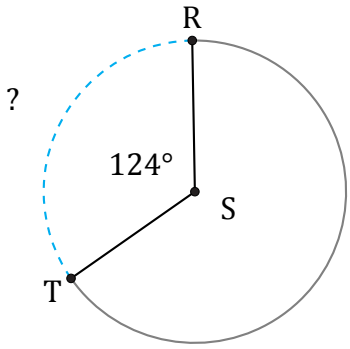

Diámetro = 124 m

$\overset{\frown}{RT}$ =