Longitud de Arcos (F)

Nombre: _____ Fecha: _____

Calcule la longitud de cada arco.

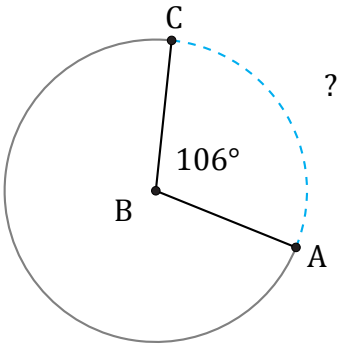

Radio = 32 ft

$\overset{\frown}{AC}$ =

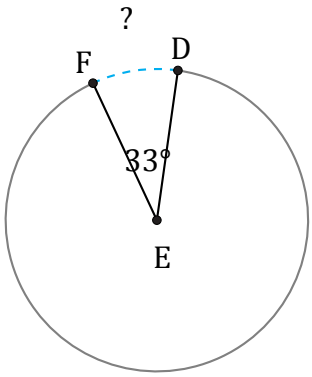

Radio = 2 cm

$\overset{\frown}{DF}$ =

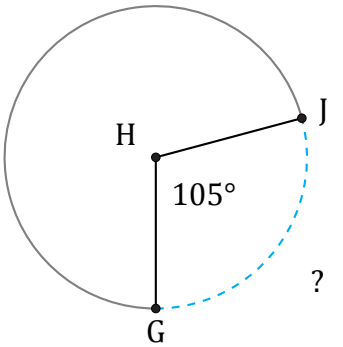

Radio = 178 mm

$\overset{\frown}{GJ}$ =

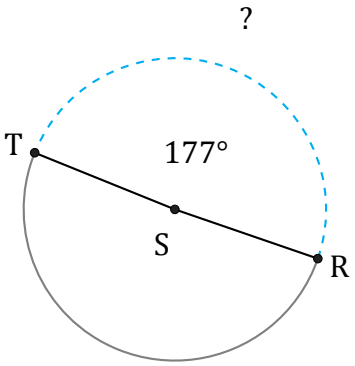

Radio = 205 m

$\overset{\frown}{RT}$ =