Área y Perímetro de Rectángulos (E)

Halle el área y el perímetro de cada rectángulo.

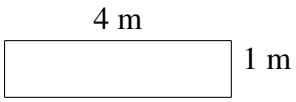



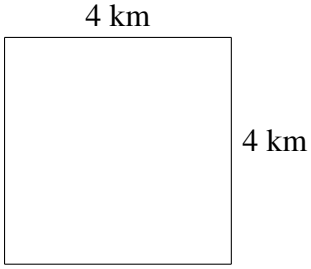



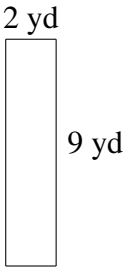

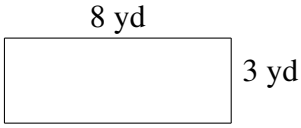

Área y Perímetro de Rectángulos (E) Respuestas

Halle el área y el perímetro de cada rectángulo.

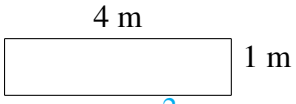

A = 4 m^2
P = 10 m



A = 2 mi^2
P = 6 mi

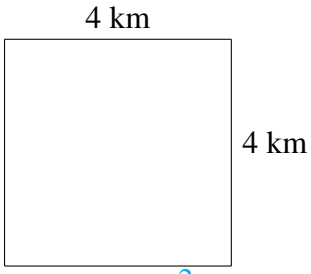

A = 16 km^2
P = 16 km



A = 3 m^2
P = 8 m



A = 18 yd^2
P = 22 yd

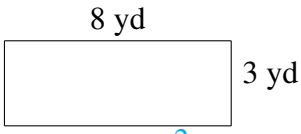

A = 24 yd^2
P = 22 yd