Área y Perímetro de Rectángulos (G)

Halle el área y el perímetro de cada rectángulo.

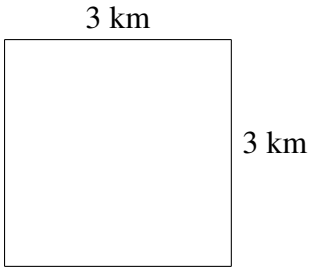

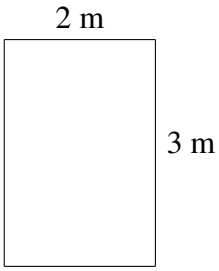

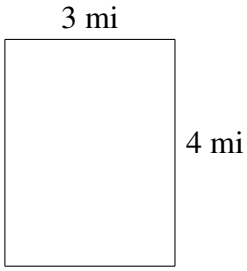

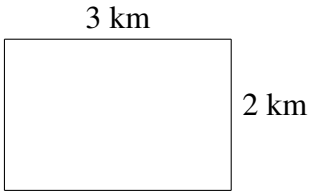





Área y Perímetro de Rectángulos (G) Respuestas

Halle el área y el perímetro de cada rectángulo.

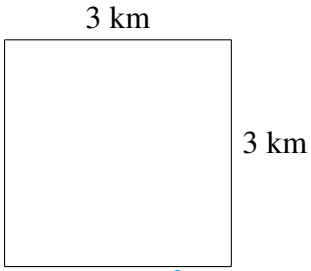

A = 9 km^2
P = 12 km

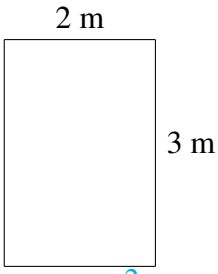

A = 6 m^2
P = 10 m

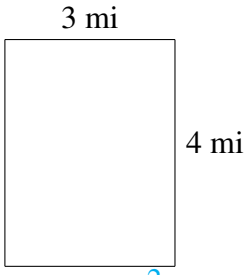

A = 12 mi^2
P = 14 mi

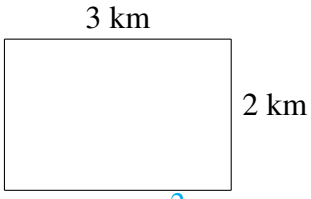

A = 6 km^2
P = 10 km

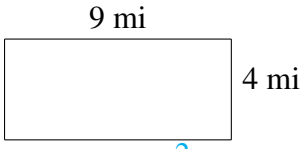

A = 36 mi^2
P = 26 mi

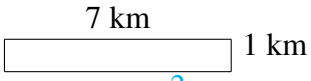

A = 7 km^2
P = 16 km