Área y Perímetro de Trapezoides (A)

Halle el área y perímetro de cada trapezoide.

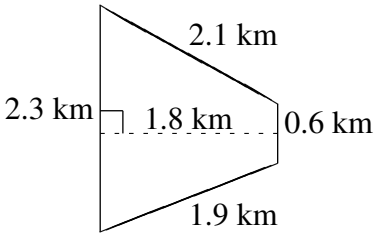

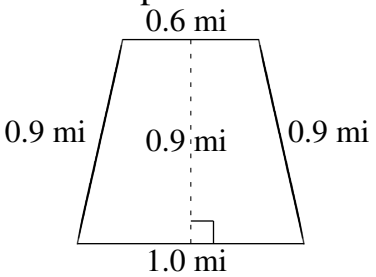

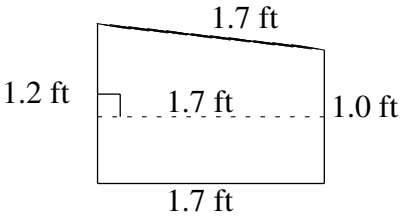

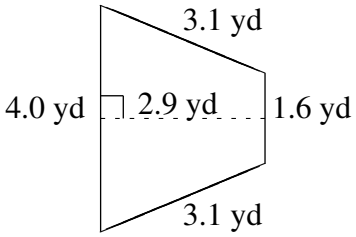

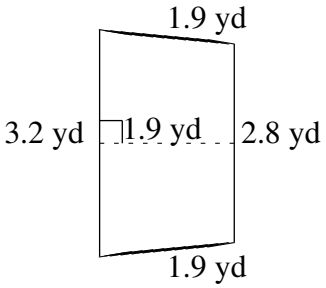

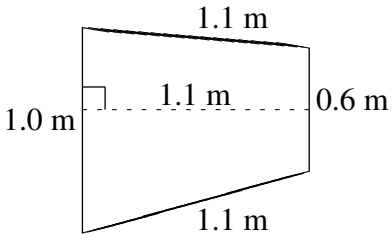

Área y Perímetro de Trapezoides (A) Respuestas

Halle el área y perímetro de cada trapezoide.

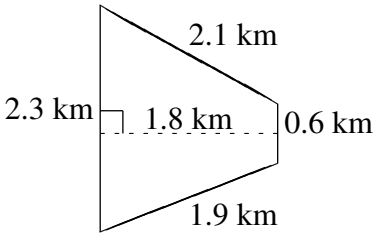

A = 2.61 km^2
P = 6.9 km

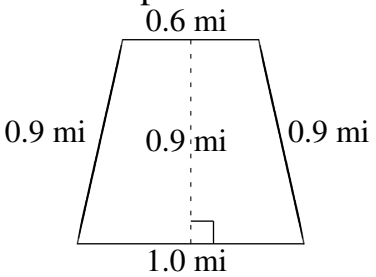

A = 0.72 mi^2
P = 3.4 mi

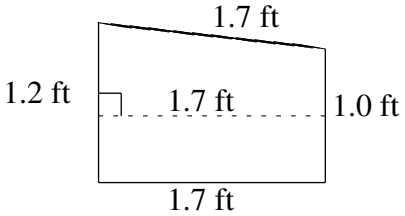

A = 1.87 ft^2
P = 5.6 ft

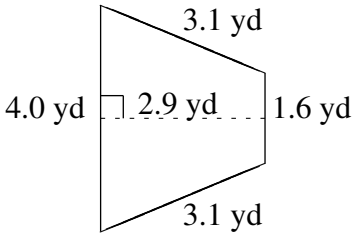

A = 8.12 yd^2
P = 11.8 yd

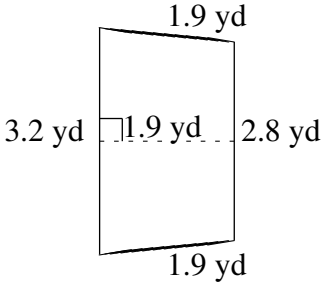

A = 5.70 yd^2
P = 9.8 yd

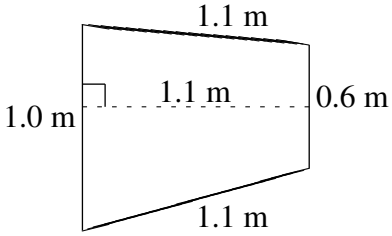

A = 0.88 m^2
P = 3.8 m

Área y Perímetro de Trapezoides (B)

Halle el área y perímetro de cada trapezoide.

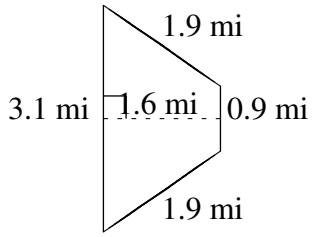

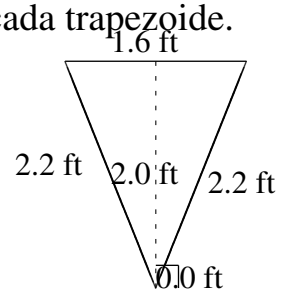

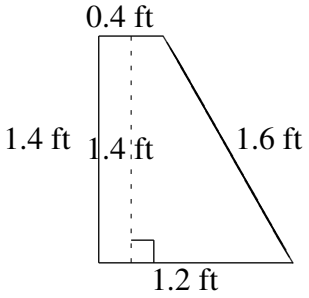

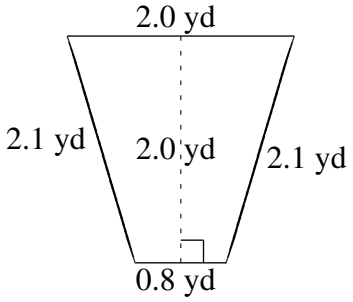

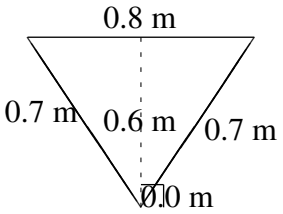

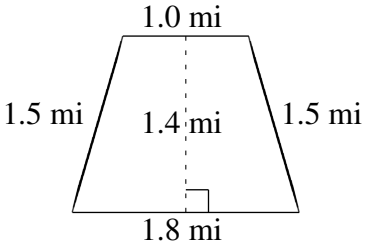

Área y Perímetro de Trapezoides (B) Respuestas

Halle el área y perímetro de cada trapezoide.

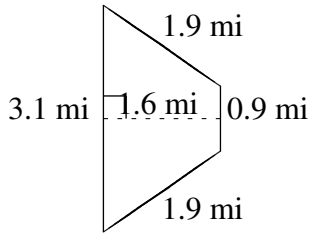

A = 3.20 mi^2
P = 7.8 mi

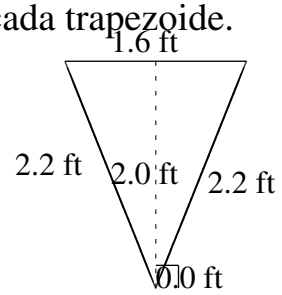

A = 1.60 ft^2
P = 6.0 ft

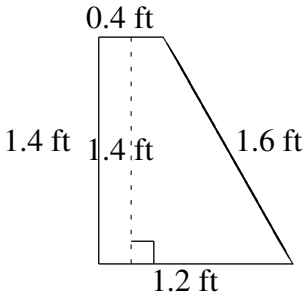

A = 1.12 ft^2
P = 4.6 ft

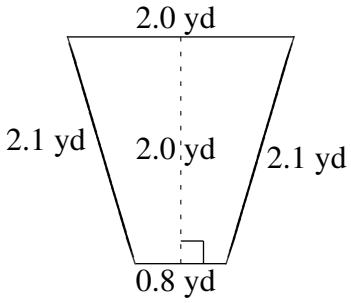

A = 2.80 yd^2
P = 7.0 yd

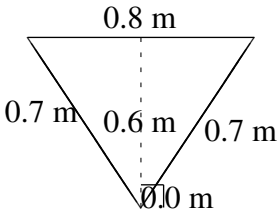

A = 0.24 m^2
P = 2.2 m

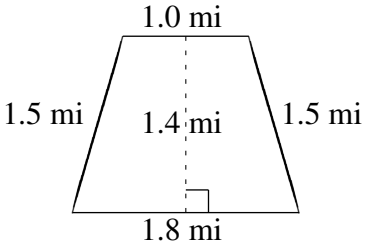

A = 1.96 mi^2
P = 5.8 mi

Área y Perímetro de Trapezoides (C)

Halle el área y perímetro de cada trapezoide.

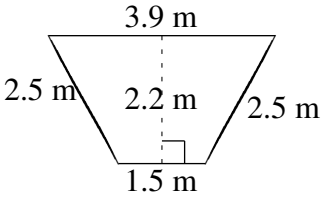

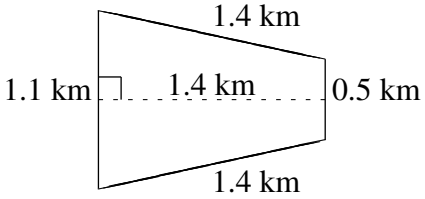

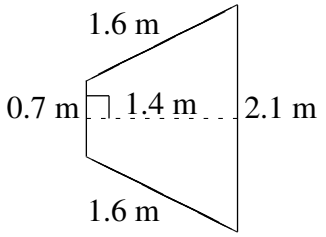

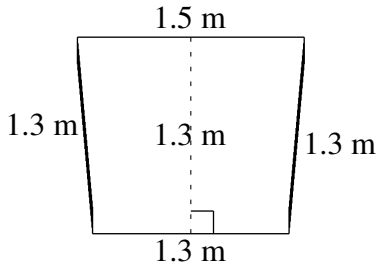

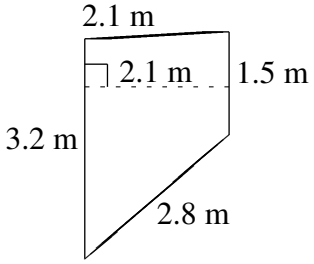

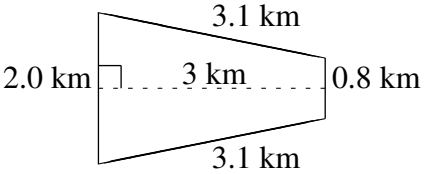

Área y Perímetro de Trapezoides (C) Respuestas

Halle el área y perímetro de cada trapezoide.

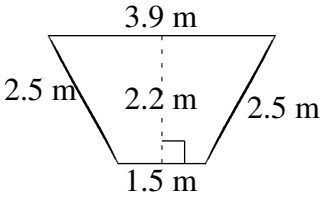

A = 5.94 m^2
P = 10.4 m

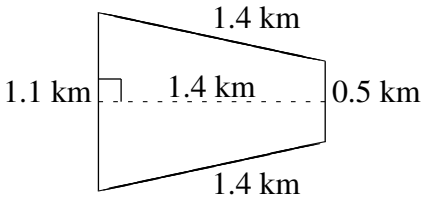

A = 1.12 km^2
P = 4.4 km

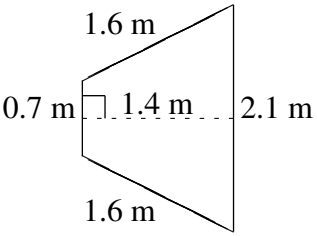

A = 1.96 m^2
P = 6.0 m

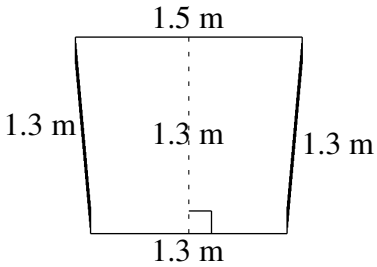

A = 1.82 m^2
P = 5.4 m

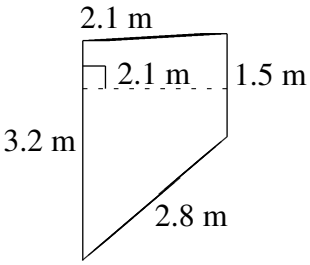

A = 4.935 m^2
P = 9.6 m

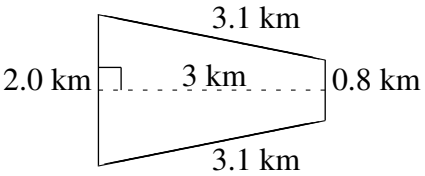

A = 4.2 km^2
P = 9.0 km

Área y Perímetro de Trapezoides (D)

Halle el área y perímetro de cada trapezoide.

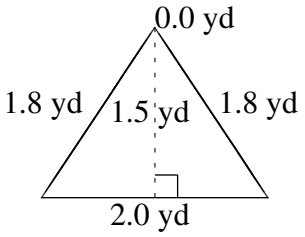

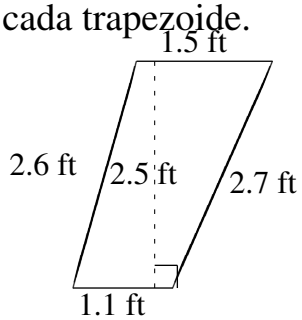

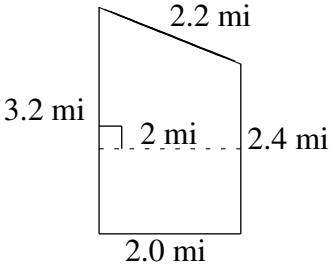

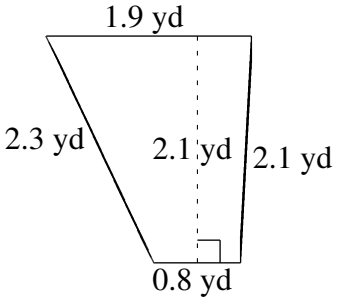

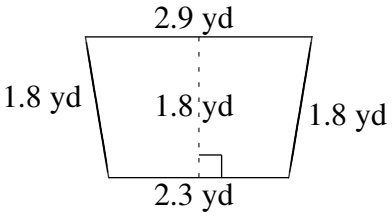

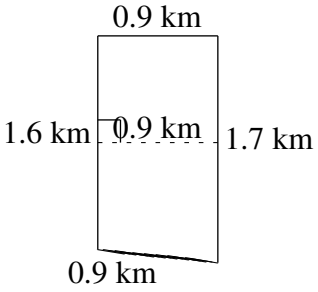

Área y Perímetro de Trapezoides (D) Respuestas

Halle el área y perímetro de cada trapezoide.

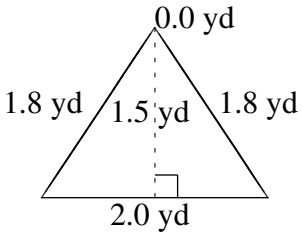

A = 1.50 yd^2
P = 5.6 yd

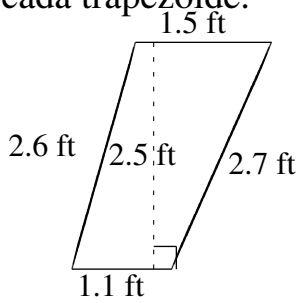

A = 3.25 ft^2
P = 7.9 ft

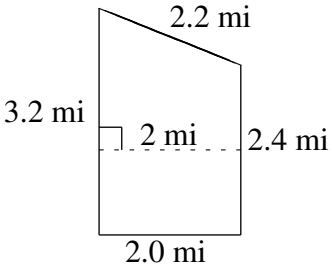

A = 5.6 mi^2
P = 9.8 mi

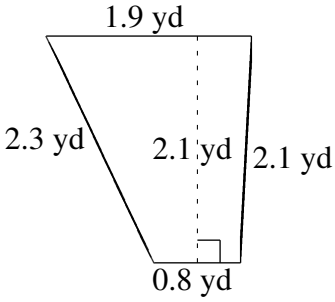

A = 2.835 yd^2
P = 7.1 yd

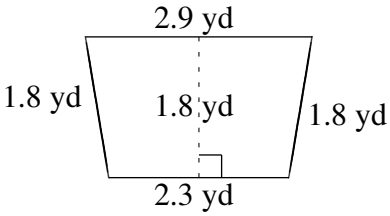

A = 4.68 yd^2
P = 8.8 yd

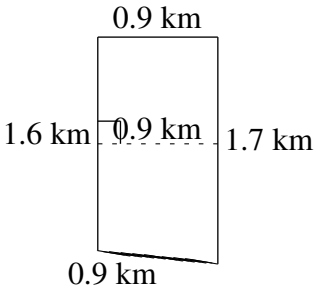

A = 1.485 km^2
P = 5.1 km

Área y Perímetro de Trapezoides (E)

Halle el área y perímetro de cada trapezoide.

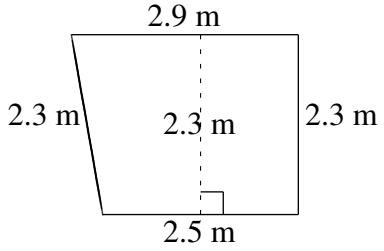

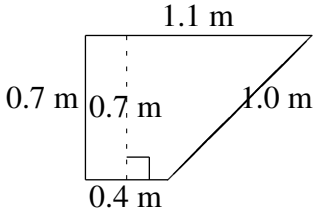

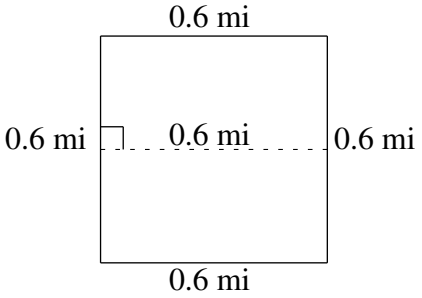

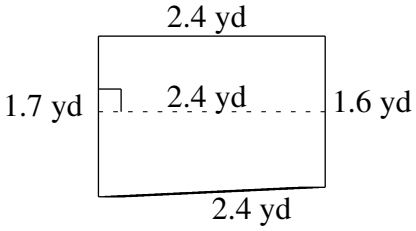

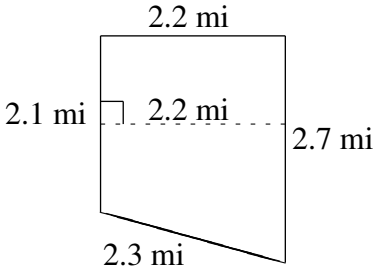

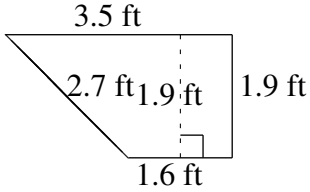

Área y Perímetro de Trapezoides (E) Respuestas

Halle el área y perímetro de cada trapezoide.

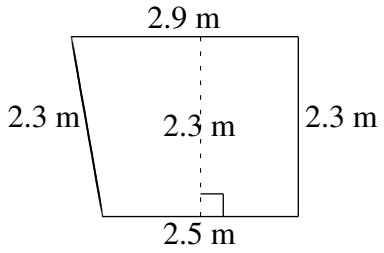

A = 6.21 m^2
P = 10.0 m

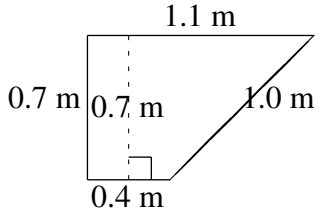

A = 0.525 m^2
P = 3.2 m

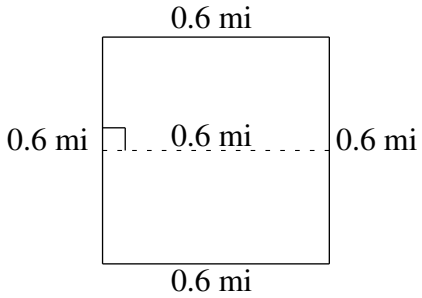

A = 0.36 mi^2
P = 2.4 mi

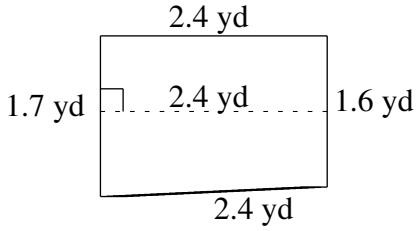

A = 3.96 yd^2
P = 8.1 yd

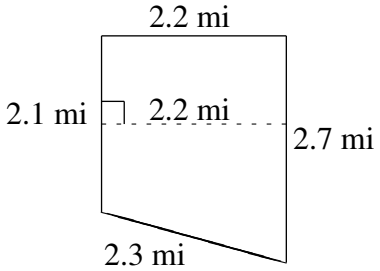

A = 5.28 mi^2
P = 9.3 mi

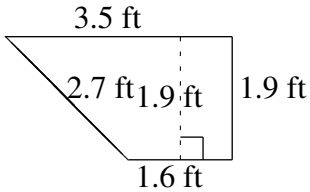

A = 4.845 ft^2
P = 9.7 ft

Área y Perímetro de Trapezoides (F)

Halle el área y perímetro de cada trapezoide.

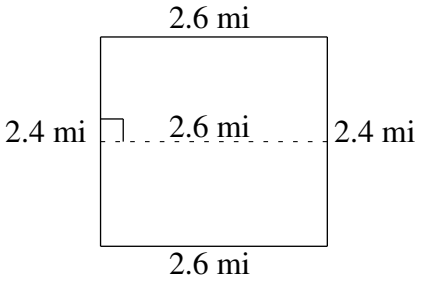

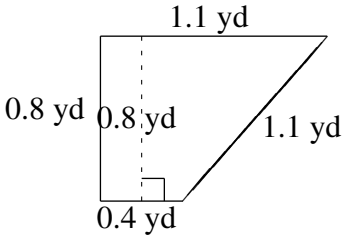

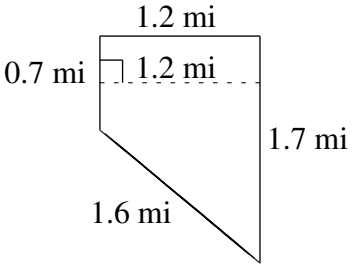

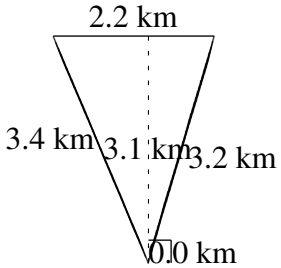

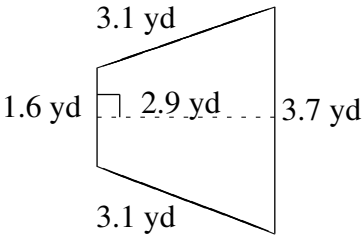

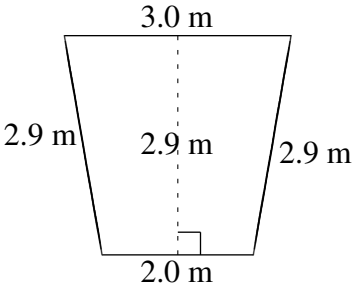

Área y Perímetro de Trapezoides (F) Respuestas

Halle el área y perímetro de cada trapezoide.

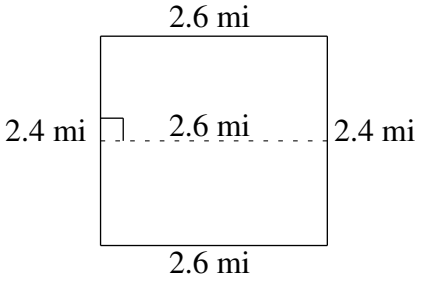

A = 6.24 mi^2
P = 10.0 mi

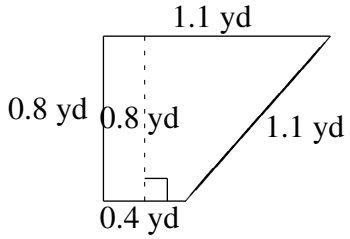

A = 0.60 yd^2
P = 3.4 yd

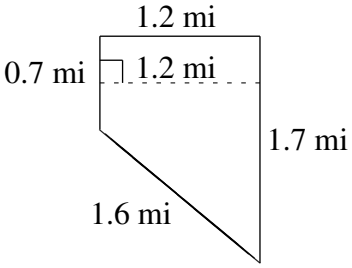

A = 1.44 mi^2
P = 5.2 mi

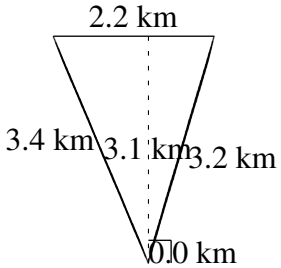

A = 3.41 km^2
P = 8.8 km

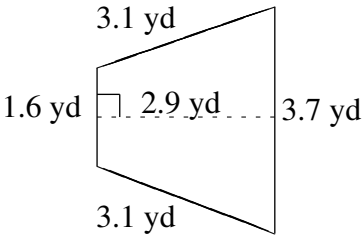

A = 7.685 yd^2
P = 11.5 yd

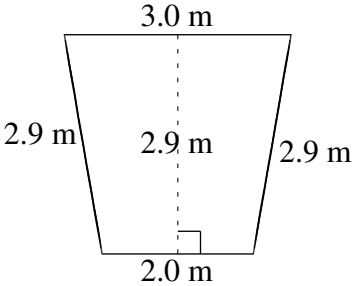

A = 7.25 m^2
P = 10.8 m

Área y Perímetro de Trapezoides (G)

Halle el área y perímetro de cada trapezoide.

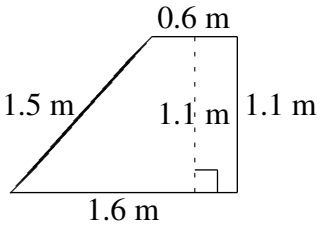

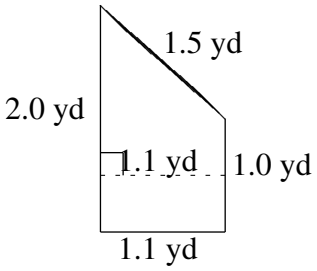

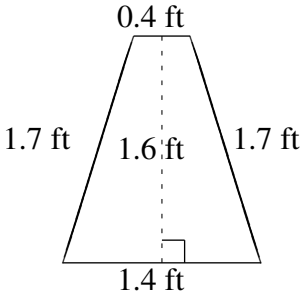

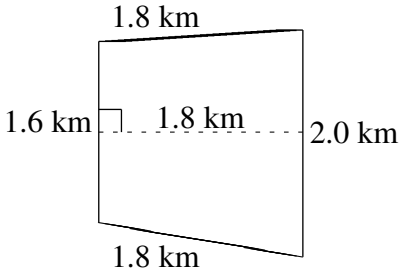

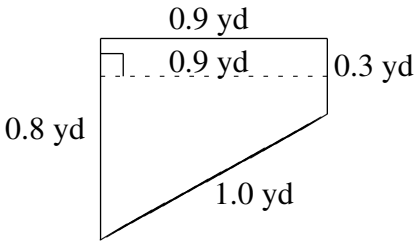

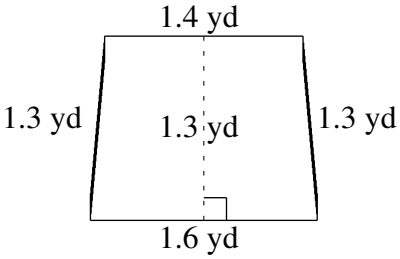

Área y Perímetro de Trapezoides (G) Respuestas

Halle el área y perímetro de cada trapezoide.

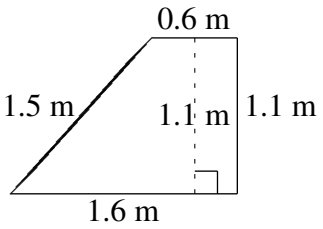

A = 1.21 m^2
P = 4.8 m

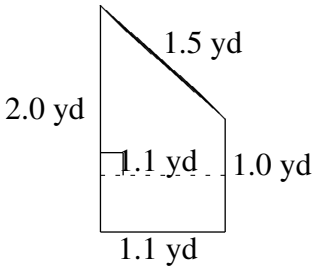

A = 1.65 yd^2
P = 5.6 yd

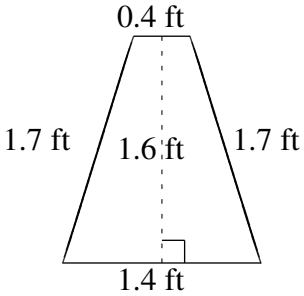

A = 1.44 ft^2
P = 5.2 ft

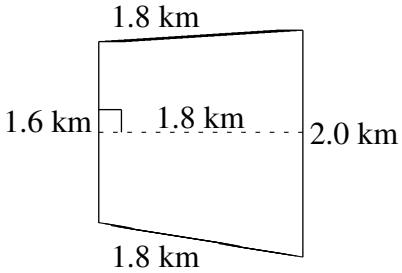

A = 3.24 km^2
P = 7.2 km

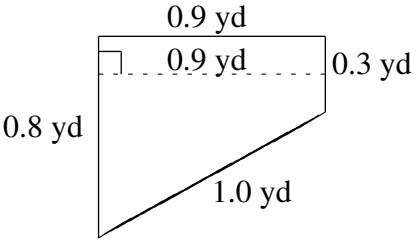

A = 0.495 yd^2
P = 3.0 yd

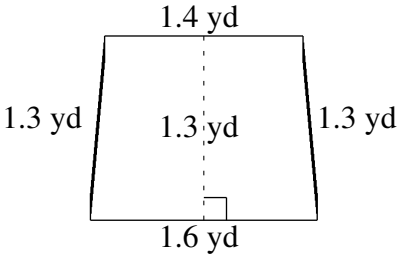

A = 1.95 yd^2
P = 5.6 yd

Área y Perímetro de Trapezoides (H)

Halle el área y perímetro de cada trapezoide.

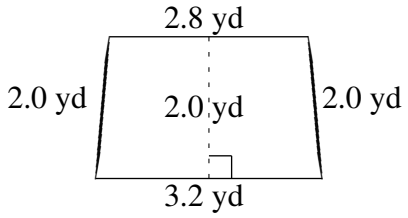

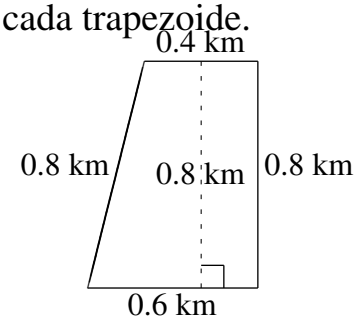

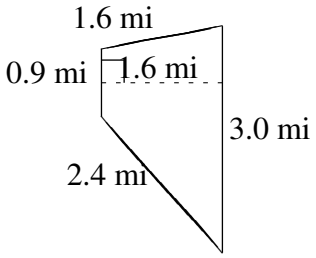

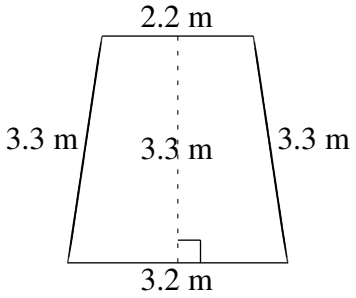

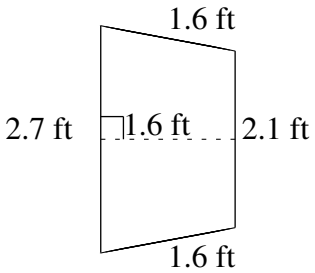

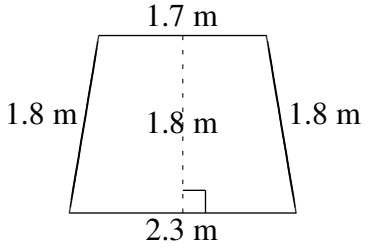

Área y Perímetro de Trapezoides (H) Respuestas

Halle el área y perímetro de cada trapezoide.

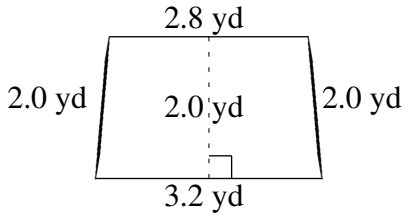

A = 6.00 yd^2
P = 10.0 yd

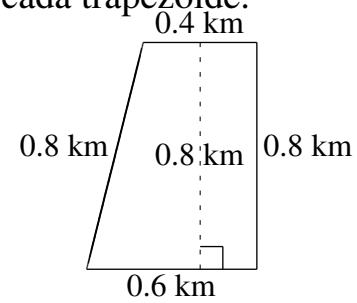

A = 0.40 km^2
P = 2.6 km

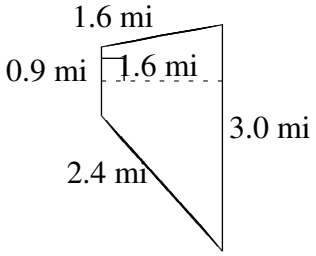

A = 3.12 mi^2
P = 7.9 mi

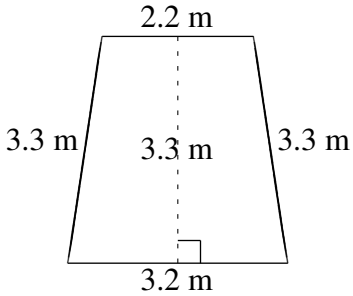

A = 8.91 m^2
P = 12.0 m

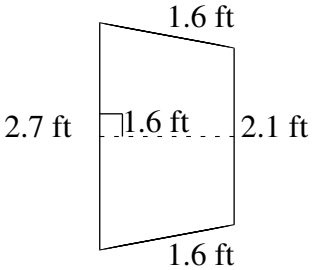

A = 3.84 ft^2
P = 8.0 ft

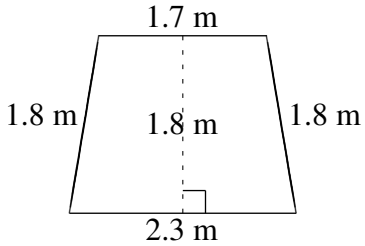

A = 3.60 m^2
P = 7.6 m

Área y Perímetro de Trapezoides (I)

Halle el área y perímetro de cada trapezoide.

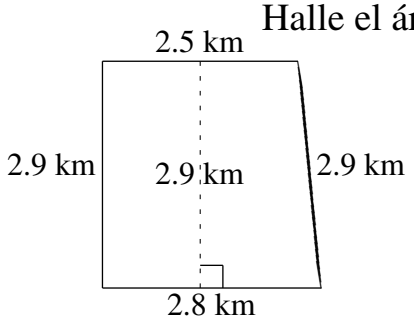

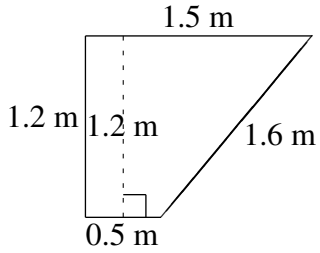

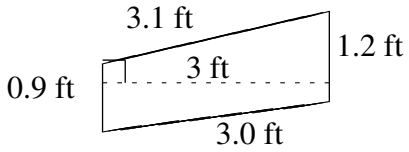

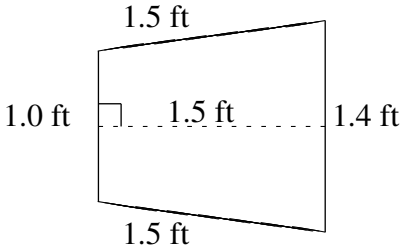

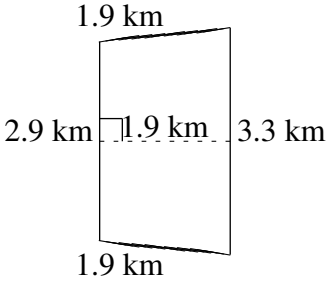

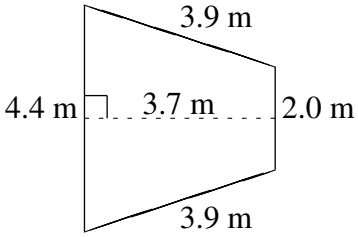

Área y Perímetro de Trapezoides (I) Respuestas

Halle el área y perímetro de cada trapezoide.

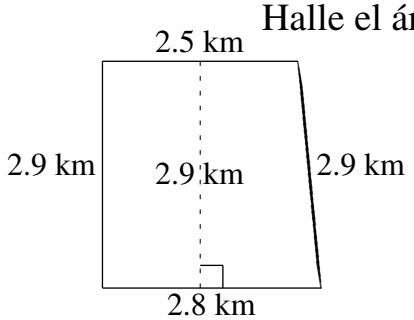

A = 7.685 km^2
P = 11.1 km

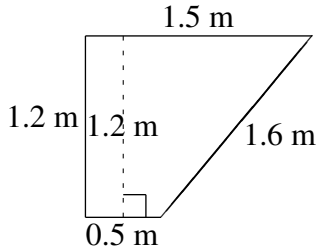

A = 1.20 m^2
P = 4.8 m

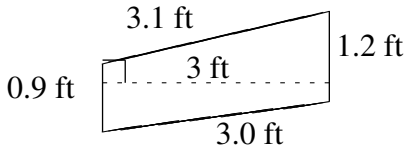

A = 3.15 ft^2
P = 8.2 ft

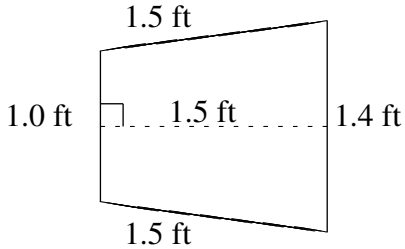

A = 1.80 ft^2
P = 5.4 ft

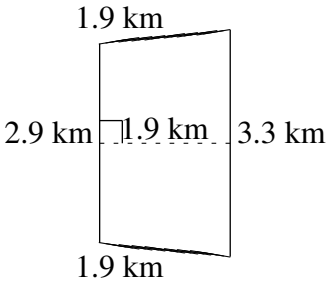

A = 5.89 km^2
P = 10.0 km

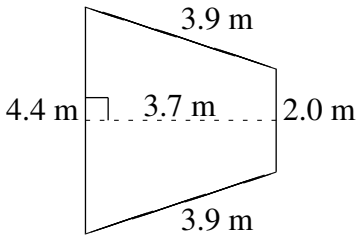

A = 11.84 m^2
P = 14.2 m

Área y Perímetro de Trapezoides (J)

Halle el área y perímetro de cada trapezoide.

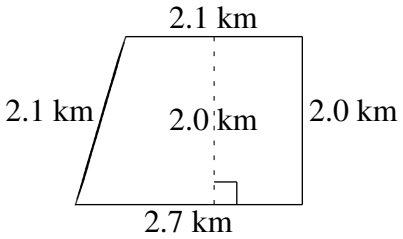

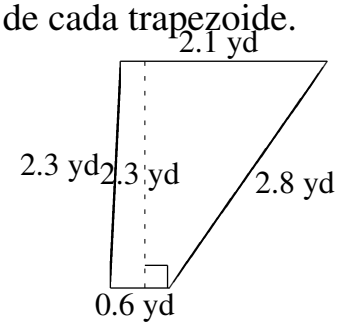

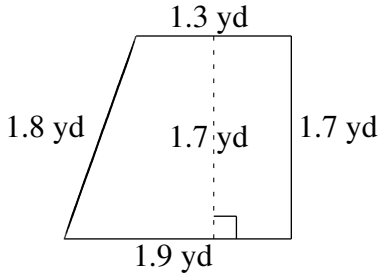

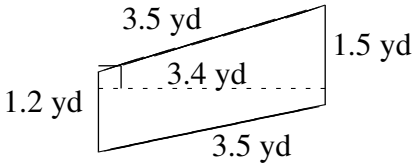

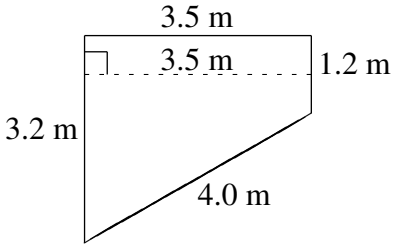

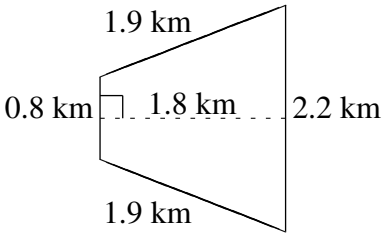

Área y Perímetro de Trapezoides (J) Respuestas

Halle el área y perímetro de cada trapezoide.

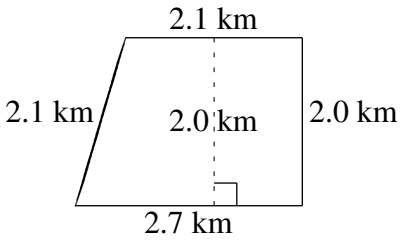

A = 4.80 km^2
P = 8.9 km

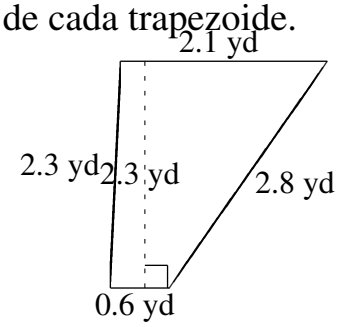

A = 3.105 yd^2
P = 7.8 yd

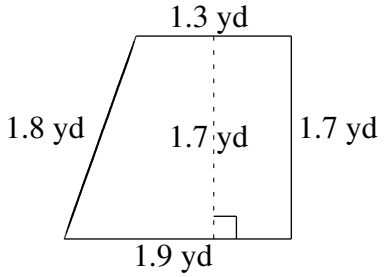

A = 2.72 yd^2
P = 6.7 yd

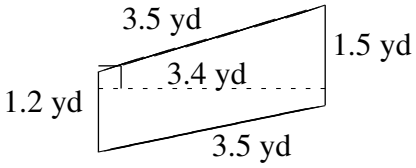

A = 4.59 yd^2
P = 9.7 yd

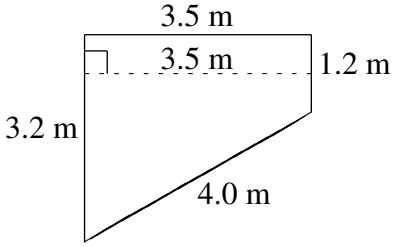

A = 7.70 m^2
P = 11.9 m

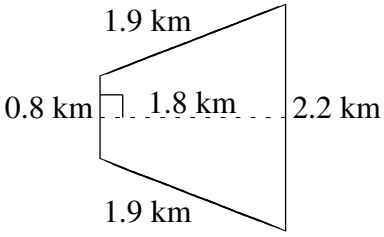

A = 2.70 km^2
P = 6.8 km