Multiplicación por Celosía (A)

Use la multiplicación por celosía para hallar cada producto.

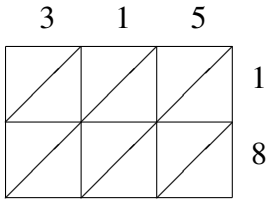

$315 \times 18 =$ _____

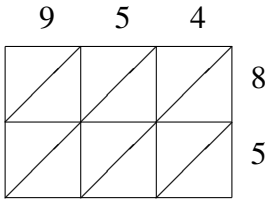

$954 \times 85 =$ _____

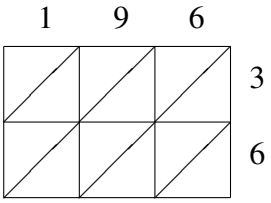

$196 \times 36 =$ _____

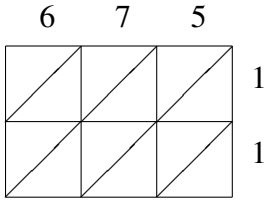

$675 \times 11 =$ _____

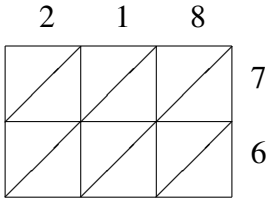

$218 \times 76 =$ _____

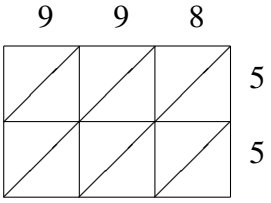

$998 \times 55 =$ _____

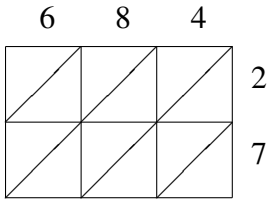

$684 \times 27 =$ _____

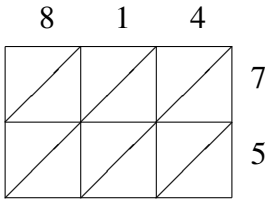

$814 \times 75 =$ _____

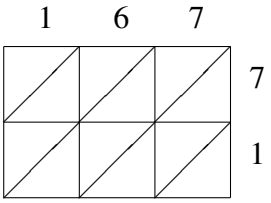

$167 \times 71 =$ _____

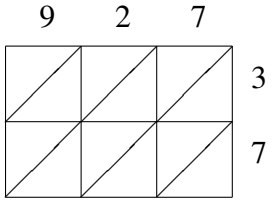

$927 \times 37 =$ _____

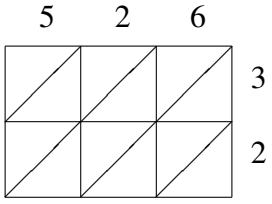

$526 \times 32 =$ _____

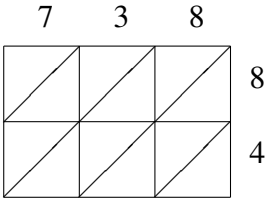

$738 \times 84 =$ _____