Sumar y Restar en Rectas Numéricas (J)

Use las rectas numéricas para calcular cada suma o diferencia.

1. $8 + 12 =$ ____

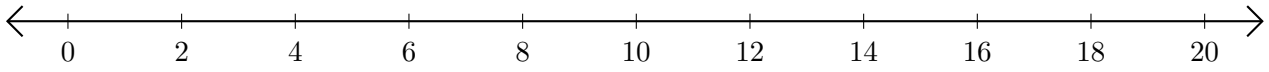

2. $8 - 4 =$ ___

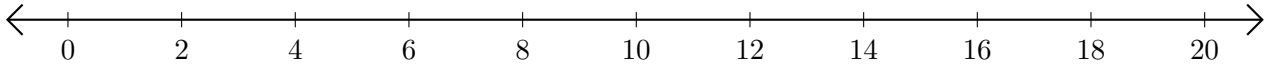

3. $6 + 8 =$ ____

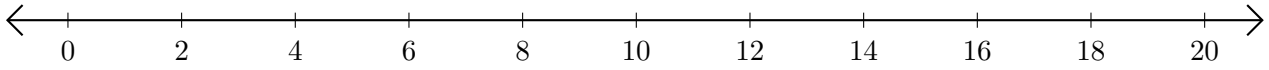

4. $20 - 16 =$ ___

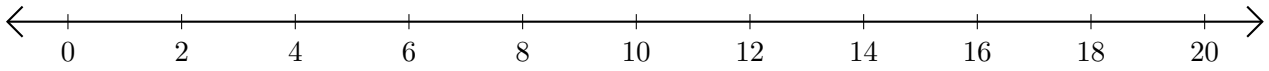

5. $6 - 2 =$ ___

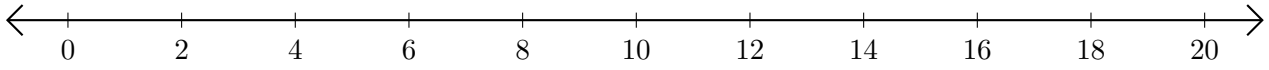

Sumar y Restar en Rectas Numéricas (J) Respuestas

Use las rectas numéricas para calcular cada suma o diferencia.

1. $8 + 12 =$ 20

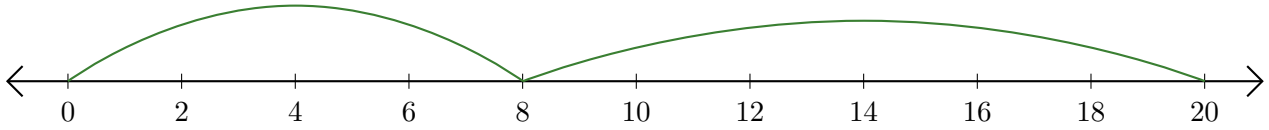

2. $8 - 4 =$ 4

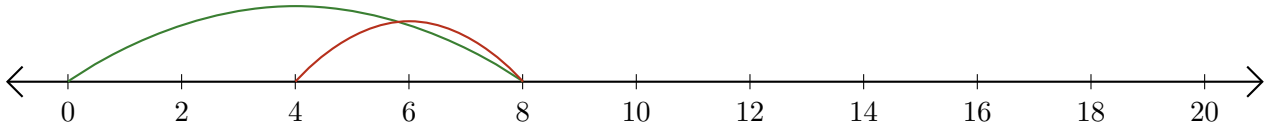

3. $6 + 8 =$ 14

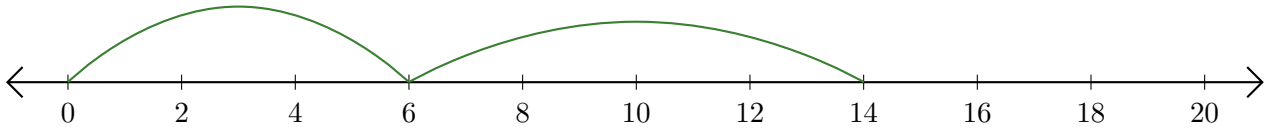

4. $20 - 16 =$ 4

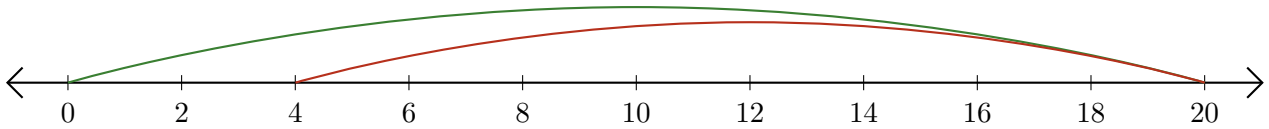
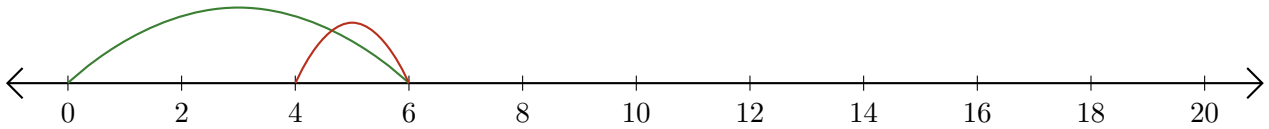
5. $6 - 2 =$ 4