Sumar y Restar en Rectas Numéricas (B)

Use las rectas numéricas para calcular cada suma o diferencia.

1. $30 + 30 =$ ____

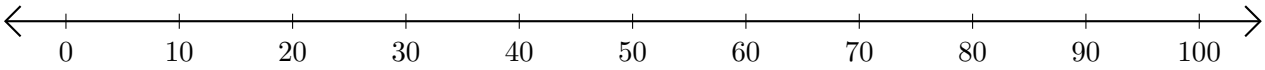

2. $50 - 20 =$ ____

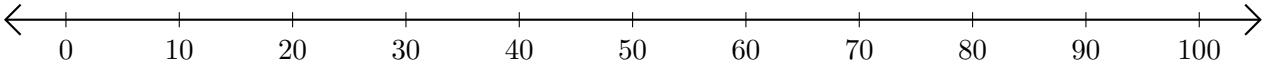

3. $10 + 10 =$ ____

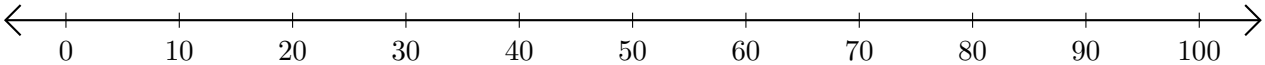

4. $50 - 40 =$ ____

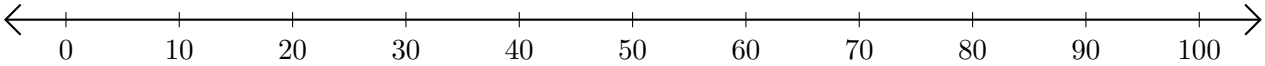

5. $90 - 50 =$ ____

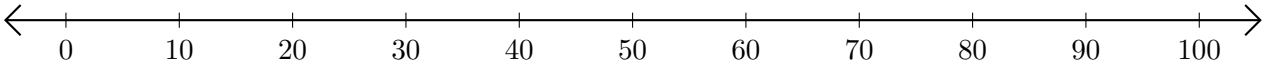

Sumar y Restar en Rectas Numéricas (B) Respuestas

Use las rectas numéricas para calcular cada suma o diferencia.

1. $30 + 30 =$ 60

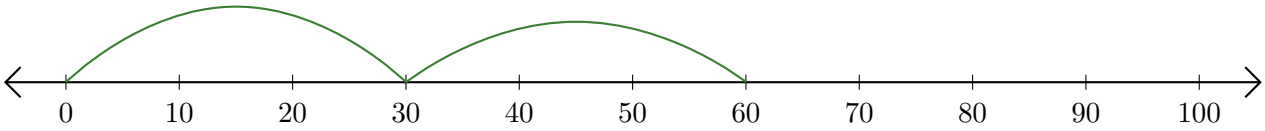

2. $50 - 20 =$ 30

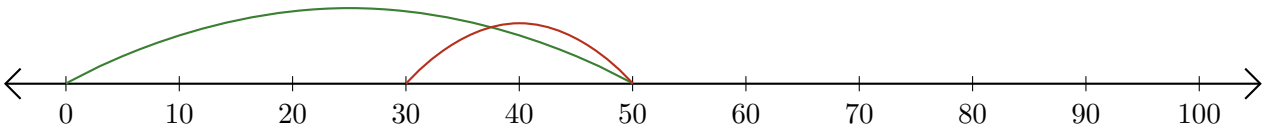

3. $10 + 10 =$ 20

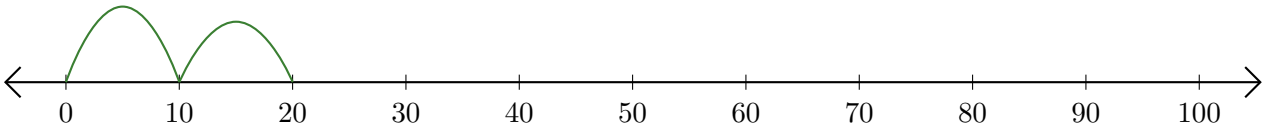

4. $50 - 40 =$ 10

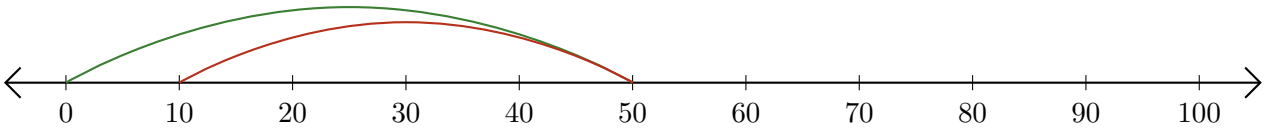
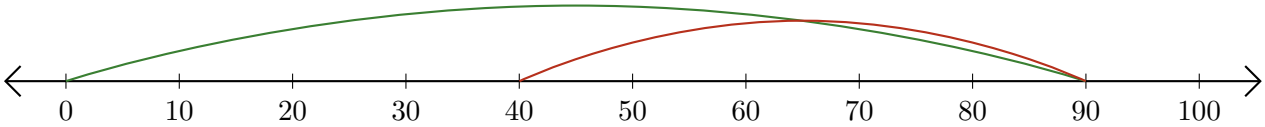
5. $90 - 50 =$ 40