Sumar y Restar en Rectas Numéricas (F)

Use las rectas numéricas para calcular cada suma o diferencia.

1. $56 + 8 =$ ____

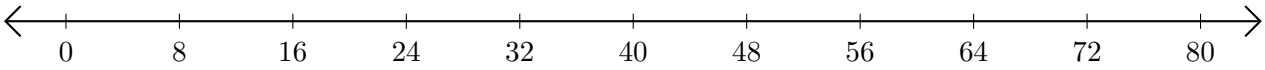

2. $81 - 27 =$ ____

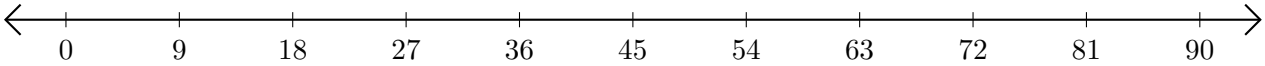

3. $26 + 6 =$ ____

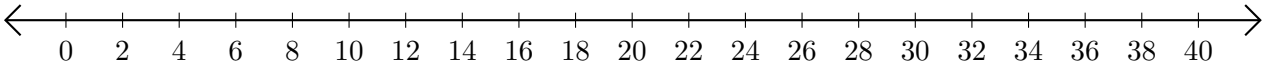

4. $10 - 9 =$ ___

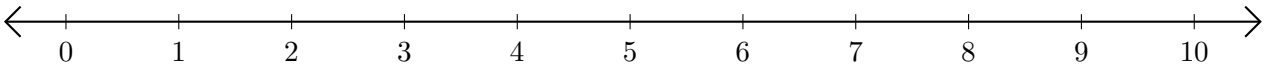

5. $48 - 24 =$ ____

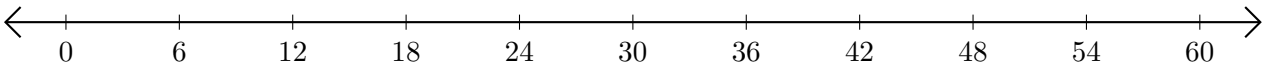

Sumar y Restar en Rectas Numéricas (F) Respuestas

Use las rectas numéricas para calcular cada suma o diferencia.

1. $56 + 8 =$ 64

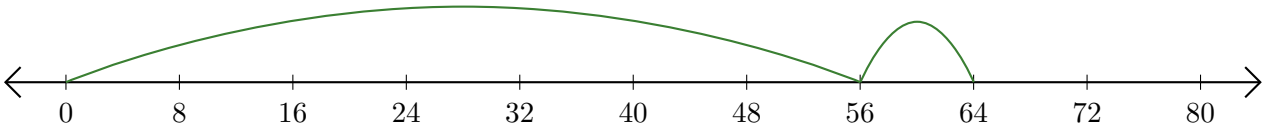

2. $81 - 27 =$ 54

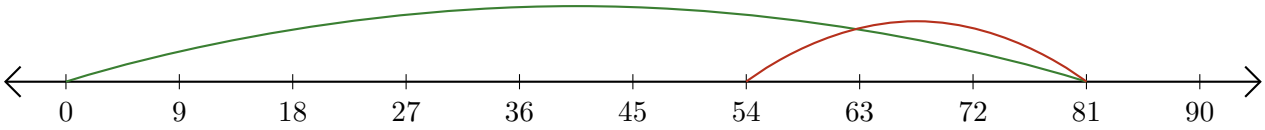

3. $26 + 6 =$ 32

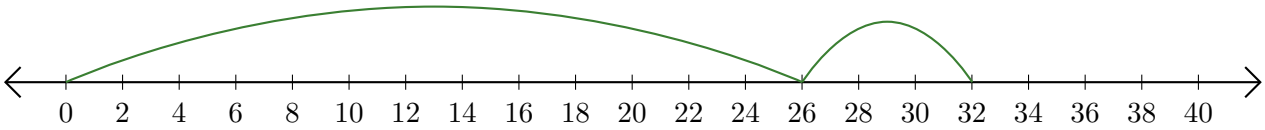

4. $10 - 9 =$ 1

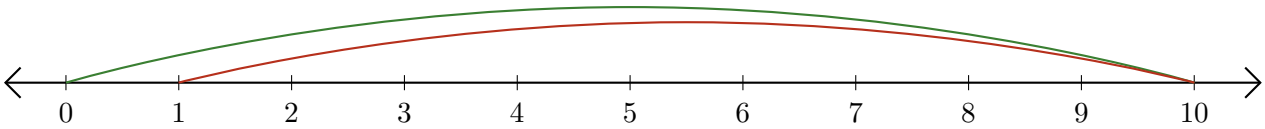
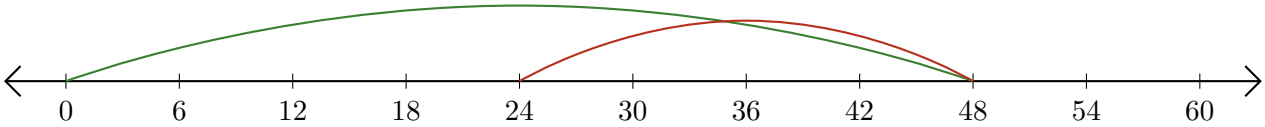
5. $48 - 24 =$ 24