Colocar Números en Rectas Numéricas (C)

Nombre: _____ Fecha: _____ Puntuación: _____

Dibujen una estrella en el lugar de la recta numérica donde se encontraría cada número.

19



29



12

23



42



1



38



32

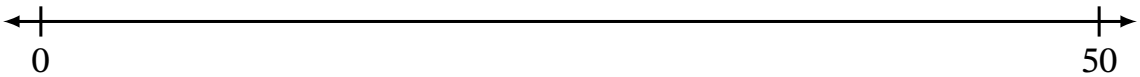

7



47