Colocar Números en Rectas Numéricas (H)

Nombre: _____ Fecha: _____ Puntuación: _____

Dibujen una estrella en el lugar de la recta numérica donde se encontraría cada número.

40


1


22

47


26


42


15


8
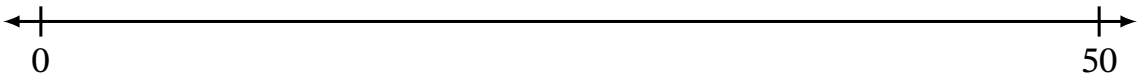

18


31


Colocar Números en Rectas Numéricas (H) Respuestas

Nombre: _____ Fecha: _____ Puntuación: _____

Dibujen una estrella en el lugar de la recta numérica donde se encontraría cada número.

40
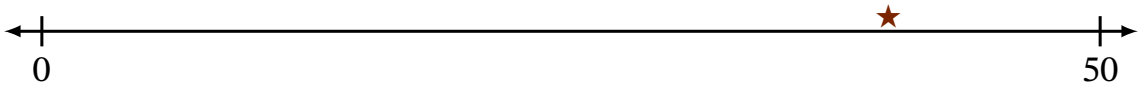

1
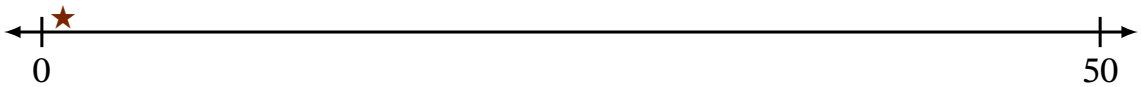

22


47


26

42
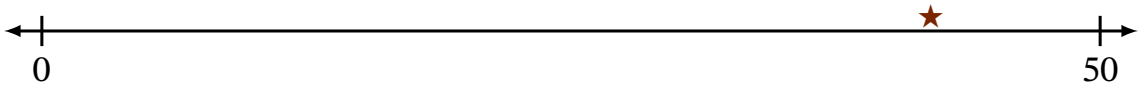

15
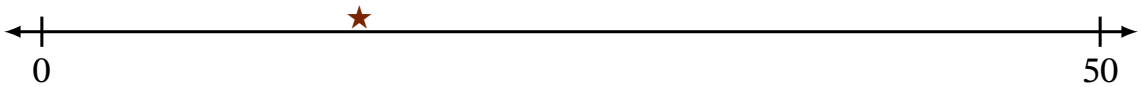

8
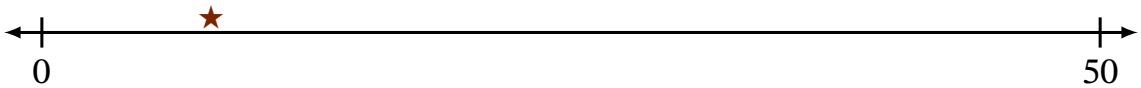

18
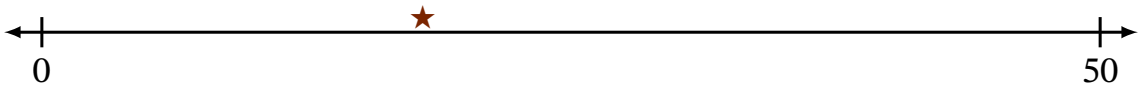
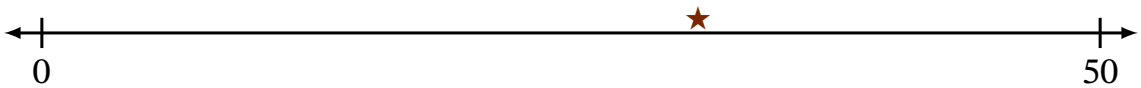
31