Colocar Números en Rectas Numéricas (I)

Nombre: _____ Fecha: _____ Puntuación: _____

Dibujen una estrella en el lugar de la recta numérica donde se encontraría cada número.

3



2



5

7



8



4



1



6

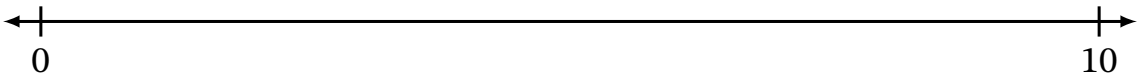

10



9