Colocar Números en Rectas Numéricas (H)

Nombre: _____ Fecha: _____ Puntuación: _____

Dibujen una estrella en el lugar de la recta numérica donde se encontraría cada número.

53



42



10

18



85



63



28



93

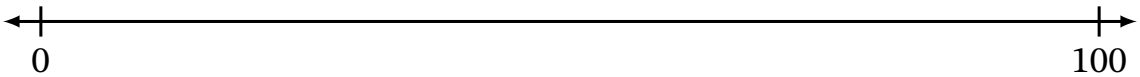

39



79



Colocar Números en Rectas Numéricas (H) Respuestas

Nombre: _____ Fecha: _____ Puntuación: _____

Dibujen una estrella en el lugar de la recta numérica donde se encontraría cada número.

53

42



10



18



85

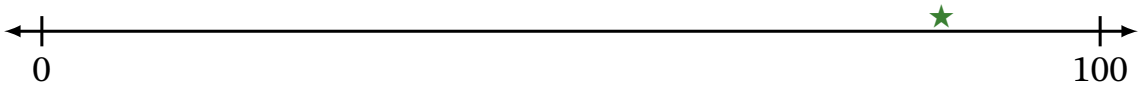

63

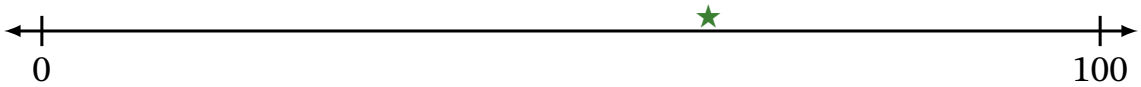

28

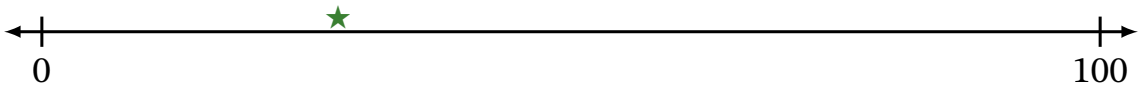

93

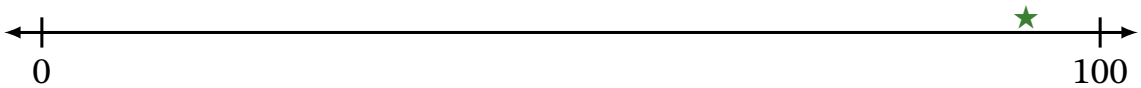

39

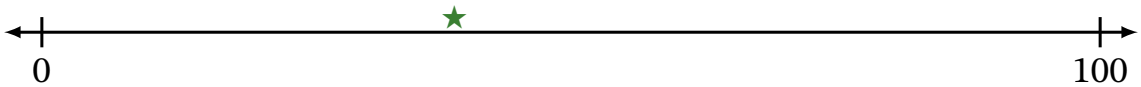
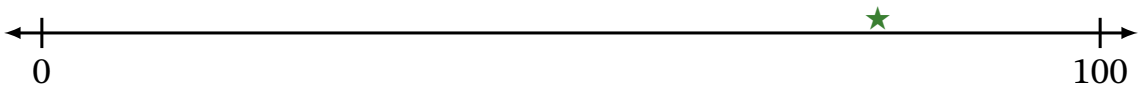
79