Colocar Números en Rectas Numéricas (A)

Nombre: _____ Fecha: _____ Puntuación: _____

Dibujen una estrella en el lugar de la recta numérica donde se encontraría cada número.

559



402



865



911



648



64



160



333



228



740