Colocar Números en Rectas Numéricas (E)

Nombre: _____ Fecha: _____ Puntuación: _____

Dibujen una estrella en el lugar de la recta numérica donde se encontraría cada número.

346



63



935



628

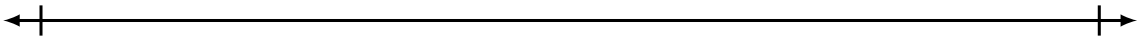

808



790



156



518

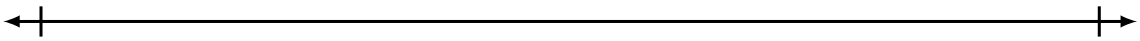

464



281



Colocar Números en Rectas Numéricas (E) Respuestas

Nombre: _____ Fecha: _____ Puntuación: _____

Dibujen una estrella en el lugar de la recta numérica donde se encontraría cada número.

346

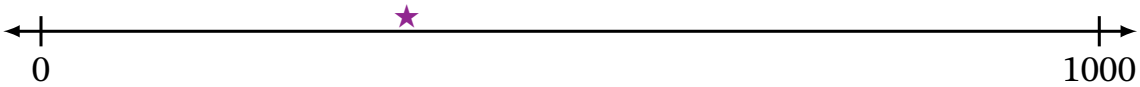

63

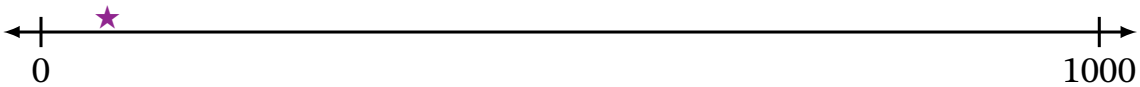

935



628



808

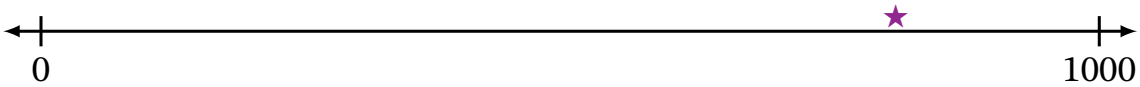

790

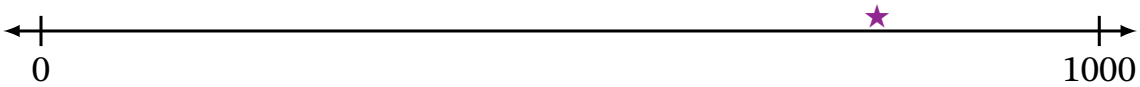

156



518

464
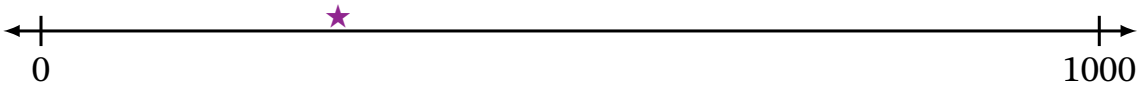
281