Colocar Números en Rectas Numéricas (E)

Nombre: _____ Fecha: _____ Puntuación: _____

Dibujen una estrella en el lugar de la recta numérica donde se encontraría cada número.

346



63



935



628

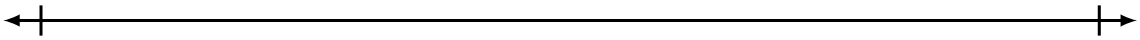

808



790



156



518

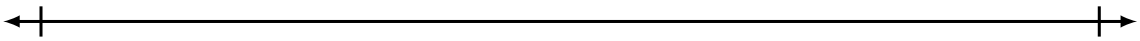

464



281