Colocar Números en Rectas Numéricas (G)

Nombre: _____ Fecha: _____ Puntuación: _____

Dibujen una estrella en el lugar de la recta numérica donde se encontraría cada número.

1000



426



163



10



829



567



663



395



702



213



Colocar Números en Rectas Numéricas (G) Respuestas

Nombre: _____ Fecha: _____ Puntuación: _____

Dibujen una estrella en el lugar de la recta numérica donde se encontraría cada número.

1000

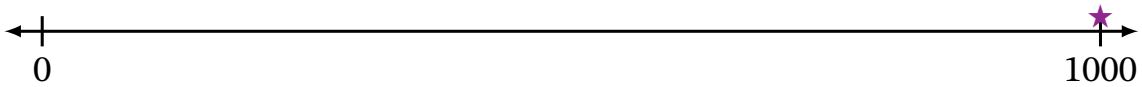

426

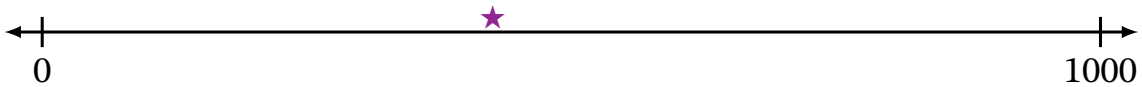

163



10



829

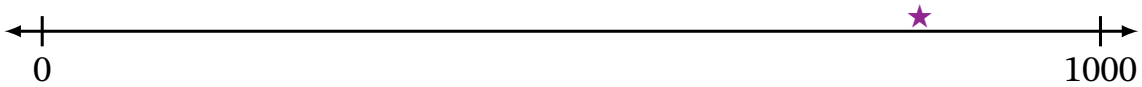

567

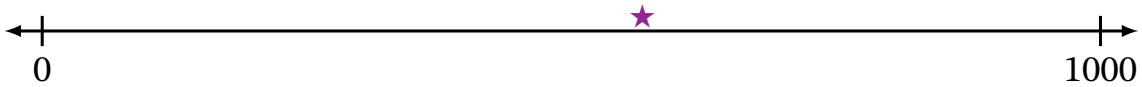

663

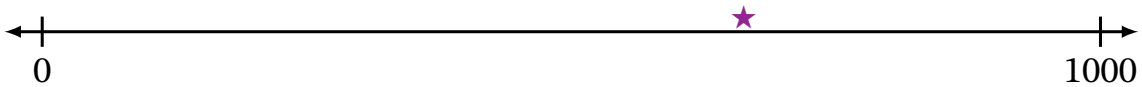

395

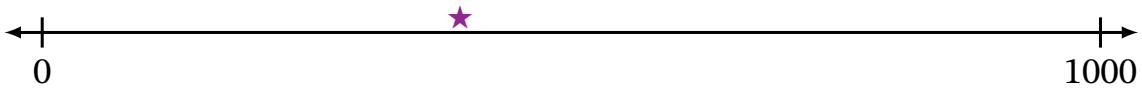

702

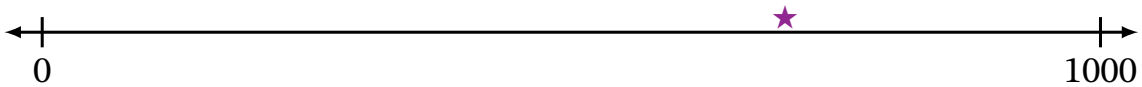
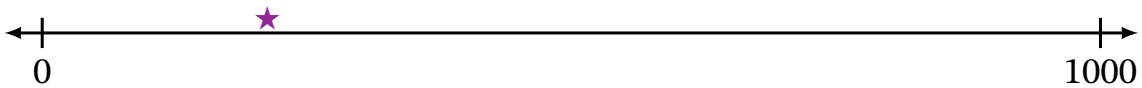
213