Colocar Números en Rectas Numéricas (G)

Nombre: _____ Fecha: _____ Puntuación: _____

Dibujen una estrella en el lugar de la recta numérica donde se encontraría cada número.

1000



426



163



10



829



567



663



395



702



213