Colocar Números en Rectas Numéricas (I)

Nombre: _____ Fecha: _____ Puntuación: _____

Dibujen una estrella en el lugar de la recta numérica donde se encontraría cada número.

843



943



780



230



686



147



70



467



382



596