Colocar Números en Rectas Numéricas (A)

Nombre: _____ Fecha: _____ Puntuación: _____

Dibujen una estrella en el lugar de la recta numérica donde se encontraría cada número.

559



402



865



911



648



64



160



333



228



740



Colocar Números en Rectas Numéricas (A) Respuestas

Nombre: _____ Fecha: _____ Puntuación: _____

Dibujen una estrella en el lugar de la recta numérica donde se encontraría cada número.

559

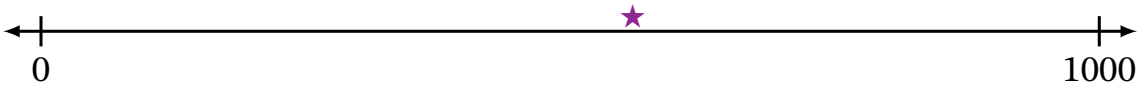

402

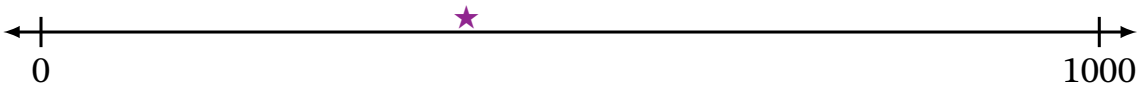

865



911



648

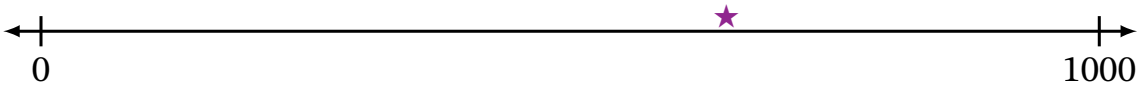

64

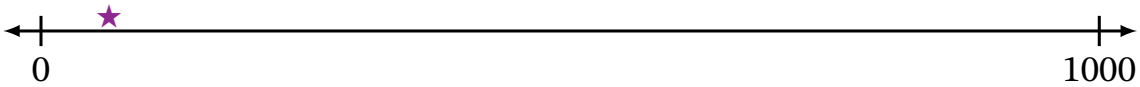

160

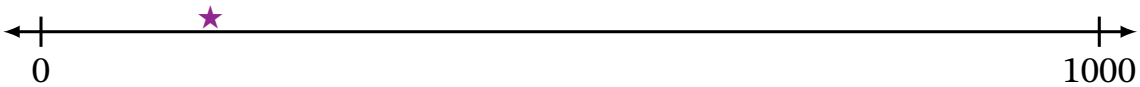

333

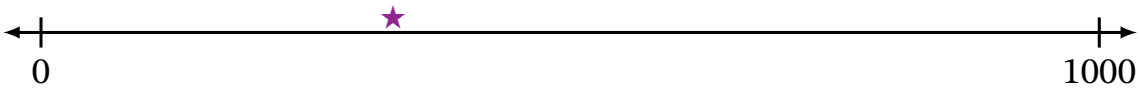

228

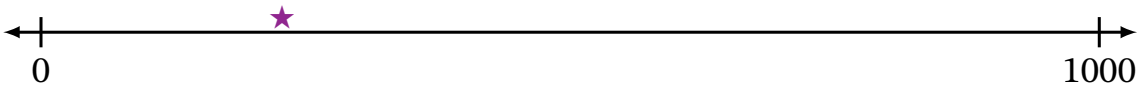

740

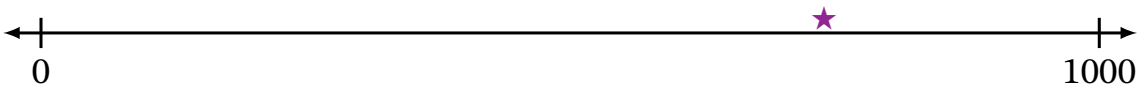

Colocar Números en Rectas Numéricas (B)

Nombre: _____ Fecha: _____ Puntuación: _____

Dibujen una estrella en el lugar de la recta numérica donde se encontraría cada número.

157



289



365



409

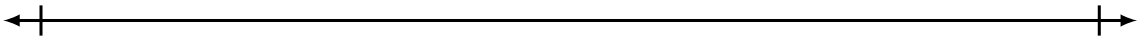

623



739



813



917

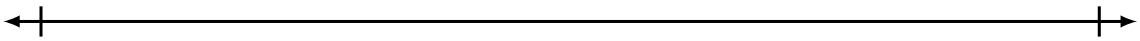

546



35



Colocar Números en Rectas Numéricas (B) Respuestas

Nombre: _____ Fecha: _____ Puntuación: _____

Dibujen una estrella en el lugar de la recta numérica donde se encontraría cada número.

157



289



365



409



623

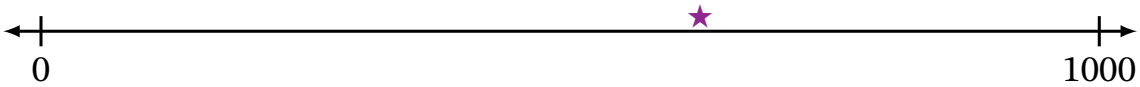

739

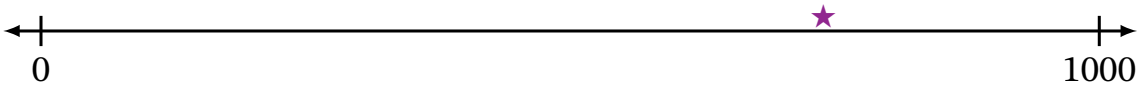

813



917

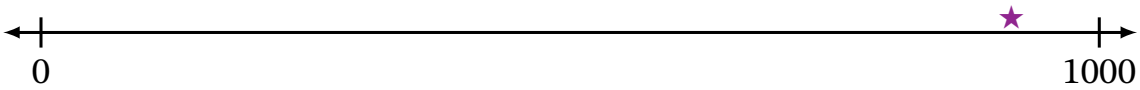

546

35

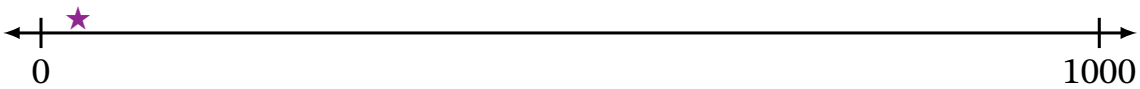

Colocar Números en Rectas Numéricas (C)

Nombre: _____ Fecha: _____ Puntuación: _____

Dibujen una estrella en el lugar de la recta numérica donde se encontraría cada número.

614



244



866



909

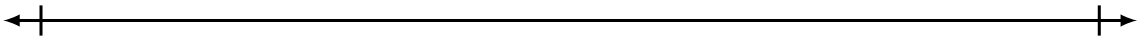

132



320



75



756

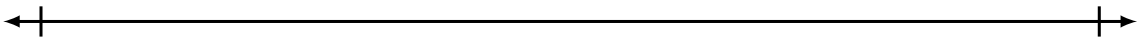

537



430



Colocar Números en Rectas Numéricas (C) Respuestas

Nombre: _____ Fecha: _____ Puntuación: _____

Dibujen una estrella en el lugar de la recta numérica donde se encontraría cada número.

614



244

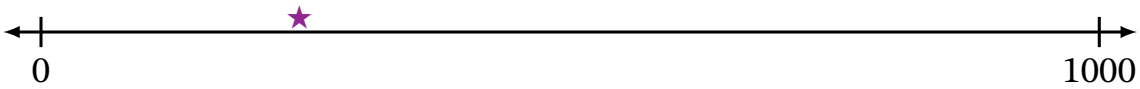

866



909



132



320



75



756

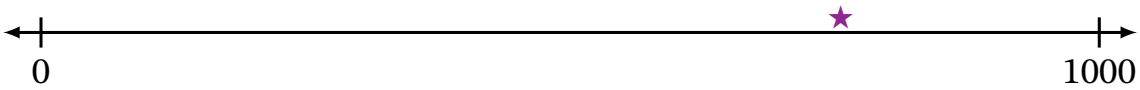

537

430



Colocar Números en Rectas Numéricas (D)

Nombre: _____ Fecha: _____ Puntuación: _____

Dibujen una estrella en el lugar de la recta numérica donde se encontraría cada número.

846



931



0



658



573



304



488



207



147



761



Colocar Números en Rectas Numéricas (D) Respuestas

Nombre: _____ Fecha: _____ Puntuación: _____

Dibujen una estrella en el lugar de la recta numérica donde se encontraría cada número.

846

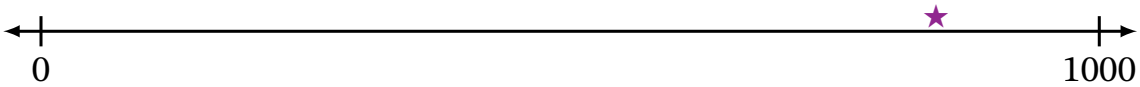

931

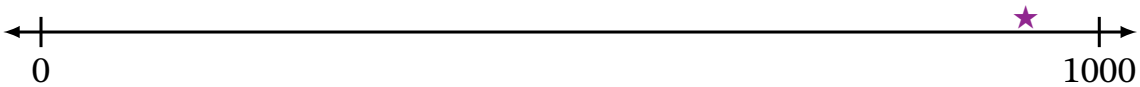

0



658



573

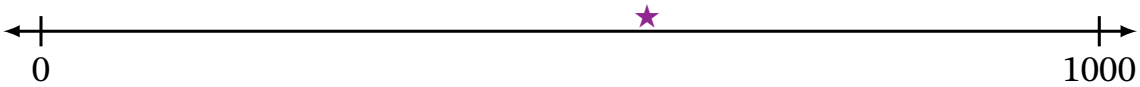

304

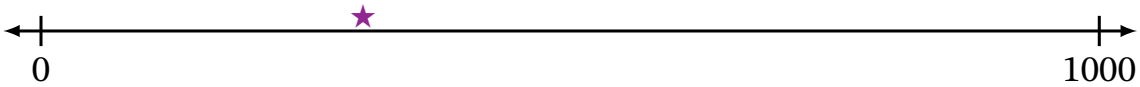

488

207

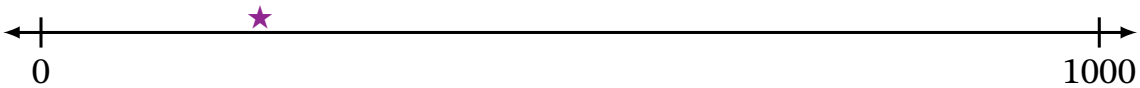

147

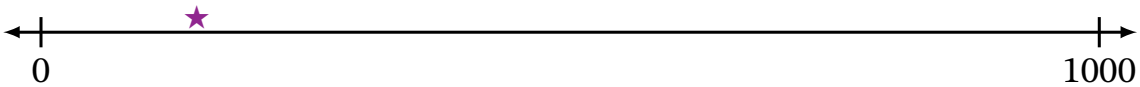

761

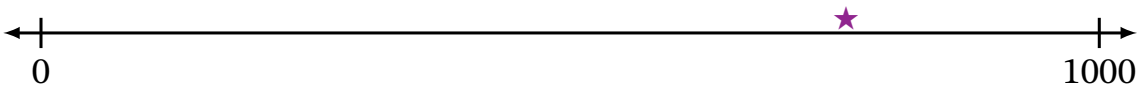

Colocar Números en Rectas Numéricas (E)

Nombre: _____ Fecha: _____ Puntuación: _____

Dibujen una estrella en el lugar de la recta numérica donde se encontraría cada número.

346



63



935



628

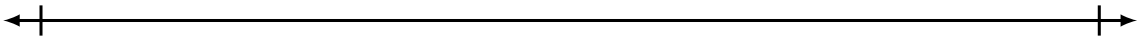

808



790



156



518

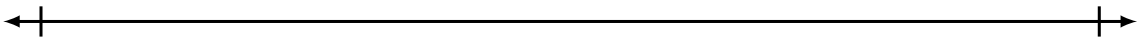

464



281



Colocar Números en Rectas Numéricas (E) Respuestas

Nombre: _____ Fecha: _____ Puntuación: _____

Dibujen una estrella en el lugar de la recta numérica donde se encontraría cada número.

346

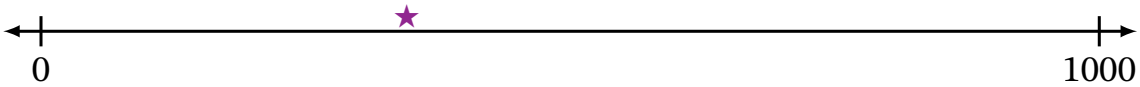

63

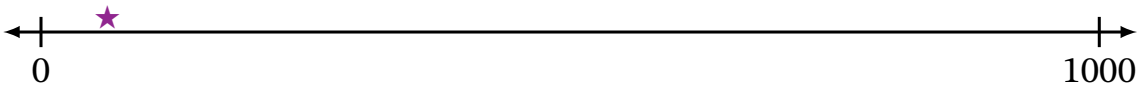

935



628



808

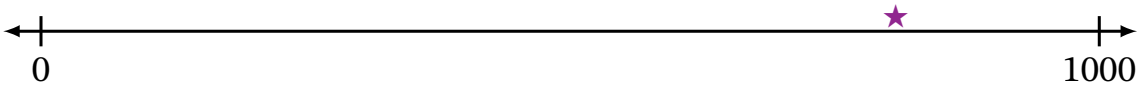

790

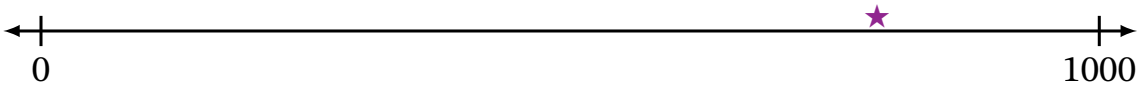

156



518

464

281

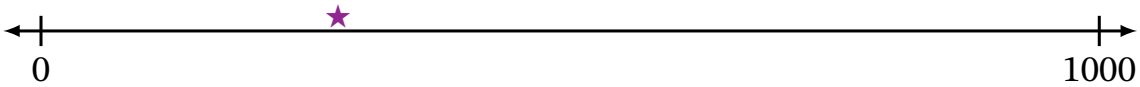

Colocar Números en Rectas Numéricas (F)

Nombre: _____ Fecha: _____ Puntuación: _____

Dibujen una estrella en el lugar de la recta numérica donde se encontraría cada número.

984



655



742



14

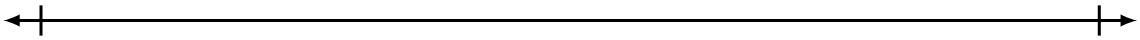

140



252



313



425

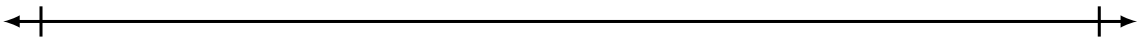

838



541



Colocar Números en Rectas Numéricas (F) Respuestas

Nombre: _____ Fecha: _____ Puntuación: _____

Dibujen una estrella en el lugar de la recta numérica donde se encontraría cada número.

984

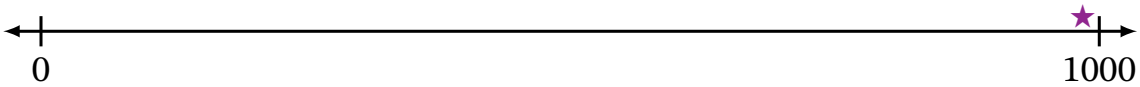

655



742

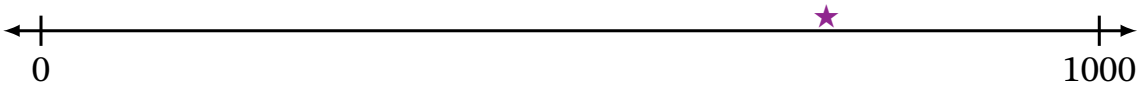

14



140

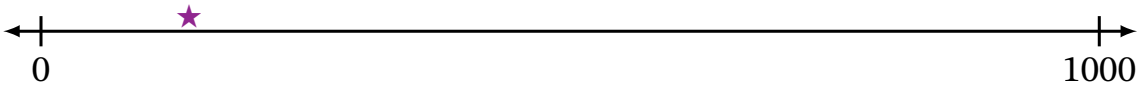

252

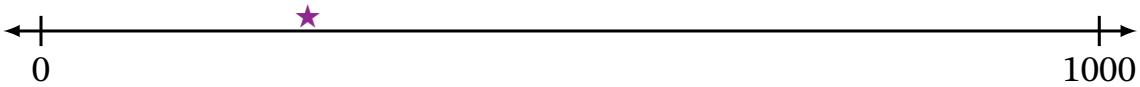

313

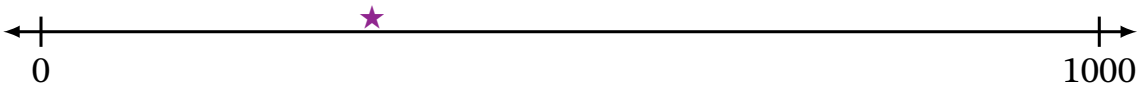

425

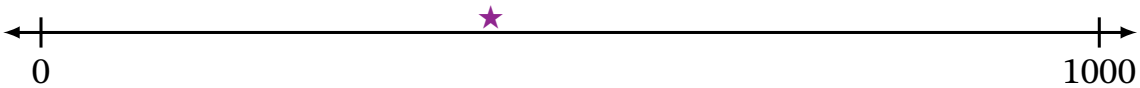

838

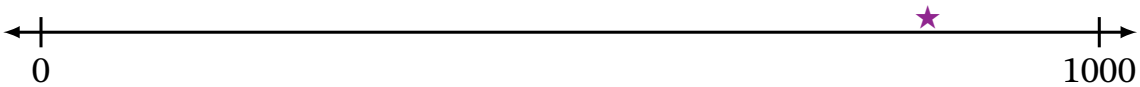

541

Colocar Números en Rectas Numéricas (G)

Nombre: _____ Fecha: _____ Puntuación: _____

Dibujen una estrella en el lugar de la recta numérica donde se encontraría cada número.

1000



426



163



10



829



567



663



395



702



213



Colocar Números en Rectas Numéricas (G) Respuestas

Nombre: _____ Fecha: _____ Puntuación: _____

Dibujen una estrella en el lugar de la recta numérica donde se encontraría cada número.

1000

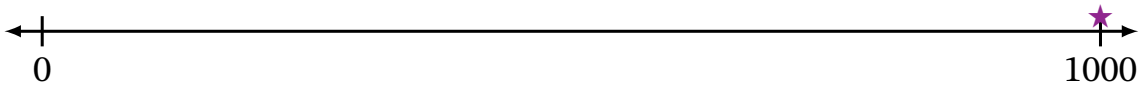

426

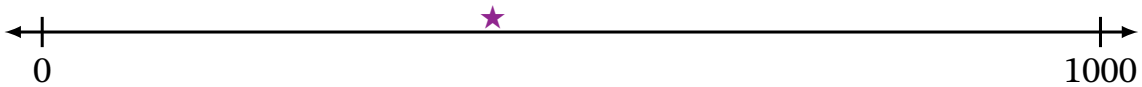

163



10



829

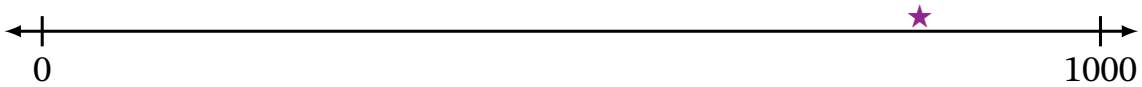

567

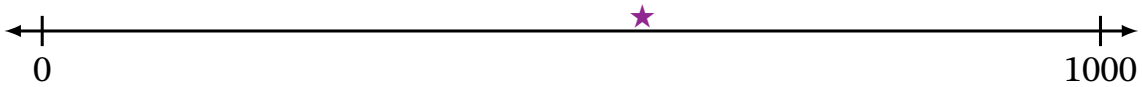

663

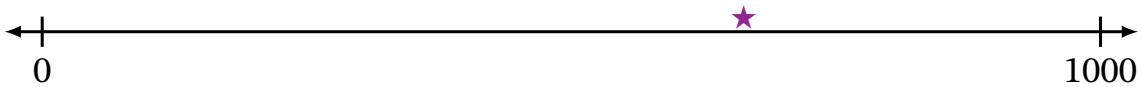

395

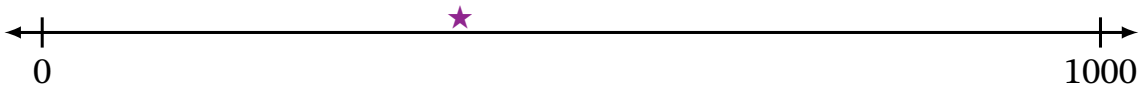

702

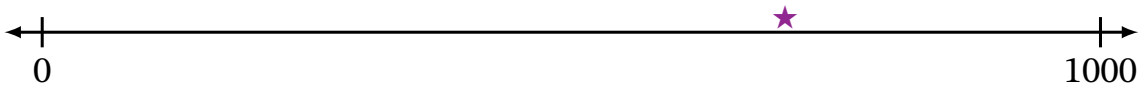

213

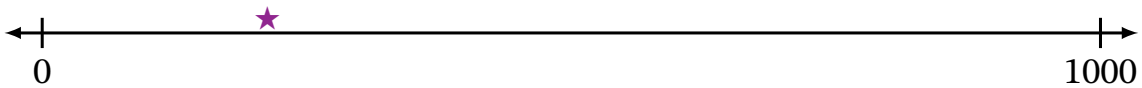

Colocar Números en Rectas Numéricas (H)

Nombre: _____ Fecha: _____ Puntuación: _____

Dibujen una estrella en el lugar de la recta numérica donde se encontraría cada número.

17



465



304



212

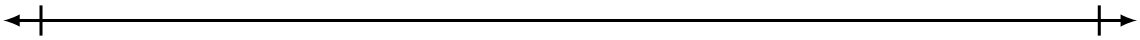

109



878



738



966

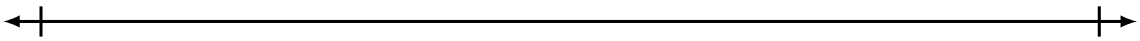

502



682



Colocar Números en Rectas Numéricas (H) Respuestas

Nombre: _____ Fecha: _____ Puntuación: _____

Dibujen una estrella en el lugar de la recta numérica donde se encontraría cada número.

17



465

304



212



109

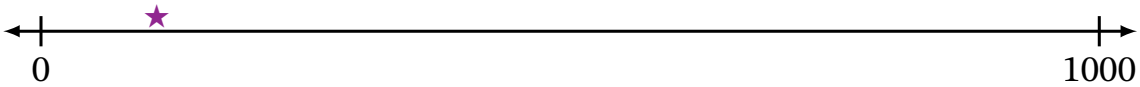

878

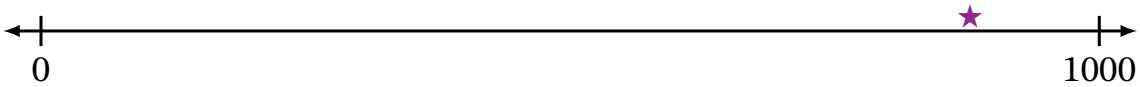

738

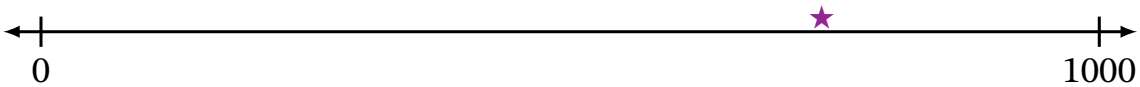

966

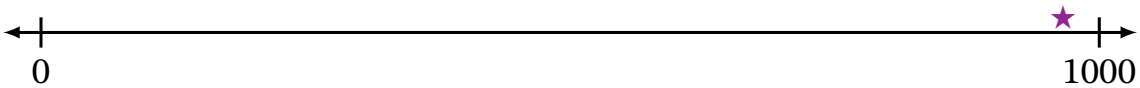

502

682

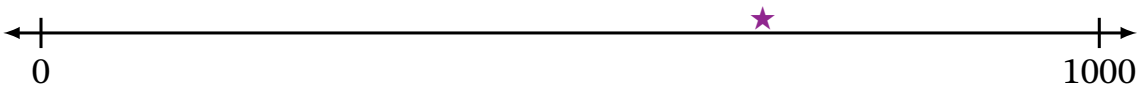

Colocar Números en Rectas Numéricas (I)

Nombre: _____ Fecha: _____ Puntuación: _____

Dibujen una estrella en el lugar de la recta numérica donde se encontraría cada número.

843



943



780



230



686



147



70



467



382



596



Colocar Números en Rectas Numéricas (I) Respuestas

Nombre: _____ Fecha: _____ Puntuación: _____

Dibujen una estrella en el lugar de la recta numérica donde se encontraría cada número.

843



943

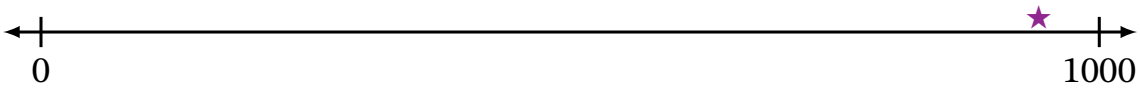

780



230



686



147



70

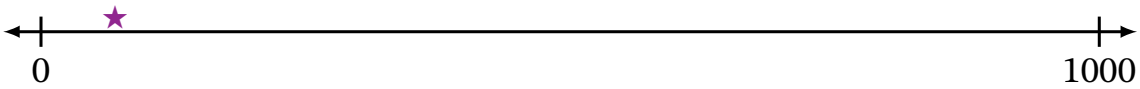

467

382

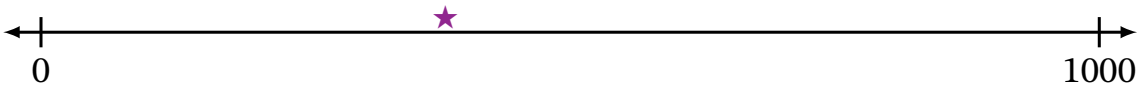

596

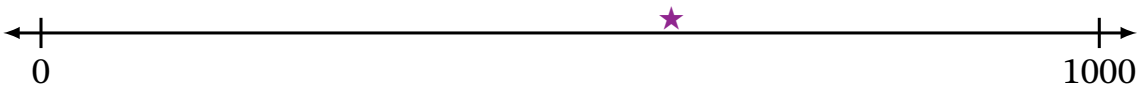

Colocar Números en Rectas Numéricas (J)

Nombre: _____ Fecha: _____ Puntuación: _____

Dibujen una estrella en el lugar de la recta numérica donde se encontraría cada número.

775



284



978

508



62



413



319



831

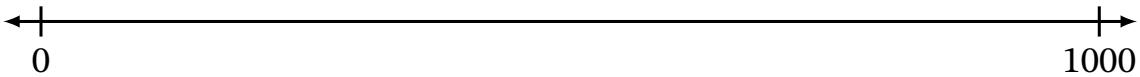

195



699



Colocar Números en Rectas Numéricas (J) Respuestas

Nombre: _____ Fecha: _____ Puntuación: _____

Dibujen una estrella en el lugar de la recta numérica donde se encontraría cada número.

775

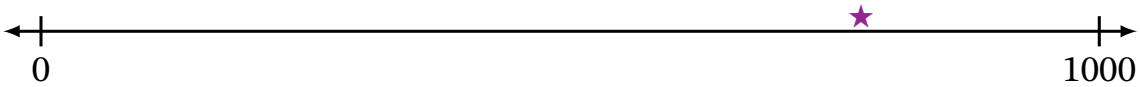

284



978

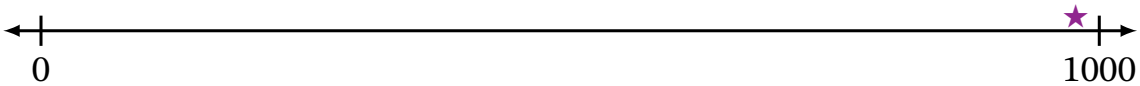

508

62

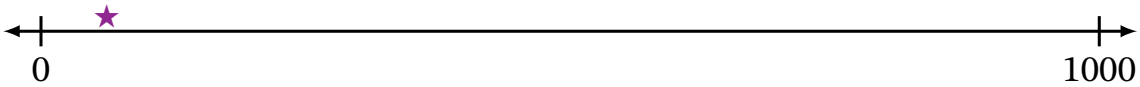

413

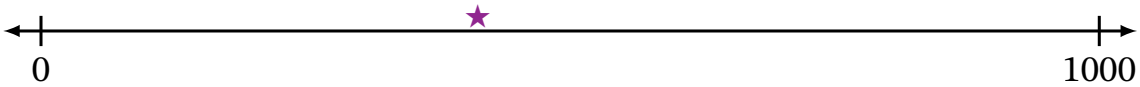

319



831



195


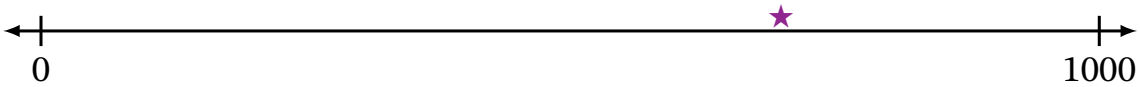
699